# Place d'Aiguiles sur Une Horloge Analogique (E)

Nom: _____ Date: _____

Placer les aiguilles de l'horloge pour qu'elles montrent le temps indiqué.

1.




12:02:45 PM

2.




8:33:30 AM

3.




7:28:15 PM

4.




12:32:00 AM