Place d'Aiguiles sur Une Horloge Analogique (F)

Nom: _____ Date: _____

Placer les aiguilles de l'horloge pour qu'elles montrent le temps indiqué.

1.



11h31m45s

2.



17h52m00s

3.



00h05m30s

4.



22h27m15s