Place d'Aiguiles sur Une Horloge Analogique (B)

Nom: _____ Date: _____

Placer les aiguilles de l'horloge pour qu'elles montrent le temps indiqué.

1.



04h38m10s

2.



14h30m15s

3.



22h20m50s

4.



07h53m40s

Place d'Aiguiles sur Une Horloge Analogique (B) Solutions

Nom: _____ Date: _____

Placer les aiguilles de l'horloge pour qu'elles montrent le temps indiqué.

1.



04h38m10s

2.



14h30m15s

3.



22h20m50s

4.



07h53m40s