Place d'Aiguiles sur Une Horloge Analogique (E)

Nom: _____ Date: _____

Placer les aiguilles de l'horloge pour qu'elles montrent le temps indiqué.

1.



11:00 PM

2.



3:45 PM

3.



11:40 AM

4.



4:25 AM

Place d'Aiguiles sur Une Horloge Analogique (E) Solutions

Nom: _____ Date: _____

Placer les aiguilles de l'horloge pour qu'elles montrent le temps indiqué.

1.

11:00 PM

2.

3:45 PM

3.



11:40 AM

4.

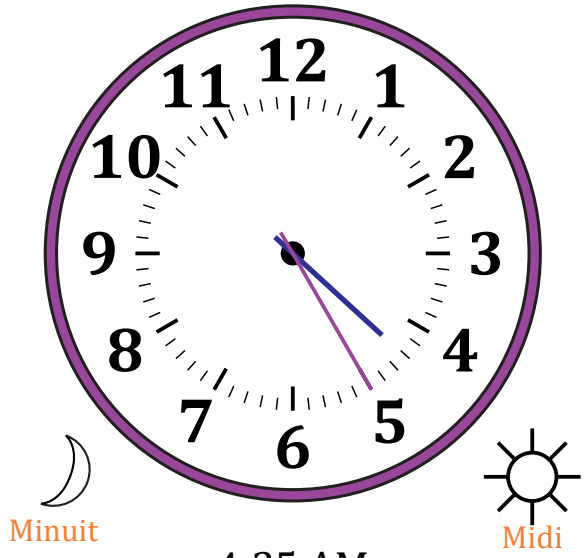

4:25 AM