Place d'Aiguiles sur Une Horloge Analogique (A)

Nom: _____ Date: _____

Placer les aiguilles de l'horloge pour qu'elles montrent le temps indiqué.

1.



2:35 AM

2.



6:25 PM

3.



11:39 AM

4.



12:39 PM