Place d'Aiguiles sur Une Horloge Analogique (I)

Nom: _____ Date: _____

Placer les aiguilles de l'horloge pour qu'elles montrent le temps indiqué.

1.

11:59:30 AM

2.


7:38:00 PM

3.
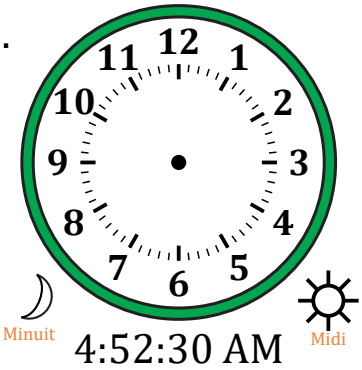

4:52:30 AM

4.


3:36:15 AM

5.


12:05:00 AM

6.


8:57:45 PM

7.


11:30:00 PM

8.


8:43:30 AM

9.


5:12:45 PM

10.


1:20:15 PM

11.


7:37:15 AM

12.


2:47:45 PM

Place d'Aiguiles sur Une Horloge Analogique (I) Solutions

Nom: _____ Date: _____

Placer les aiguilles de l'horloge pour qu'elles montrent le temps indiqué.

1.


11:59:30 AM

2.


7:38:00 PM

3.


4:52:30 AM

4.


3:36:15 AM

5.


12:05:00 AM

6.


8:57:45 PM

7.


11:30:00 PM

8.


8:43:30 AM

9.


5:12:45 PM

10.


1:20:15 PM

11.


7:37:15 AM

12.


2:47:45 PM