Place d'Aiguiles sur Une Horloge Analogique (J)

Nom: _____ Date: _____

Placer les aiguilles de l'horloge pour qu'elles montrent le temps indiqué.

1. 

02h28m30s

2. 

15h46m45s

3. 

13h08m15s

4. 

17h16m30s

5. 

06h48m30s

6. 

01h53m00s

7. 

18h55m45s

8. 

21h59m00s

9. 

04h02m15s

10. 

08h20m15s

11. 

23h35m00s

12. 

10h53m45s

Place d'Aiguiles sur Une Horloge Analogique (J) Solutions

Nom: _____ Date: _____

Placer les aiguilles de l'horloge pour qu'elles montrent le temps indiqué.

1. 

02h28m30s

2. 

15h46m45s

3. 

13h08m15s

4. 

17h16m30s

5. 

06h48m30s

6. 

01h53m00s

7. 

18h55m45s

8. 

21h59m00s

9. 

04h02m15s

10. 

08h20m15s

11. 

23h35m00s

12. 

10h53m45s