Place d'Aiguiles sur Une Horloge Analogique (E)

Nom: _____ Date: _____

Placer les aiguilles de l'horloge pour qu'elles montrent le temps indiqué.

1.


3:25:20 PM

2.


3:18:30 AM

3.


5:13:00 PM

4.


8:36:15 AM

5.


6:15:55 PM

6.


9:00:40 PM

7.


7:29:10 AM

8.


1:41:05 PM

9.


4:43:35 AM

10.


10:55:50 PM

11.
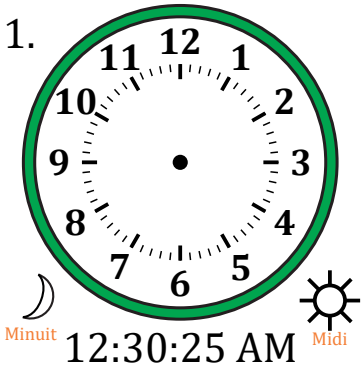

12:30:25 AM

12.


11:13:45 AM