Place d'Aiguiles sur Une Horloge Analogique (B)

Nom: _____ Date: _____

Placer les aiguilles de l'horloge pour qu'elles montrent le temps indiqué.

1. 

13h25m25s

2. 

19h04m50s

3. 

16h13m45s

4. 

23h09m40s

5. 

05h54m20s

6. 

21h24m10s

7. 

06h14m00s

8. 

10h58m35s

9. 

03h26m55s

10. 

09h30m05s

11. 

01h55m15s

12. 

15h22m30s

Place d'Aiguiles sur Une Horloge Analogique (B) Solutions

Nom: _____ Date: _____

Placer les aiguilles de l'horloge pour qu'elles montrent le temps indiqué.

1. 

13h25m25s

2. 

19h04m50s

3. 

16h13m45s

4. 

23h09m40s

5. 

05h54m20s

6. 

21h24m10s

7. 

06h14m00s

8. 

10h58m35s

9. 

03h26m55s

10. 

09h30m05s

11. 

01h55m15s

12. 

15h22m30s