Place d'Aiguiles sur Une Horloge Analogique (E)

Nom: _____ Date: _____

Placer les aiguilles de l'horloge pour qu'elles montrent le temps indiqué.

1.


5:38:18 PM

2.


3:29:59 PM

3.

11:47:07 AM

4.


9:48:08 AM

5.


6:00:21 AM

6.
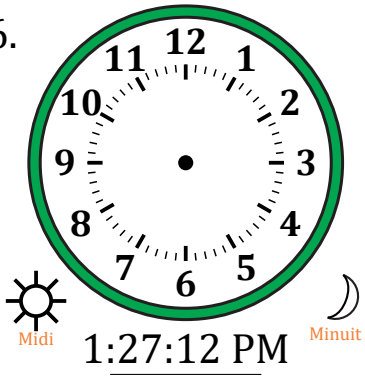

1:27:12 PM

7.
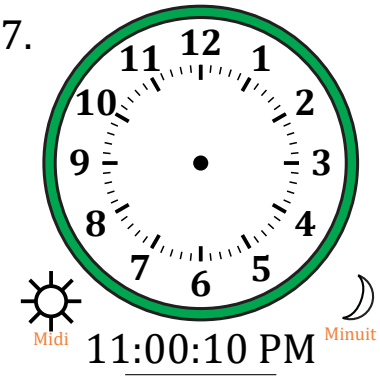

11:00:10 PM

8.


2:07:01 AM

9.


7:46:07 PM

10.
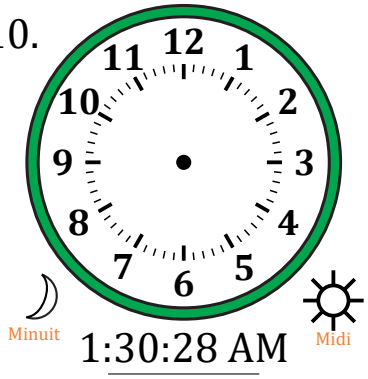

1:30:28 AM

11.
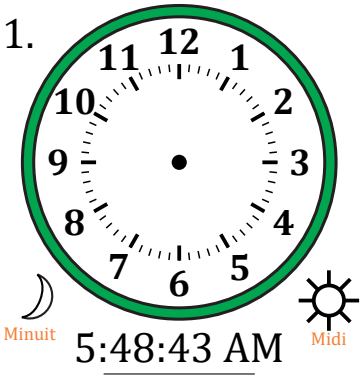

5:48:43 AM

12.


8:09:56 PM

Place d'Aiguiles sur Une Horloge Analogique (E) Solutions

Nom: _____ Date: _____

Placer les aiguilles de l'horloge pour qu'elles montrent le temps indiqué.

1.
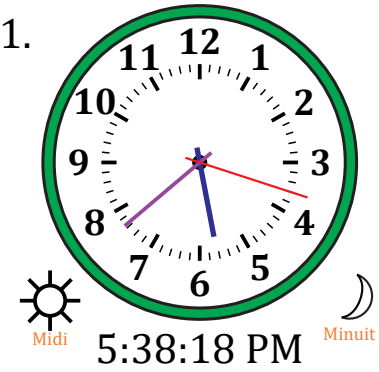

5:38:18 PM

2.
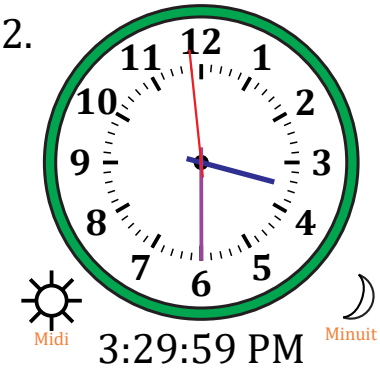

3:29:59 PM

3.

11:47:07 AM

4.


9:48:08 AM

5.


6:00:21 AM

6.
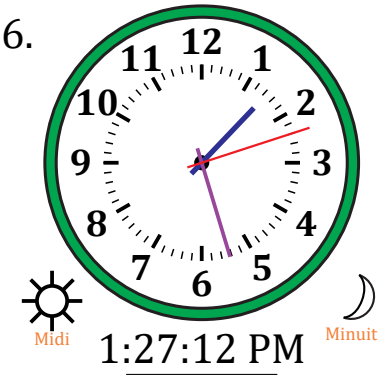

1:27:12 PM

7.
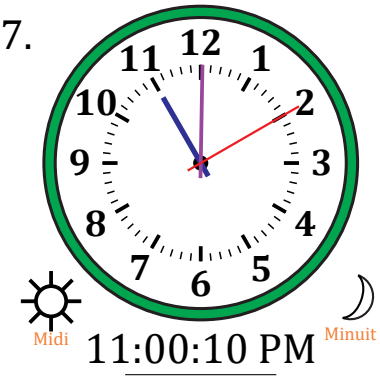

11:00:10 PM

8.


2:07:01 AM

9.
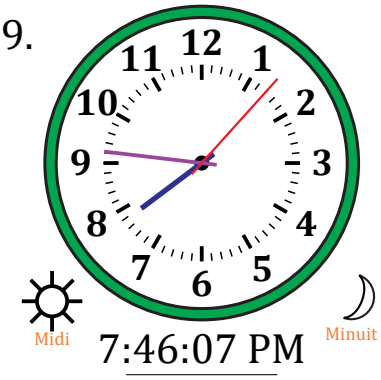

7:46:07 PM

10.


1:30:28 AM

11.
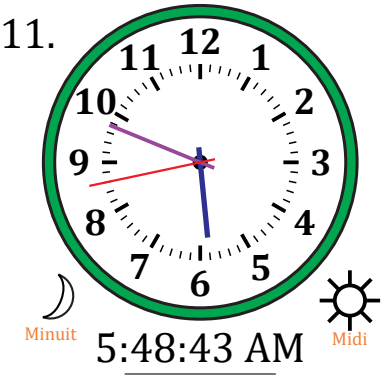

5:48:43 AM

12.
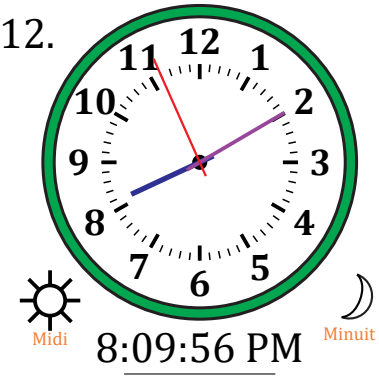

8:09:56 PM