Place d'Aiguiles sur Une Horloge Analogique (G)

Nom: _____ Date: _____

Placer les aiguilles de l'horloge pour qu'elles montrent le temps indiqué.

1. 

8:00 AM

2. 

6:30 AM

3. 

10:00 AM

4. 

10:00 PM

5. 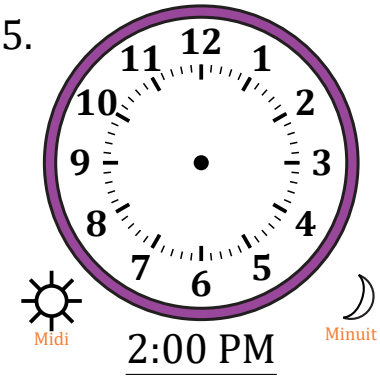

2:00 PM

6. 

1:00 PM

7. 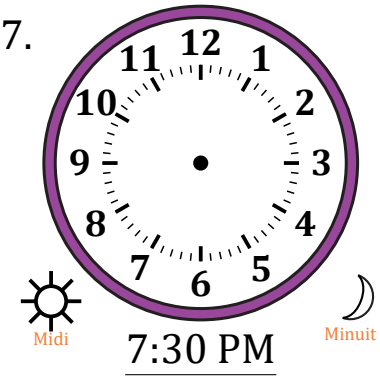

7:30 PM

8. 

5:30 AM

9. 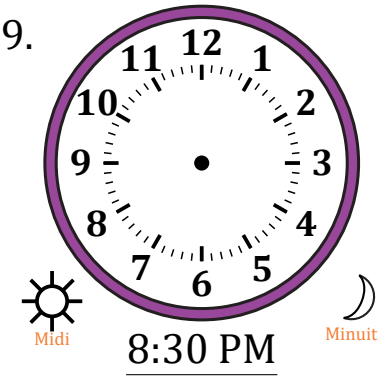

8:30 PM

10. 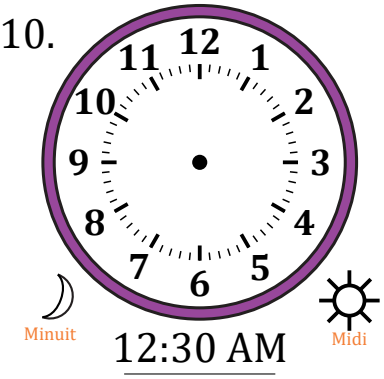

12:30 AM

11. 

2:00 AM

12. 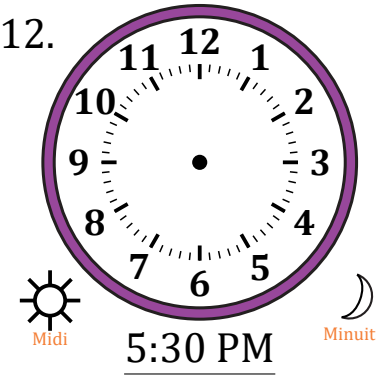

5:30 PM

Place d'Aiguiles sur Une Horloge Analogique (G) Solutions

Nom: _____ Date: _____

Placer les aiguilles de l'horloge pour qu'elles montrent le temps indiqué.

1. 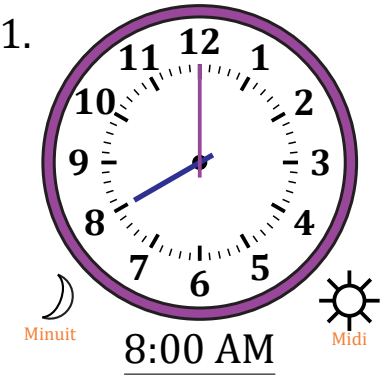

8:00 AM

2.

6:30 AM

3. 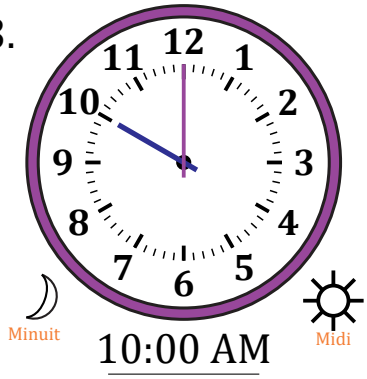

10:00 AM

4. 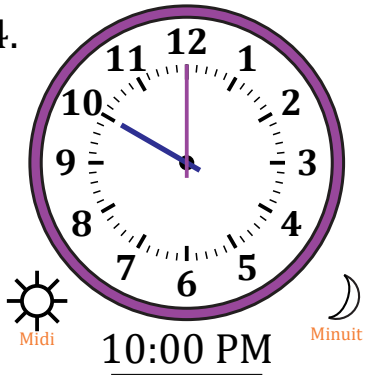

10:00 PM

5. 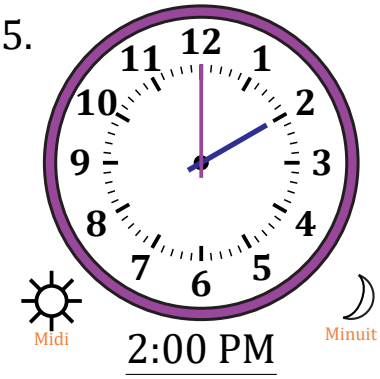

2:00 PM

6. 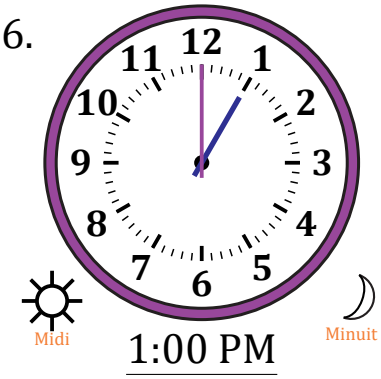

1:00 PM

7. 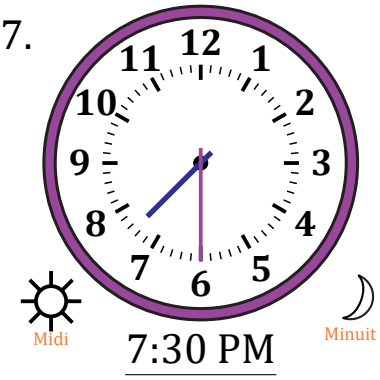

7:30 PM

8.

5:30 AM

9. 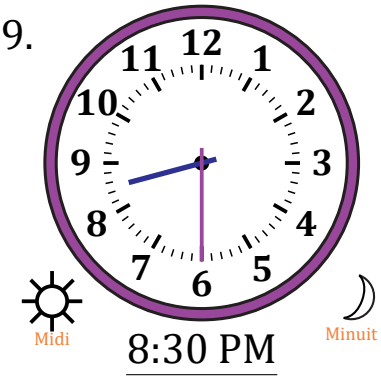

8:30 PM

10. 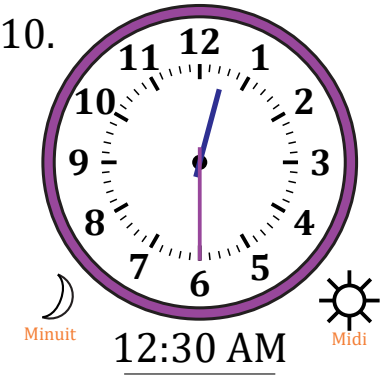

12:30 AM

11. 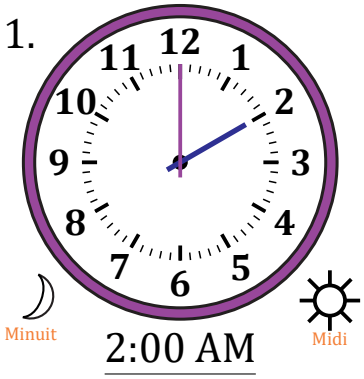

2:00 AM

12. 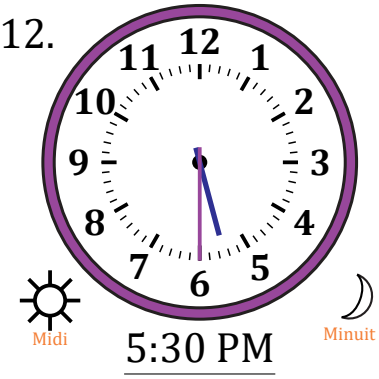

5:30 PM