# Place d'Aiguiles sur Une Horloge Analogique (I)

Nom: _____ Date: _____

Placer les aiguilles de l'horloge pour qu'elles montrent le temps indiqué.

1. 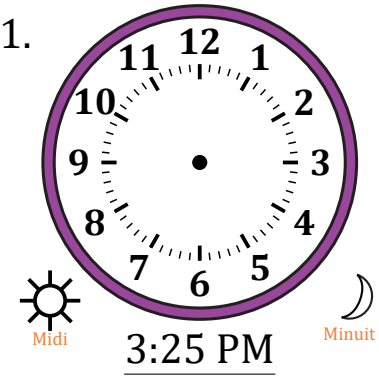

3:25 PM

2. 

3:40 AM

3. 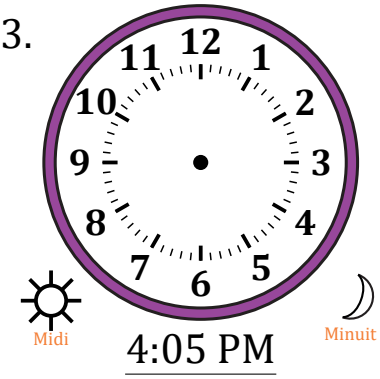

4:05 PM

4. 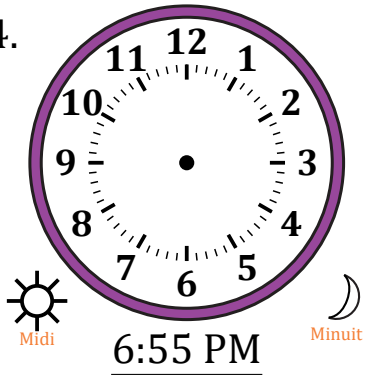

6:55 PM

5. 

12:30 AM

6. 

11:35 AM

7. 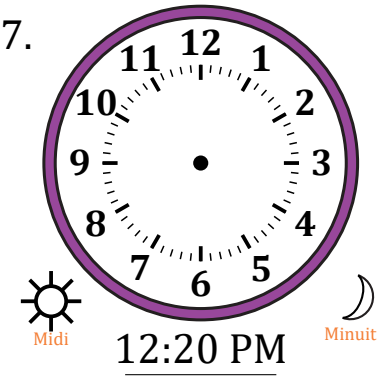

12:20 PM

8. 

8:10 AM

9. 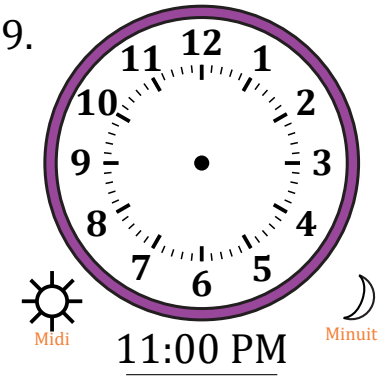

11:00 PM

10. 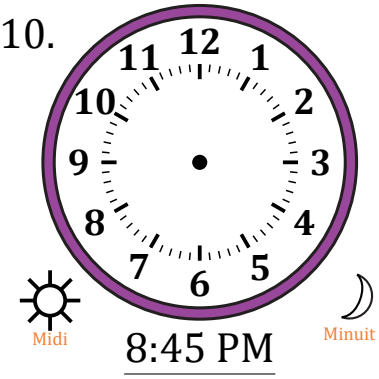

8:45 PM

11. 

5:50 AM

12. 

6:15 AM

# Place d'Aiguiles sur Une Horloge Analogique (I) Solutions

Nom: _____ Date: _____

Placer les aiguilles de l'horloge pour qu'elles montrent le temps indiqué.

1. 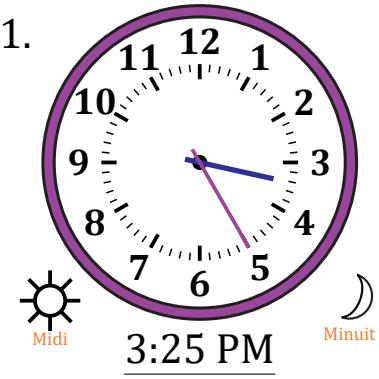

3:25 PM

2.

3:40 AM

3. 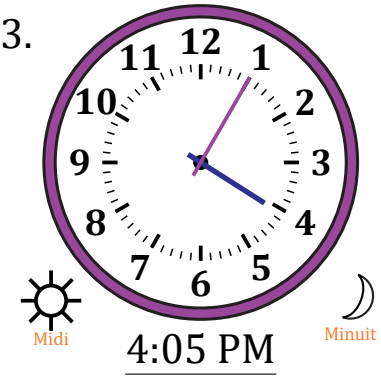

4:05 PM

4.

6:55 PM

5. 

12:30 AM

6. 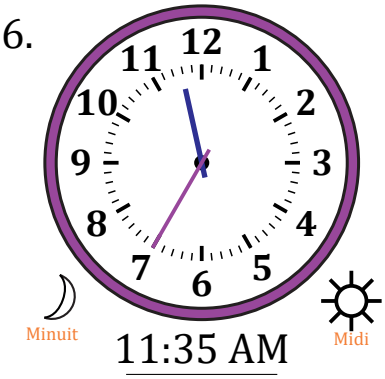

11:35 AM

7. 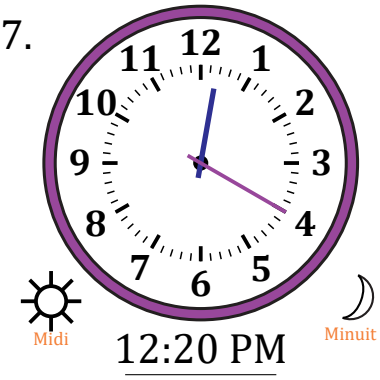

12:20 PM

8. 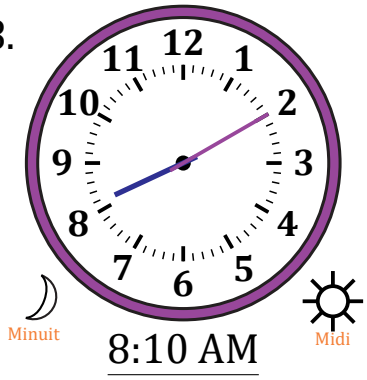

8:10 AM

9. 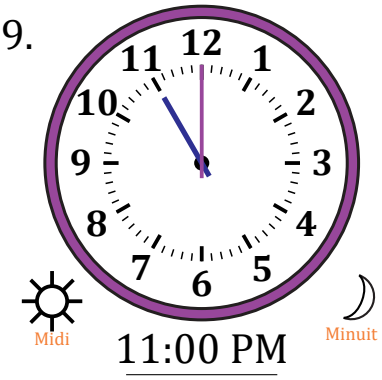

11:00 PM

10. 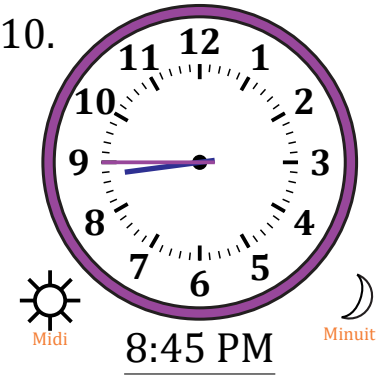

8:45 PM

11.

5:50 AM

12. 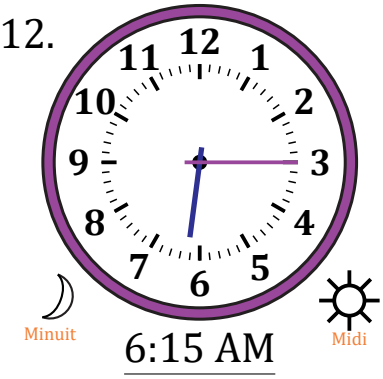

6:15 AM