Lecture d'une Horloge Analogique (E)

Nom: _____ Date: _____

Lisez chaque heure et écrivez-la dans l'espace sous l'horloge.

1.


_____

2.
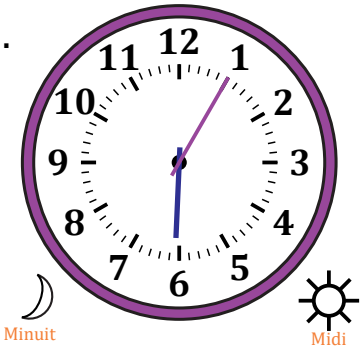

_____

3.
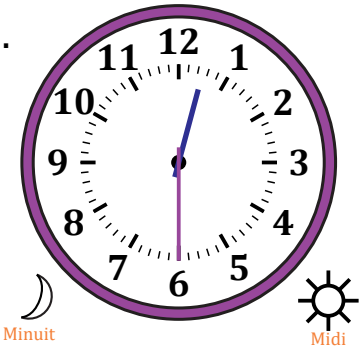

_____

4.


_____

5.


_____

6.


_____

7.


_____

8.


_____

9.


_____

10.


_____

11.


_____

12.


_____