Lecture d'une Horloge Analogique (H)

Nom: _____ Date: _____

Lisez chaque heure et écrivez-la dans l'espace sous l'horloge.

1. 

_____

2. 

_____

3. 

_____

4. 

_____

5. 

_____

6. 

_____

7. 

_____

8. 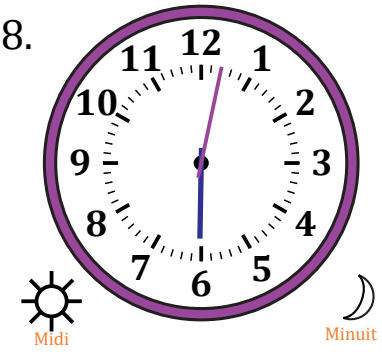

_____

9. 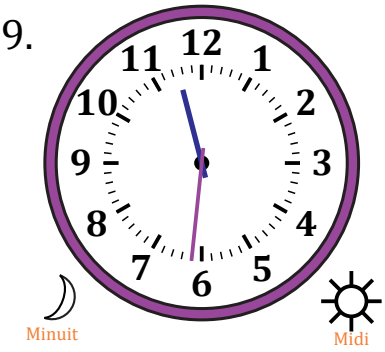

_____

10. 

_____

11. 

_____

12. 

_____

Lecture d'une Horloge Analogique (H) Solutions

Nom: _____ Date: _____

Lisez chaque heure et écrivez-la dans l'espace sous l'horloge.

1. 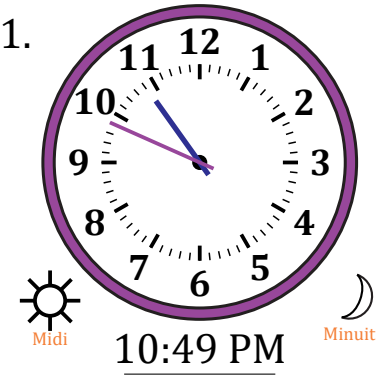

10:49 PM

2. 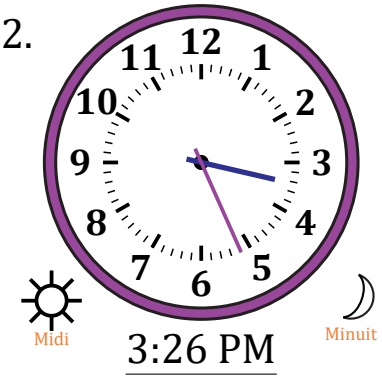

3:26 PM

3. 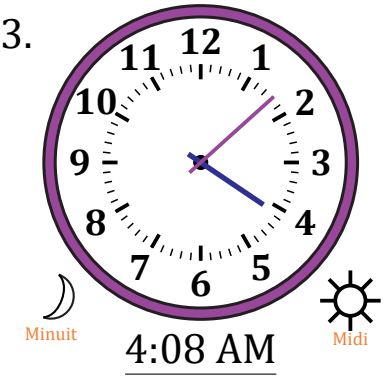

4:08 AM

4. 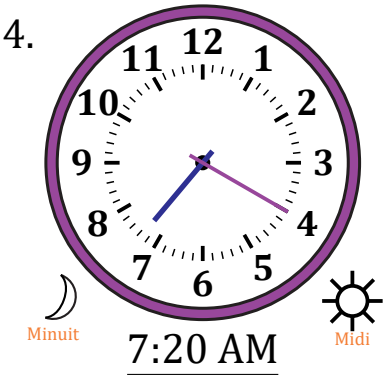

7:20 AM

5. 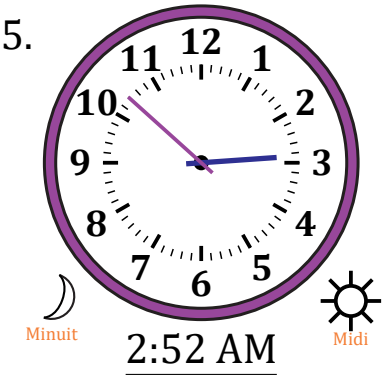

2:52 AM

6. 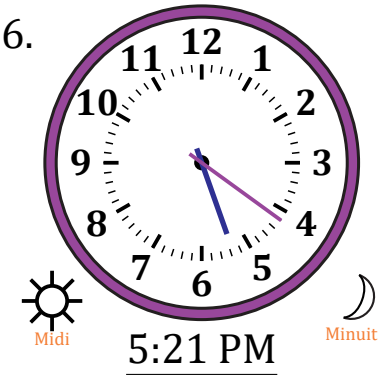

5:21 PM

7. 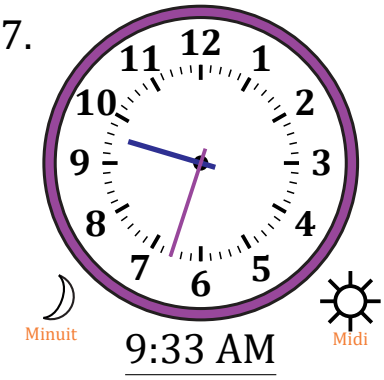

9:33 AM

8. 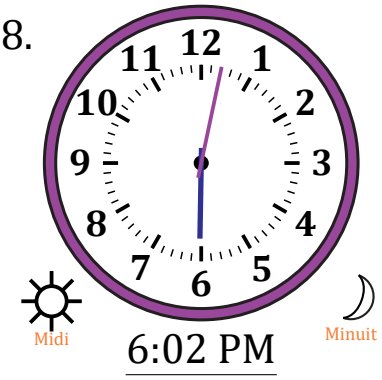

6:02 PM

9. 

11:31 AM

10. 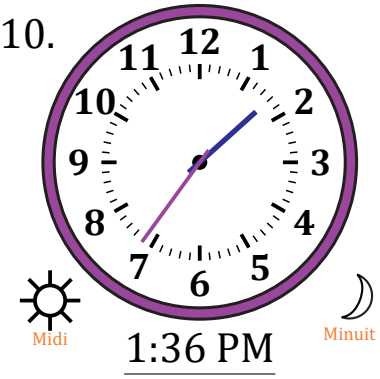

1:36 PM

11. 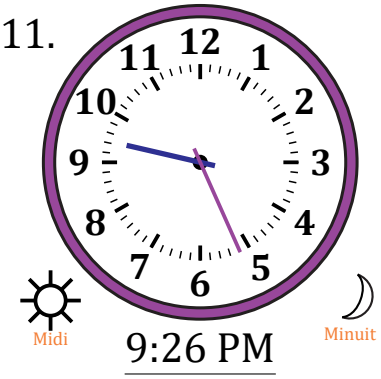

9:26 PM

12. 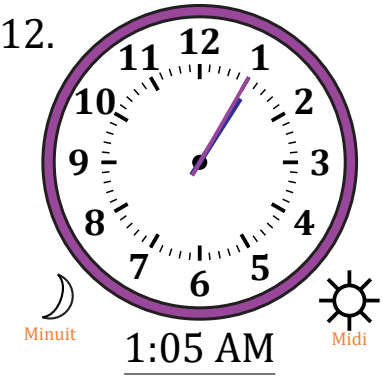

1:05 AM