Lecture d'une Horloge Analogique (I)

Nom: _____ Date: _____

Lisez chaque heure et écrivez-la dans l'espace sous l'horloge.

1.



_____

2.

_____

3.



_____

4.



_____

Lecture d'une Horloge Analogique (I) Solutions

Nom: _____ Date: _____

Lisez chaque heure et écrivez-la dans l'espace sous l'horloge.

1.

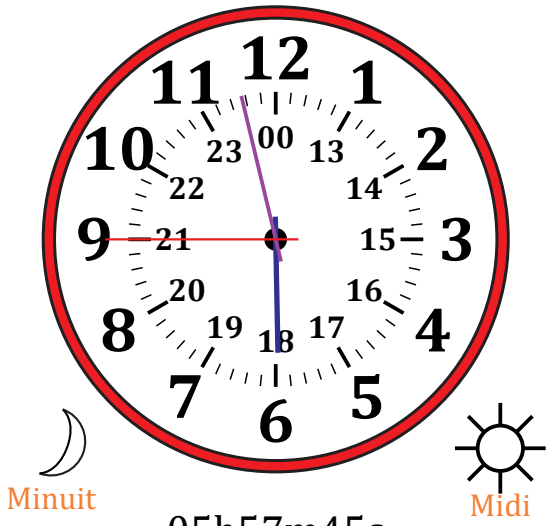

05h57m45s

2.

23h58m00s

3.



12h10m15s

4.



11h16m30s