Lecture d'une Horloge Analogique (C)

Nom: _____ Date: _____

Lisez chaque heure et écrivez-la dans l'espace sous l'horloge.

1.



_____

2.

_____

3.



_____

4.



_____