Lecture d'une Horloge Analogique (B)

Nom: _____ Date: _____

Lisez chaque heure et écrivez-la dans l'espace sous l'horloge.

1.



Minuit Midi

_____

2.



Midi Minuit

_____

3.



Minuit Midi

_____

4.



Midi Minuit

_____