Lecture d'une Horloge Analogique (D)

Nom: _____ Date: _____

Lisez chaque heure et écrivez-la dans l'espace sous l'horloge.

1.



_____

2.



_____

3.



_____

4.



_____

Lecture d'une Horloge Analogique (D) Solutions

Nom: _____ Date: _____

Lisez chaque heure et écrivez-la dans l'espace sous l'horloge.

1.



6:52:03 AM

2.



12:31:52 AM

3.

10:49:01 PM

4.



2:57:47 PM