Lecture d'une Horloge Analogique (A)

Nom: _____ Date: _____

Lisez chaque heure et écrivez-la dans l'espace sous l'horloge.

1.



_____

2.



_____

3.



_____

4.



_____

Lecture d'une Horloge Analogique (A) Solutions

Nom: _____ Date: _____

Lisez chaque heure et écrivez-la dans l'espace sous l'horloge.

1.



Minuit Midi

09h00m

2.



Midi Minuit

20h00m

3.



Minuit Midi

01h00m

4.



Midi Minuit

15h00m

Lecture d'une Horloge Analogique (B)

Nom: _____ Date: _____

Lisez chaque heure et écrivez-la dans l'espace sous l'horloge.

1.



_____

2.



_____

3.



_____

4.



_____

Lecture d'une Horloge Analogique (B) Solutions

Nom: _____ Date: _____

Lisez chaque heure et écrivez-la dans l'espace sous l'horloge.

1.



16h00m

2.



07h00m

3.



22h00m

4.



03h00m

Lecture d'une Horloge Analogique (C)

Nom: _____ Date: _____

Lisez chaque heure et écrivez-la dans l'espace sous l'horloge.

1.



_____

2.



_____

3.



_____

4.



_____

Lecture d'une Horloge Analogique (C) Solutions

Nom: _____ Date: _____

Lisez chaque heure et écrivez-la dans l'espace sous l'horloge.

1.



20h00m

2.



15h00m

3.



03h00m

4.

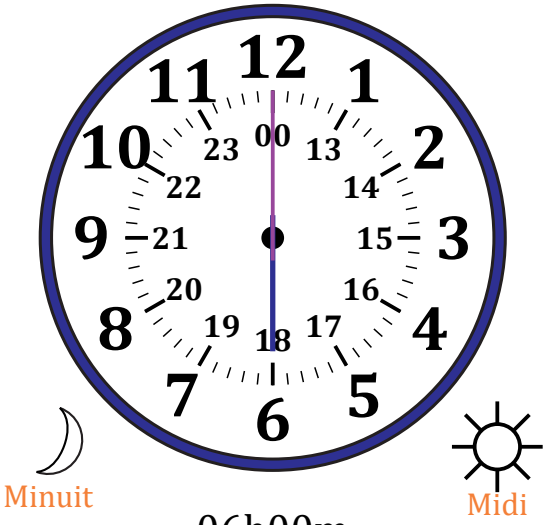

06h00m

Lecture d'une Horloge Analogique (D)

Nom: _____ Date: _____

Lisez chaque heure et écrivez-la dans l'espace sous l'horloge.

1.



_____

2.



_____

3.



_____

4.



_____

Lecture d'une Horloge Analogique (D) Solutions

Nom: _____ Date: _____

Lisez chaque heure et écrivez-la dans l'espace sous l'horloge.

1.



16h00m

2.



11h00m

3.



05h00m

4.



21h00m

Lecture d'une Horloge Analogique (E)

Nom: _____ Date: _____

Lisez chaque heure et écrivez-la dans l'espace sous l'horloge.

1.



_____

2.



_____

3.



_____

4.



_____

Lecture d'une Horloge Analogique (E) Solutions

Nom: _____ Date: _____

Lisez chaque heure et écrivez-la dans l'espace sous l'horloge.

1.



20h00m

2.



05h00m

3.



11h00m

4.



15h00m

Lecture d'une Horloge Analogique (F)

Nom: _____ Date: _____

Lisez chaque heure et écrivez-la dans l'espace sous l'horloge.

1.



_____

2.



_____

3.



_____

4.



_____

Lecture d'une Horloge Analogique (F) Solutions

Nom: _____ Date: _____

Lisez chaque heure et écrivez-la dans l'espace sous l'horloge.

1.

01h00m

2.



08h00m

3.

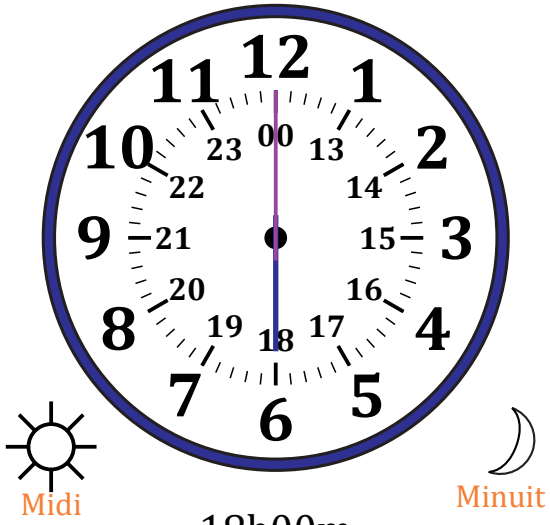

18h00m

4.



12h00m

Lecture d'une Horloge Analogique (G)

Nom: _____ Date: _____

Lisez chaque heure et écrivez-la dans l'espace sous l'horloge.

1.



_____

2.



_____

3.



_____

4.



_____

Lecture d'une Horloge Analogique (G) Solutions

Nom: _____ Date: _____

Lisez chaque heure et écrivez-la dans l'espace sous l'horloge.

1.

01h00m

2.



12h00m

3.

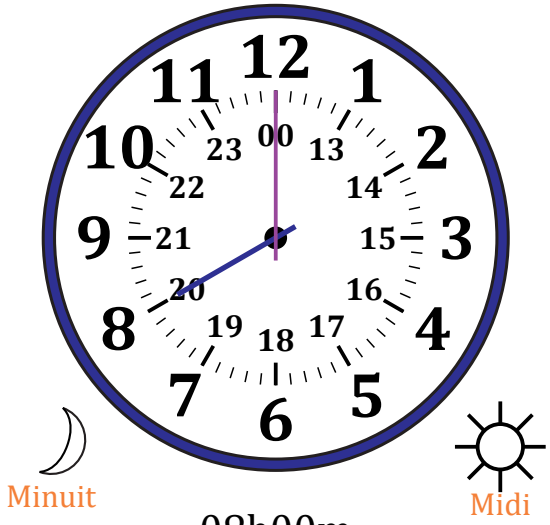

08h00m

4.

23h00m

Lecture d'une Horloge Analogique (H)

Nom: _____ Date: _____

Lisez chaque heure et écrivez-la dans l'espace sous l'horloge.

1.



_____

2.

_____

3.



_____

4.



_____

Lecture d'une Horloge Analogique (H) Solutions

Nom: _____ Date: _____

Lisez chaque heure et écrivez-la dans l'espace sous l'horloge.

1.



11h00m

2.

13h00m

3.



19h00m

4.



02h00m

Lecture d'une Horloge Analogique (I)

Nom: _____ Date: _____

Lisez chaque heure et écrivez-la dans l'espace sous l'horloge.

1.



_____

2.

_____

3.



_____

4.



_____

Lecture d'une Horloge Analogique (I) Solutions

Nom: _____ Date: _____

Lisez chaque heure et écrivez-la dans l'espace sous l'horloge.

1.



12h00m

2.

23h00m

3.



03h00m

4.



10h00m

Lecture d'une Horloge Analogique (J)

Nom: _____ Date: _____

Lisez chaque heure et écrivez-la dans l'espace sous l'horloge.

1.



_____

2.



_____

3.



_____

4.



_____

Lecture d'une Horloge Analogique (J) Solutions

Nom: _____ Date: _____

Lisez chaque heure et écrivez-la dans l'espace sous l'horloge.

1.



09h00m

2.



15h00m

3.

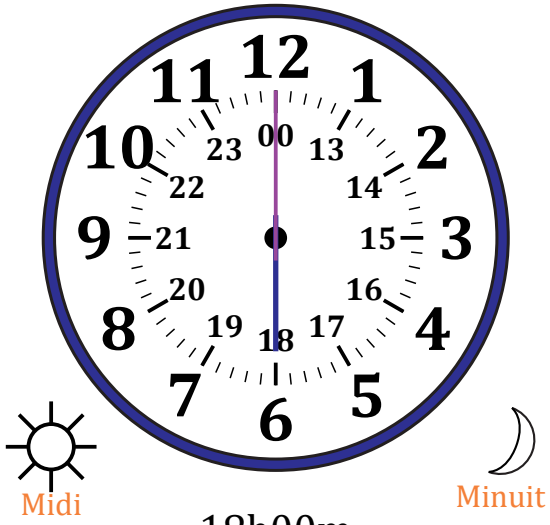

18h00m

4.



05h00m