Lecture d'une Horloge Analogique (B)

Nom: _____ Date: _____

Lisez chaque heure et écrivez-la dans l'espace sous l'horloge.

1.



_____

2.



_____

3.



_____

4.



_____

Lecture d'une Horloge Analogique (B) Solutions

Nom: _____ Date: _____

Lisez chaque heure et écrivez-la dans l'espace sous l'horloge.

1.

11:00 PM

2.

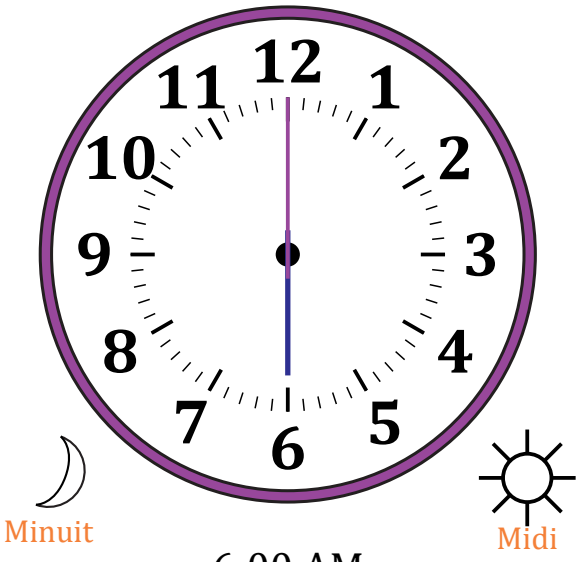

6:00 AM

3.

3:30 PM

4.

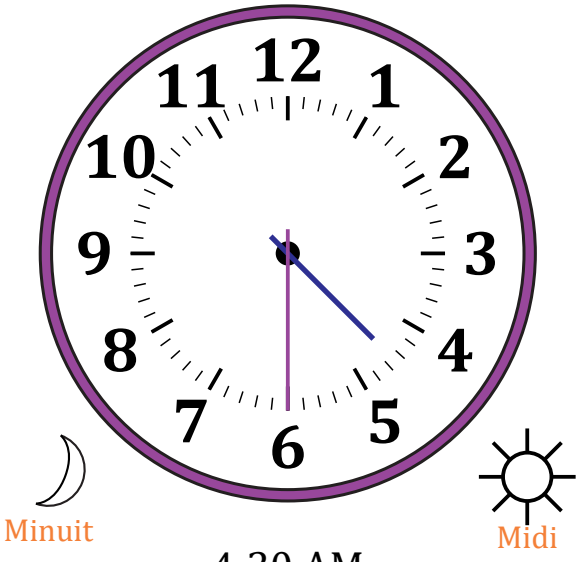

4:30 AM