Lecture d'une Horloge Analogique (E)

Nom: _____ Date: _____

Lisez chaque heure et écrivez-la dans l'espace sous l'horloge.

1.



_____

2.

_____

3.



_____

4.



_____

Lecture d'une Horloge Analogique (E) Solutions

Nom: _____ Date: _____

Lisez chaque heure et écrivez-la dans l'espace sous l'horloge.

1.



20h30m

2.

02h15m

3.



08h45m

4.



15h00m