Lecture d'une Horloge Analogique (A)

Nom: _____ Date: _____

Lisez chaque heure et écrivez-la dans l'espace sous l'horloge.

1.



_____

2.



_____

3.



_____

4.



_____

Lecture d'une Horloge Analogique (A) Solutions

Nom: _____ Date: _____

Lisez chaque heure et écrivez-la dans l'espace sous l'horloge.

1.



01h40m

2.



19h25m

3.

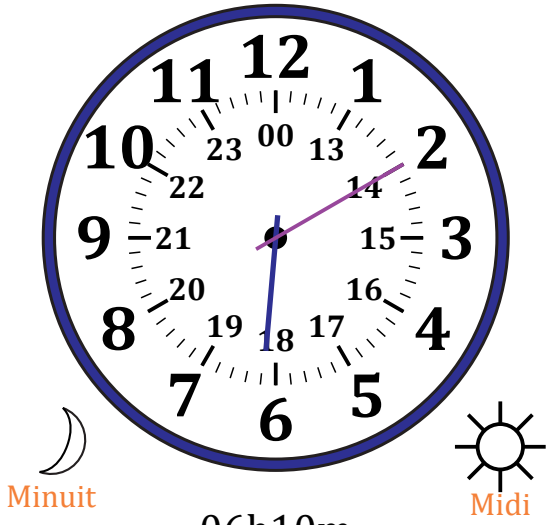

06h10m

4.



13h55m

Lecture d'une Horloge Analogique (B)

Nom: _____ Date: _____

Lisez chaque heure et écrivez-la dans l'espace sous l'horloge.

1.

_____

2.



_____

3.



_____

4.



_____

Lecture d'une Horloge Analogique (B) Solutions

Nom: _____ Date: _____

Lisez chaque heure et écrivez-la dans l'espace sous l'horloge.

1.



19h00m

2.



11h50m

3.



12h40m

4.



02h15m

Lecture d'une Horloge Analogique (C)

Nom: _____ Date: _____

Lisez chaque heure et écrivez-la dans l'espace sous l'horloge.

1.



_____

2.



_____

3.



_____

4.



_____

Lecture d'une Horloge Analogique (C) Solutions

Nom: _____ Date: _____

Lisez chaque heure et écrivez-la dans l'espace sous l'horloge.

1.



08h55m

2.



17h00m

3.

19h35m

4.



03h15m

Lecture d'une Horloge Analogique (D)

Nom: _____ Date: _____

Lisez chaque heure et écrivez-la dans l'espace sous l'horloge.

1.



_____

2.



_____

3.



_____

4.



_____

Lecture d'une Horloge Analogique (D) Solutions

Nom: _____ Date: _____

Lisez chaque heure et écrivez-la dans l'espace sous l'horloge.

1.



Minuit Midi

04h05m

2.



Midi Minuit

21h15m

3.



Midi Minuit

12h35m

4.

Minuit Midi

10h50m

Lecture d'une Horloge Analogique (E)

Nom: _____ Date: _____

Lisez chaque heure et écrivez-la dans l'espace sous l'horloge.

1.



_____

2.



_____

3.



_____

4.



_____

Lecture d'une Horloge Analogique (E) Solutions

Nom: _____ Date: _____

Lisez chaque heure et écrivez-la dans l'espace sous l'horloge.

1.



09h15m

2.



13h55m

3.



21h30m

4.



05h00m

Lecture d'une Horloge Analogique (F)

Nom: _____ Date: _____

Lisez chaque heure et écrivez-la dans l'espace sous l'horloge.

1.

_____

2.

_____

3.



_____

4.



_____

Lecture d'une Horloge Analogique (F) Solutions

Nom: _____ Date: _____

Lisez chaque heure et écrivez-la dans l'espace sous l'horloge.

1.

22h25m

2.

14h35m

3.

04h55m

4.



11h10m

Lecture d'une Horloge Analogique (G)

Nom: _____ Date: _____

Lisez chaque heure et écrivez-la dans l'espace sous l'horloge.

1.



_____

2.



_____

3.



_____

4.



_____

Lecture d'une Horloge Analogique (G) Solutions

Nom: _____ Date: _____

Lisez chaque heure et écrivez-la dans l'espace sous l'horloge.

1.



07h50m

2.



16h00m

3.



04h40m

4.



19h15m

Lecture d'une Horloge Analogique (H)

Nom: _____ Date: _____

Lisez chaque heure et écrivez-la dans l'espace sous l'horloge.

1.



_____

2.



_____

3.



_____

4.



_____

Lecture d'une Horloge Analogique (H) Solutions

Nom: _____ Date: _____

Lisez chaque heure et écrivez-la dans l'espace sous l'horloge.

1.

20h10m

2.



14h40m

3.

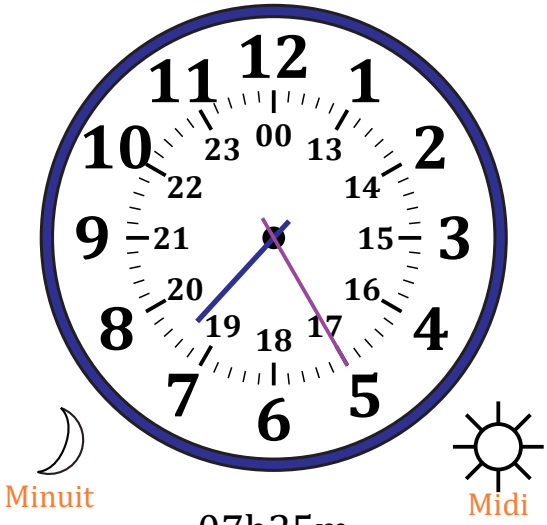

07h25m

4.



04h50m

Lecture d'une Horloge Analogique (I)

Nom: _____ Date: _____

Lisez chaque heure et écrivez-la dans l'espace sous l'horloge.

1.



_____

2.



_____

3.



_____

4.



_____

Lecture d'une Horloge Analogique (I) Solutions

Nom: _____ Date: _____

Lisez chaque heure et écrivez-la dans l'espace sous l'horloge.

1.



05h10m

2.



15h50m

3.



20h15m

4.



09h40m

Lecture d'une Horloge Analogique (J)

Nom: _____ Date: _____

Lisez chaque heure et écrivez-la dans l'espace sous l'horloge.

1.



_____

2.

_____

3.



_____

4.



_____

Lecture d'une Horloge Analogique (J) Solutions

Nom: _____ Date: _____

Lisez chaque heure et écrivez-la dans l'espace sous l'horloge.

1.



00h00m

2.



22h20m

3.

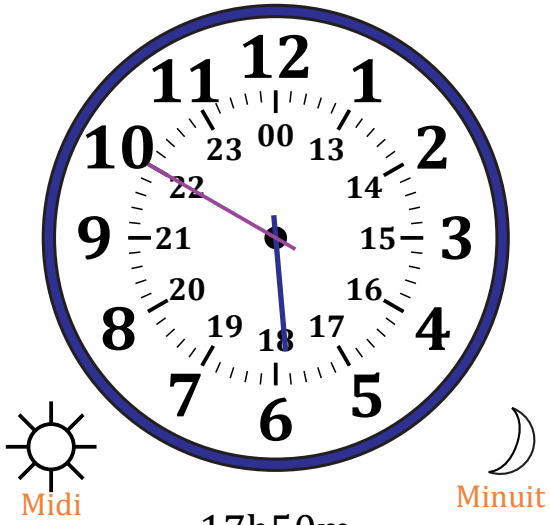

17h50m

4.



07h35m