Lecture d'une Horloge Analogique (A)

Nom: _____ Date: _____

Lisez chaque heure et écrivez-la dans l'espace sous l'horloge.

1.


_____

2.


_____

3.


_____

4.


_____

5.


_____

6.


_____

7.


_____

8.


_____

9.


_____

10.


_____

11.


_____

12.


_____

Lecture d'une Horloge Analogique (A) Solutions

Nom: _____ Date: _____

Lisez chaque heure et écrivez-la dans l'espace sous l'horloge.

1.


9:21:15 PM

2.


7:12:15 PM

3.

6:22:30 AM

4.

11:38:45 AM

5.
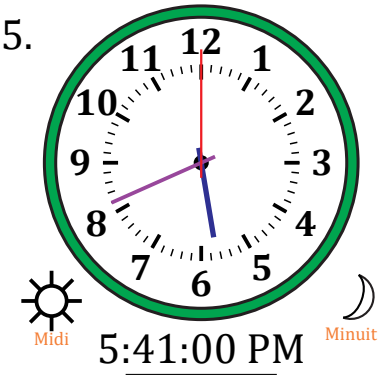

5:41:00 PM

6.
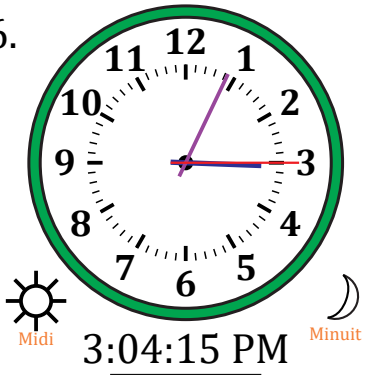

3:04:15 PM

7.
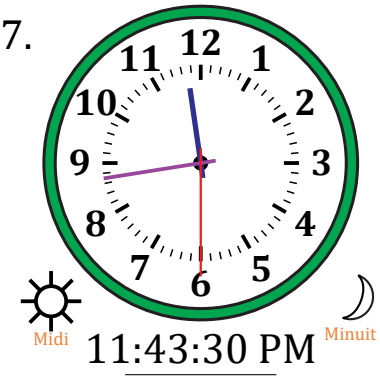

11:43:30 PM

8.


1:56:00 PM

9.

5:34:45 AM

10.


8:14:00 AM

11.
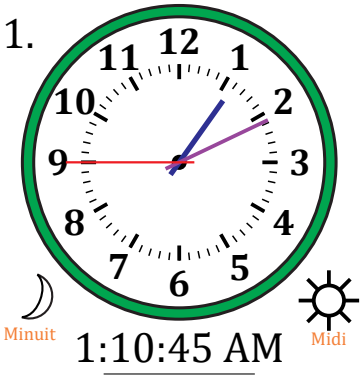

1:10:45 AM

12.
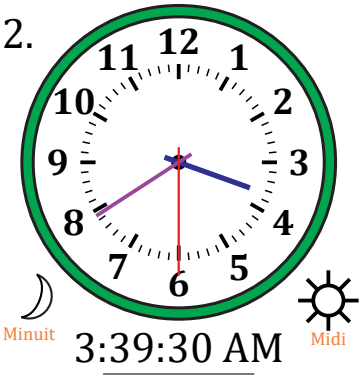

3:39:30 AM

Lecture d'une Horloge Analogique (B)

Nom: _____ Date: _____

Lisez chaque heure et écrivez-la dans l'espace sous l'horloge.

1.


_____

2.


_____

3.


_____

4.


_____

5.


_____

6.


_____

7.


_____

8.


_____

9.


_____

10.


_____

11.
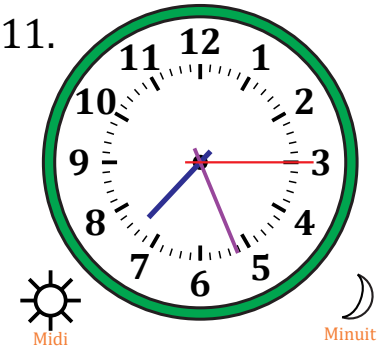

_____

12.


_____

Lecture d'une Horloge Analogique (B) Solutions

Nom: _____ Date: _____

Lisez chaque heure et écrivez-la dans l'espace sous l'horloge.

1.

5:51:30 PM

2. 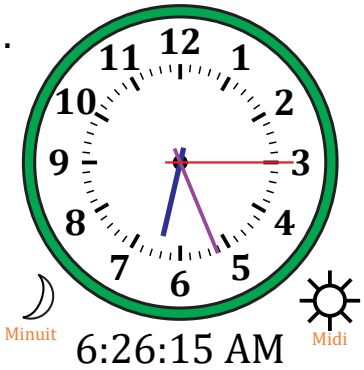

6:26:15 AM

3.

2:43:00 AM

4.

1:31:30 AM

5. 

10:22:15 PM

6.

8:36:45 AM

7. 

5:11:45 AM

8.

9:57:00 PM

9. 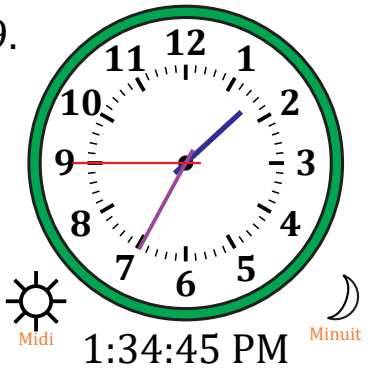

1:34:45 PM

10.

2:34:30 PM

11.

7:26:15 PM

12.

10:04:00 AM

Lecture d'une Horloge Analogique (C)

Nom: _____ Date: _____

Lisez chaque heure et écrivez-la dans l'espace sous l'horloge.

1.


_____

2.


_____

3.


_____

4.


_____

5.


_____

6.


_____

7.


_____

8.


_____

9.


_____

10.


_____

11.


_____

12.


_____

Lecture d'une Horloge Analogique (C) Solutions

Nom: _____ Date: _____

Lisez chaque heure et écrivez-la dans l'espace sous l'horloge.

1. 

12:51:00 PM

2.

10:59:00 AM

3.

5:42:30 PM

4.

2:03:45 AM

5.

3:21:15 PM

6.

5:46:00 AM

7. 

8:07:45 PM

8. 

6:37:15 PM

9.

1:28:45 AM

10.

10:39:30 PM

11. 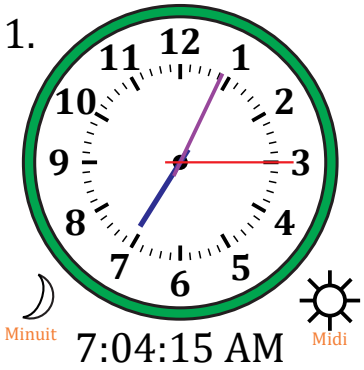

7:04:15 AM

12. 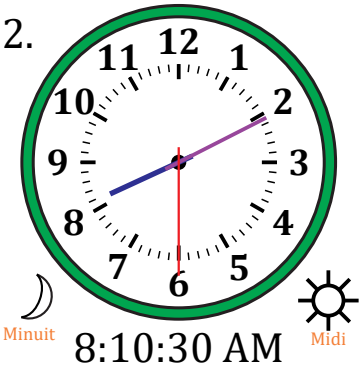

8:10:30 AM

Lecture d'une Horloge Analogique (D)

Nom: _____ Date: _____

Lisez chaque heure et écrivez-la dans l'espace sous l'horloge.

1.


_____

2.


_____

3.


_____

4.


_____

5.


_____

6.


_____

7.


_____

8.


_____

9.


_____

10.


_____

11.


_____

12.


_____

Lecture d'une Horloge Analogique (D) Solutions

Nom: _____ Date: _____

Lisez chaque heure et écrivez-la dans l'espace sous l'horloge.

1. 

9:24:00 PM

2.

5:37:30 PM

3.

1:15:15 PM

4.

12:22:00 AM

5. 

5:19:30 AM

6. 

7:52:45 AM

7. 

9:52:15 AM

8. 

6:42:45 PM

9. 

2:54:15 AM

10. 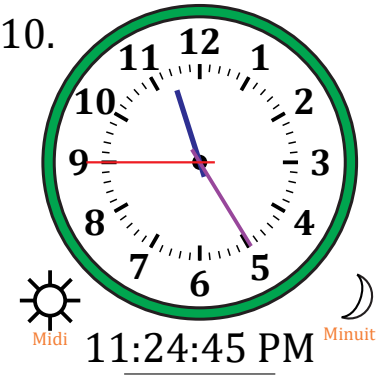

11:24:45 PM

11. 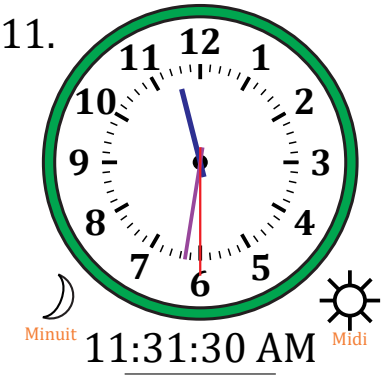

11:31:30 AM

12. 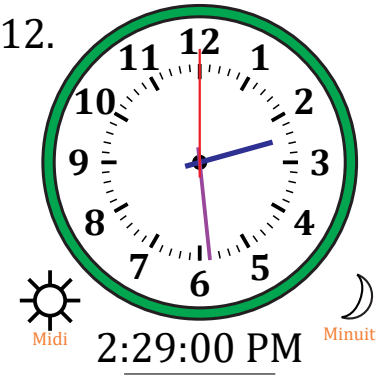

2:29:00 PM

Lecture d'une Horloge Analogique (E)

Nom: _____ Date: _____

Lisez chaque heure et écrivez-la dans l'espace sous l'horloge.

1.


_____

2.


_____

3.


_____

4.


_____

5.


_____

6.


_____

7.


_____

8.


_____

9.


_____

10.


_____

11.


_____

12.


_____

Lecture d'une Horloge Analogique (E) Solutions

Nom: _____ Date: _____

Lisez chaque heure et écrivez-la dans l'espace sous l'horloge.

1.

10:20:30 AM

2.

9:36:45 AM

3.

1:42:15 PM

4.
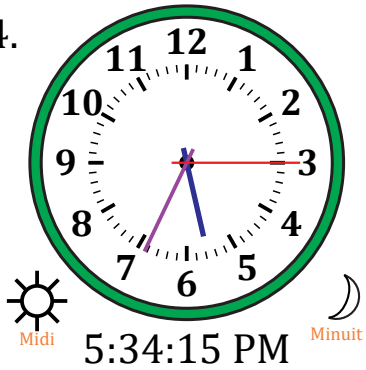

5:34:15 PM

5.

12:16:45 AM

6.


3:09:00 AM

7.

7:48:00 PM

8.


11:39:45 PM

9.

3:30:15 PM

10.


6:47:00 AM

11.
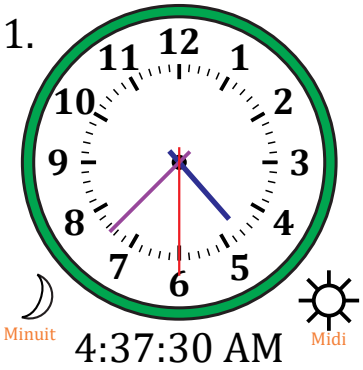

4:37:30 AM

12.

9:26:30 PM

Lecture d'une Horloge Analogique (F)

Nom: _____ Date: _____

Lisez chaque heure et écrivez-la dans l'espace sous l'horloge.

1.


_____

2.


_____

3.


_____

4.


_____

5.


_____

6.


_____

7.
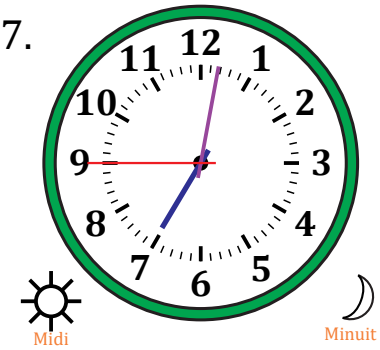

_____

8.


_____

9.


_____

10.


_____

11.


_____

12.
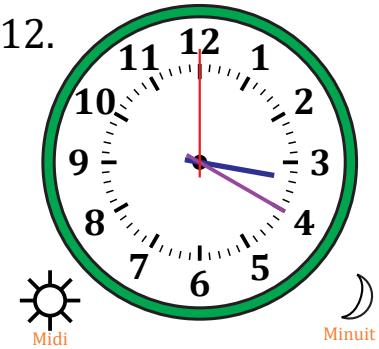

_____

Lecture d'une Horloge Analogique (F) Solutions

Nom: _____ Date: _____

Lisez chaque heure et écrivez-la dans l'espace sous l'horloge.

1.

12:17:15 AM

2.

4:35:45 PM

3.

10:13:00 AM

4.

3:25:15 AM

5. 

10:33:00 PM

6. 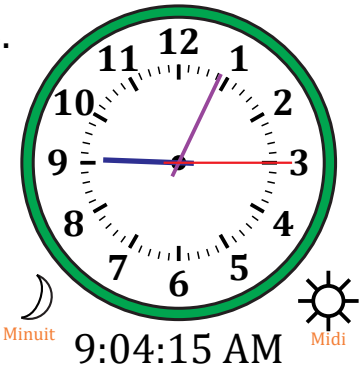

9:04:15 AM

7. 

7:01:45 PM

8. 

5:04:45 AM

9. 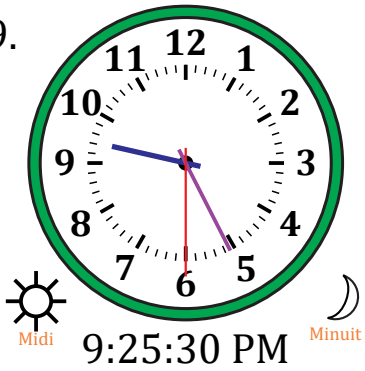

9:25:30 PM

10.

1:27:30 PM

11. 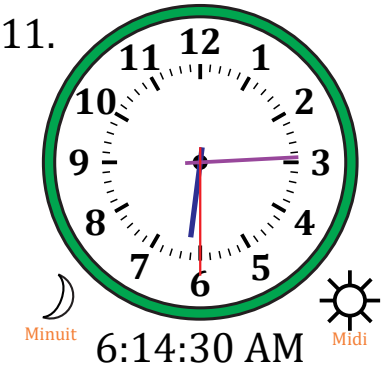

6:14:30 AM

12.

3:20:00 PM

Lecture d'une Horloge Analogique (G)

Nom: _____ Date: _____

Lisez chaque heure et écrivez-la dans l'espace sous l'horloge.

1.


_____

2.


_____

3.


_____

4.


_____

5.


_____

6.
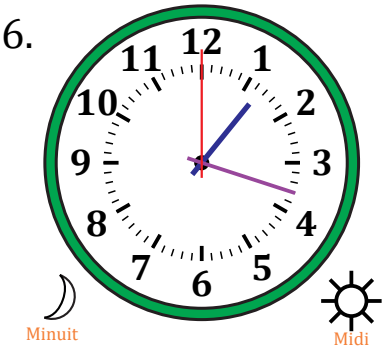

_____

7.


_____

8.


_____

9.


_____

10.


_____

11.


_____

12.


_____

Lecture d'une Horloge Analogique (G) Solutions

Nom: _____ Date: _____

Lisez chaque heure et écrivez-la dans l'espace sous l'horloge.

1.

5:29:45 PM

2.

7:42:00 PM

3.

2:17:15 PM

4. 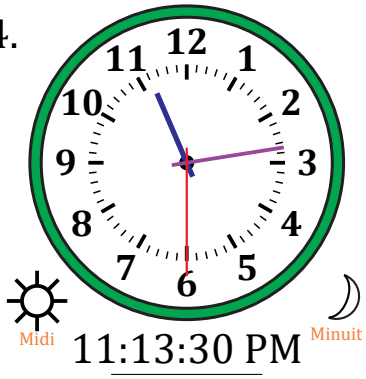

11:13:30 PM

5. 

5:15:45 AM

6. 

1:18:00 AM

7. 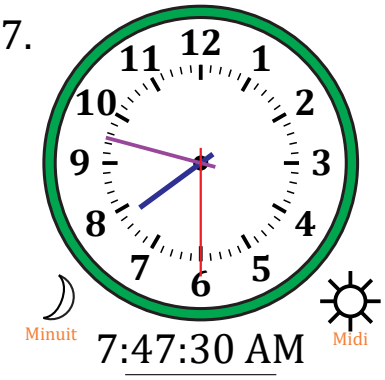

7:47:30 AM

8. 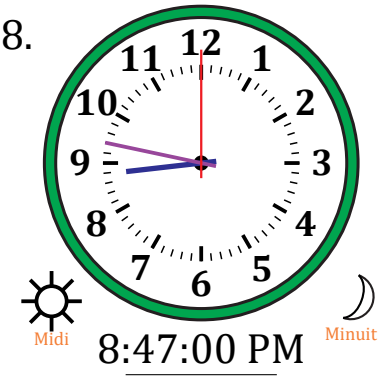

8:47:00 PM

9. 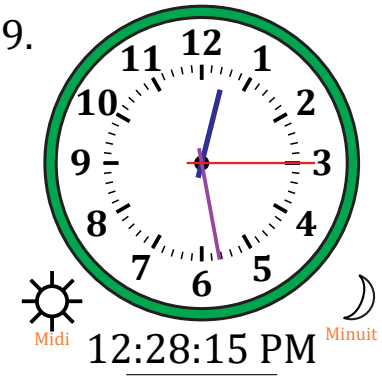

12:28:15 PM

10. 

9:52:45 AM

11. 

11:52:15 AM

12. 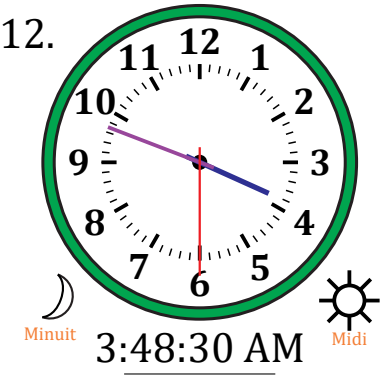

3:48:30 AM

Lecture d'une Horloge Analogique (H)

Nom: _____ Date: _____

Lisez chaque heure et écrivez-la dans l'espace sous l'horloge.

1.


_____

2.


_____

3.


_____

4.


_____

5.


_____

6.


_____

7.


_____

8.


_____

9.


_____

10.


_____

11.


_____

12.


_____

Lecture d'une Horloge Analogique (H) Solutions

Nom: _____ Date: _____

Lisez chaque heure et écrivez-la dans l'espace sous l'horloge.

1.

12:30:30 PM

2. 

4:13:00 PM

3. 

2:17:45 PM

4. 

4:28:00 AM

5. 

2:33:15 AM

6. 

8:07:15 PM

7. 

7:56:00 AM

8. 

6:35:30 PM

9.

8:34:30 AM

10. 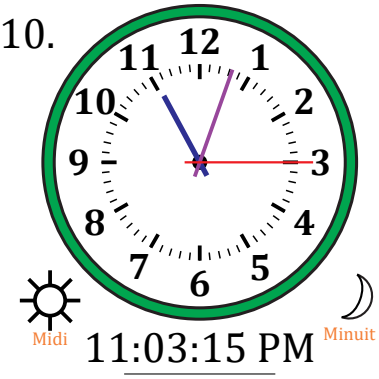

11:03:15 PM

11. 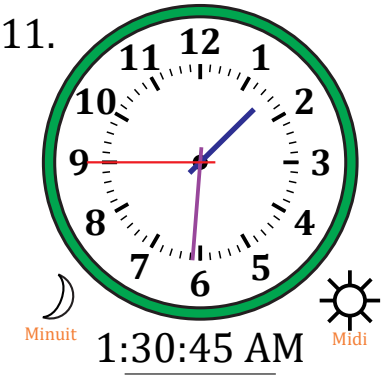

1:30:45 AM

12. 

10:38:45 AM

Lecture d'une Horloge Analogique (I)

Nom: _____ Date: _____

Lisez chaque heure et écrivez-la dans l'espace sous l'horloge.

1.


_____

2.


_____

3.


_____

4.


_____

5.


_____

6.


_____

7.


_____

8.


_____

9.


_____

10.


_____

11.


_____

12.


_____

Lecture d'une Horloge Analogique (I) Solutions

Nom: _____ Date: _____

Lisez chaque heure et écrivez-la dans l'espace sous l'horloge.

1.

6:52:00 AM

2.

3:17:30 AM

3. 

8:17:30 PM

4.

12:18:00 AM

5.

10:17:45 AM

6. 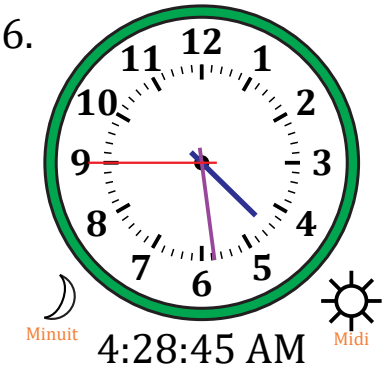

4:28:45 AM

7. 

6:39:15 PM

8. 

9:23:15 AM

9.

10:39:45 PM

10.

2:53:00 PM

11.

12:16:30 PM

12. 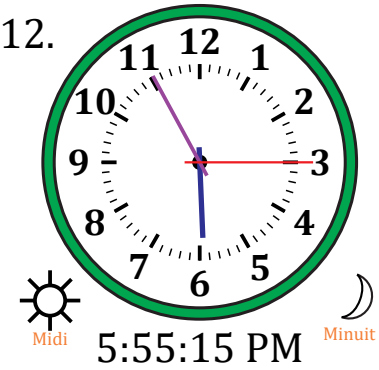

5:55:15 PM

Lecture d'une Horloge Analogique (J)

Nom: _____ Date: _____

Lisez chaque heure et écrivez-la dans l'espace sous l'horloge.

1.


_____

2.


_____

3.


_____

4.


_____

5.


_____

6.


_____

7.


_____

8.


_____

9.


_____

10.


_____

11.


_____

12.


_____

Lecture d'une Horloge Analogique (J) Solutions

Nom: _____ Date: _____

Lisez chaque heure et écrivez-la dans l'espace sous l'horloge.

1.

9:56:45 AM

2.

6:50:15 PM

3.

10:21:00 AM

4.

1:37:30 PM

5. 

10:32:15 PM

6. 

7:09:15 AM

7.

3:19:45 PM

8. 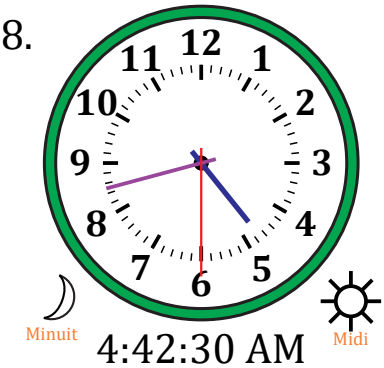

4:42:30 AM

9.

3:23:00 AM

10.

5:17:45 PM

11.

9:41:00 PM

12.

1:25:30 AM