Lecture d'une Horloge Analogique (C)

Nom: _____ Date: _____

Lisez chaque heure et écrivez-la dans l'espace sous l'horloge.

1.


_____

2.


_____

3.


_____

4.


_____

5.


_____

6.


_____

7.


_____

8.

_____

9.


_____

10.


_____

11.


_____

12.


_____

Lecture d'une Horloge Analogique (C) Solutions

Nom: _____ Date: _____

Lisez chaque heure et écrivez-la dans l'espace sous l'horloge.

1.

01h42m15s

2. 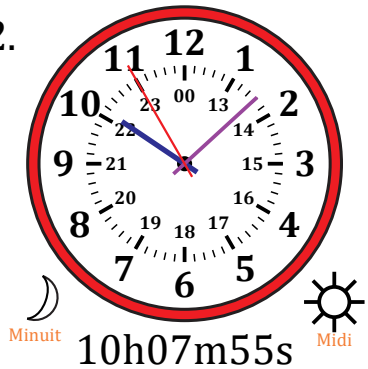

10h07m55s

3. 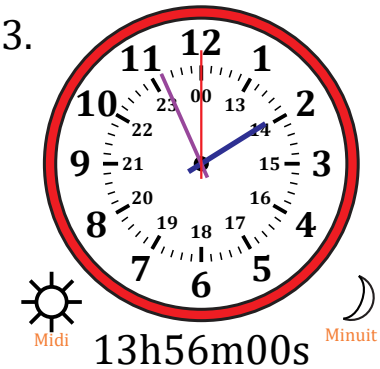

13h56m00s

4. 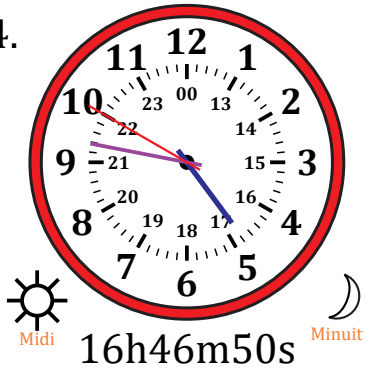

16h46m50s

5. 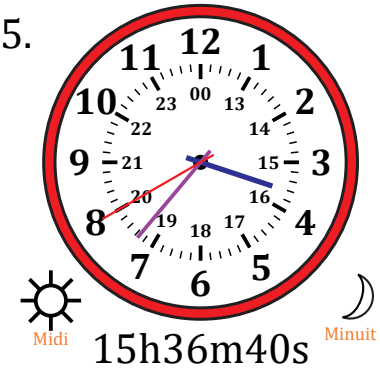

15h36m40s

6. 

04h39m25s

7. 

22h42m20s

8. 

06h38m35s

9. 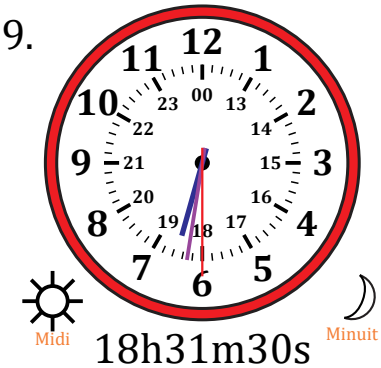

18h31m30s

10. 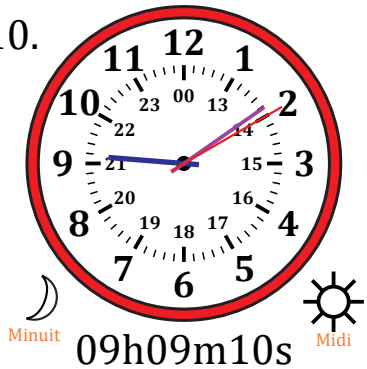

09h09m10s

11. 

03h13m05s

12. 

20h33m45s