Soustraction de Nombres - Droite Graduée (B)

Utlisez la droite graduée pour calculer chaque différence.

1. $60 - 35 =$ ____

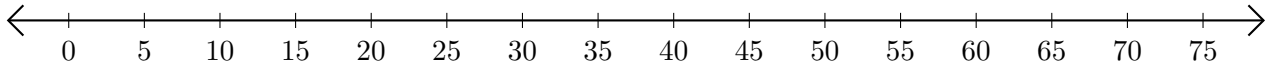

2. $70 - 65 =$ ___

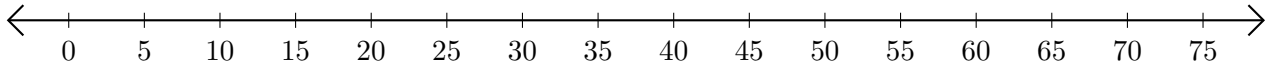

3. $35 - 30 =$ ___

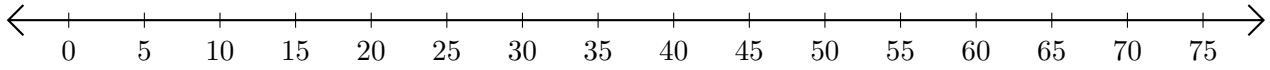

4. $15 - 10 =$ ___

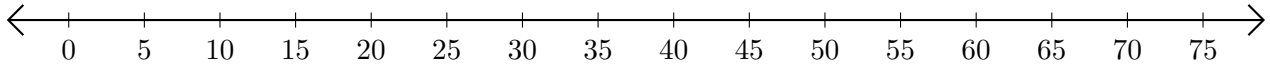

5. $65 - 15 =$ ____

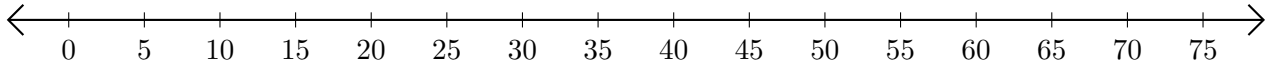

Soustraction de Nombres - Droite Graduée (B) Réponses

Utlisez la droite graduée pour calculer chaque différence.

1. $60 - 35 =$ 25

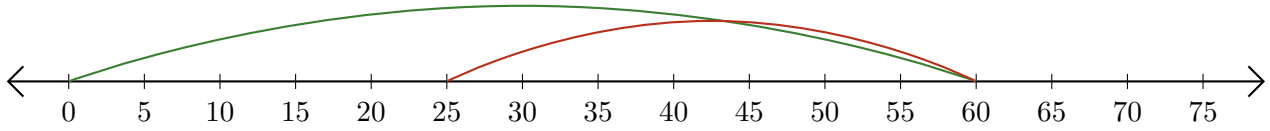

2. $70 - 65 =$ 5

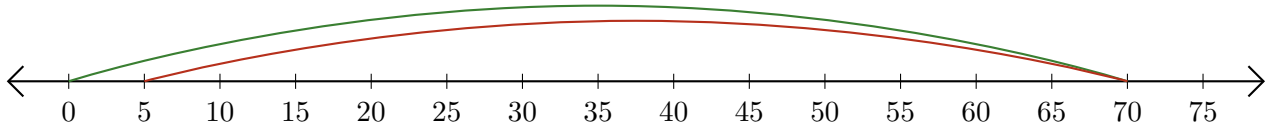

3. $35 - 30 =$ 5

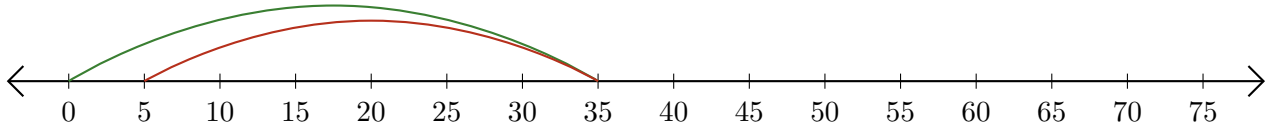

4. $15 - 10 =$ 5


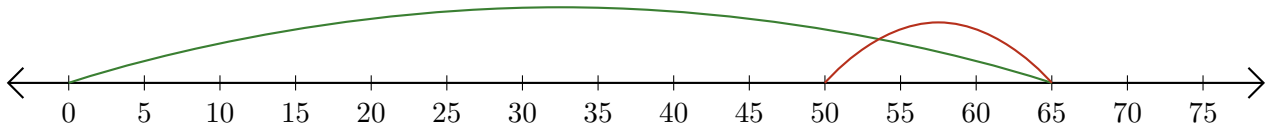
5. $65 - 15 =$ 50