Soustraction de Nombres - Droite Graduée (H)

Utlisez la droite graduée pour calculer chaque différence.

1. $15 - 11 =$ ___

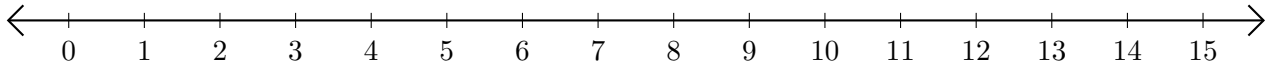

2. $14 - 13 =$ ___

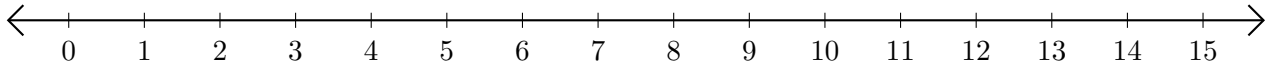

3. $15 - 12 =$ ___

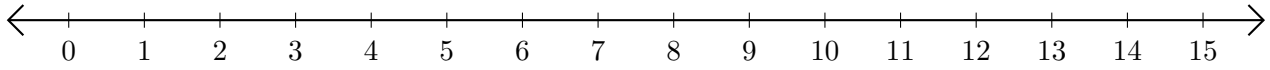

4. $11 - 7 =$ ___

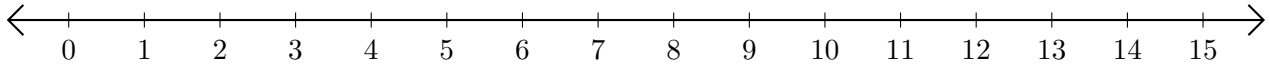
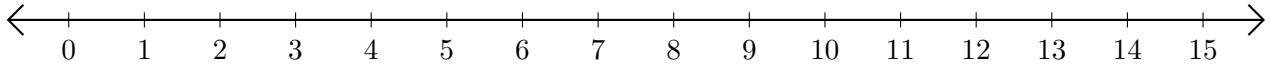
5. $15 - 4 =$ ____