Soustraction de Nombres - Droite Graduée (G)

Utlisez la droite graduée pour calculer chaque différence.

1. $14 - 2 =$ ____

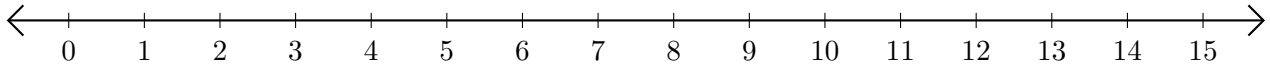

2. $11 - 8 =$ ___

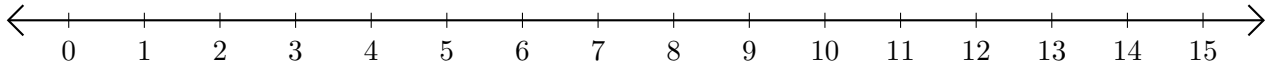

3. $8 - 1 =$ ___

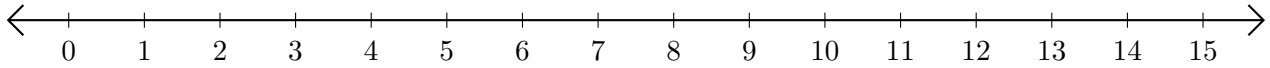

4. $12 - 9 =$ ___

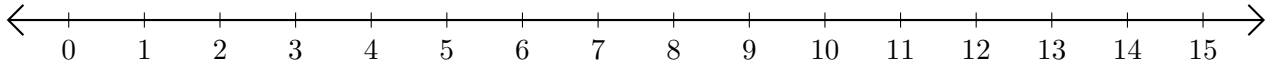
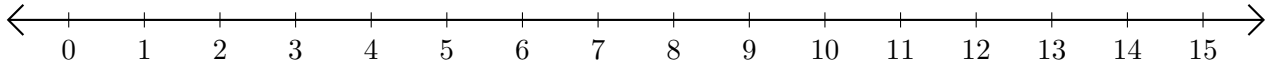
5. $12 - 4 =$ ___