Soustraction de Nombres - Droite Graduée (F)

Utlisez la droite graduée pour calculer chaque différence.

1. $4 - 2 =$ ___

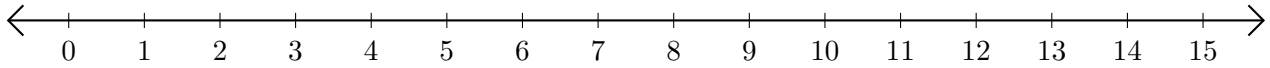

2. $13 - 12 =$ ___

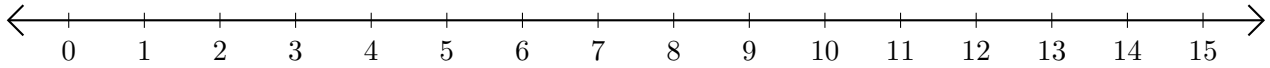

3. $7 - 6 =$ ___

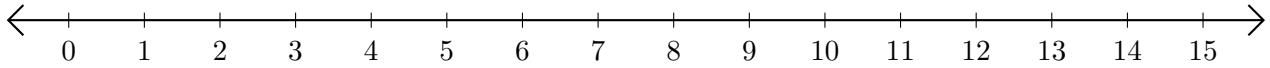

4. $13 - 10 =$ ___

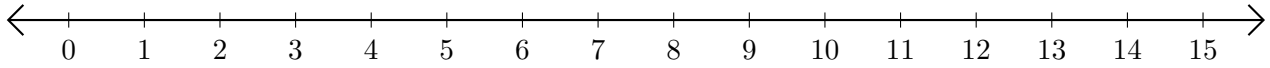
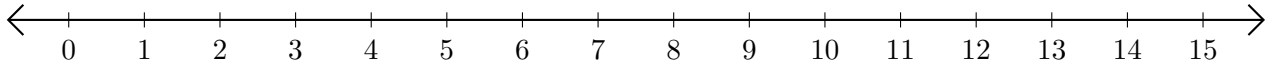
5. $2 - 1 =$ ___