Soustraction de Nombres - Droite Graduée (C)

Utlisez la droite graduée pour calculer chaque différence.

1. $8 - 6 =$ ___

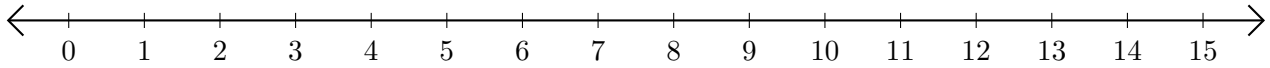

2. $10 - 7 =$ ___

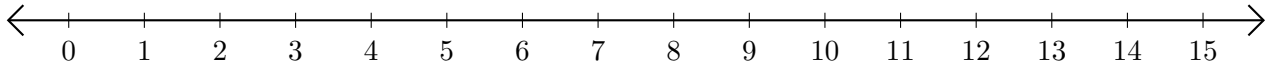

3. $13 - 11 =$ ___

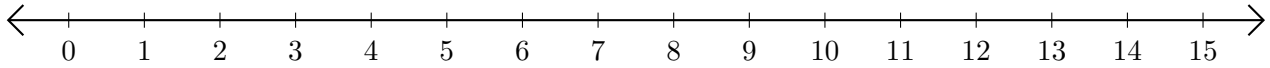

4. $14 - 12 =$ ___

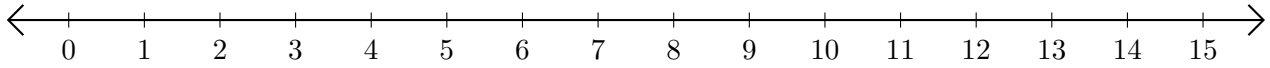
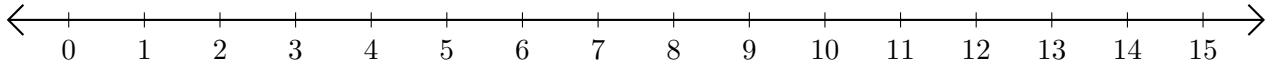
5. $9 - 3 =$ ___