Soustraction de Nombres - Droite Graduée (A)

Utlisez la droite graduée pour calculer chaque différence.

1. $8 - 6 =$ ___

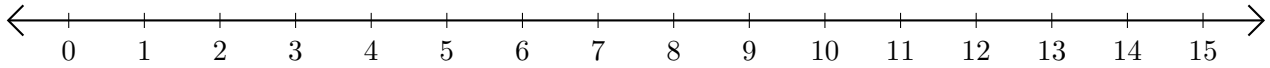

2. $10 - 5 =$ ___

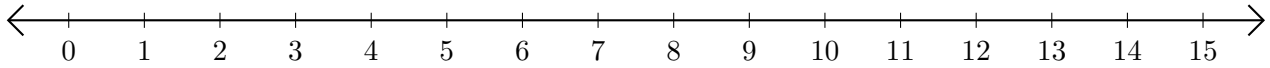

3. $8 - 2 =$ ___

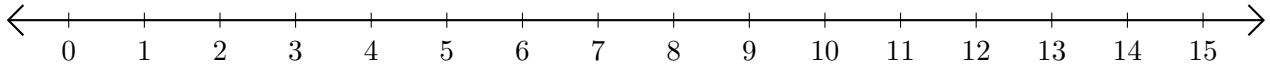

4. $15 - 10 =$ ___

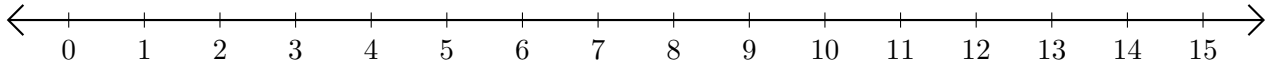
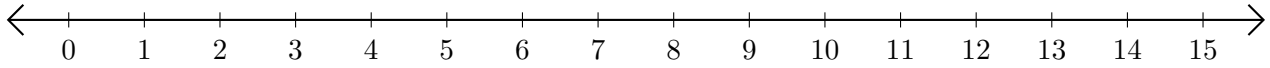
5. $13 - 11 =$ ___