Soustraction de Nombres - Droite Graduée (A)

Utlisez la droite graduée pour calculer chaque différence.

1. $130 - 90 =$ ____

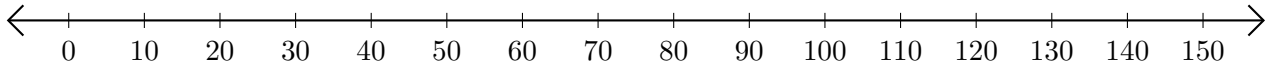

2. $150 - 140 =$ ____

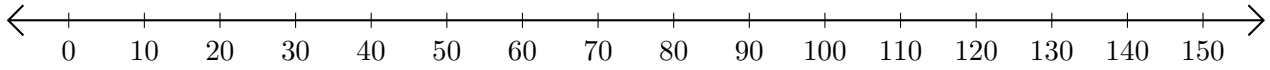

3. $130 - 100 =$ ____

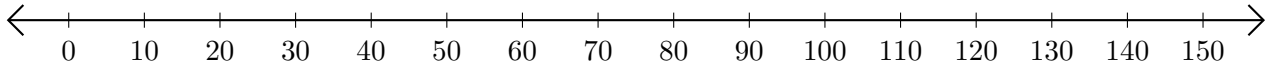

4. $20 - 10 =$ ____

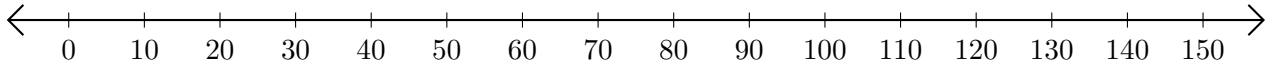

5. $120 - 80 =$ ____

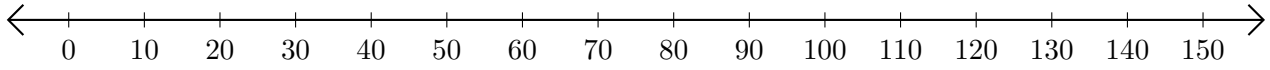

Soustraction de Nombres - Droite Graduée (A) Réponses

Utlisez la droite graduée pour calculer chaque différence.

1. $130 - 90 =$ 40

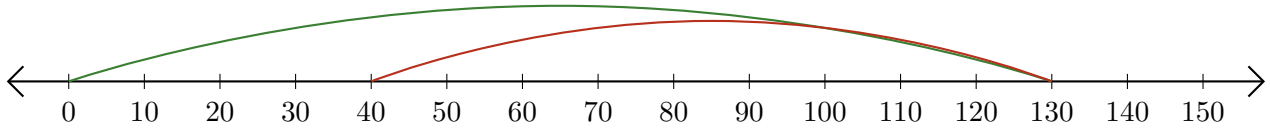

2. $150 - 140 =$ 10

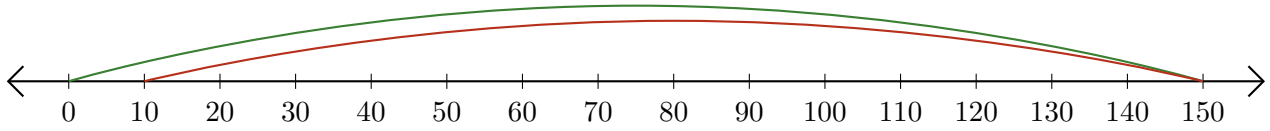

3. $130 - 100 =$ 30

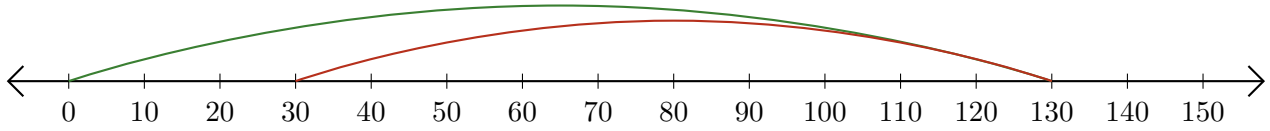

4. $20 - 10 =$ 10

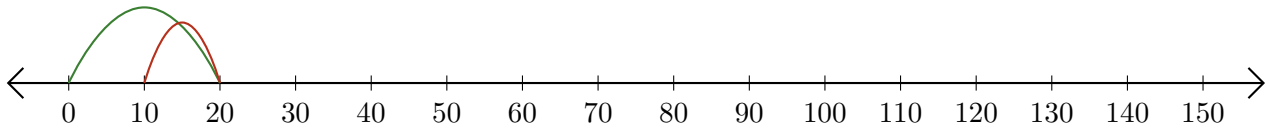

5. $120 - 80 =$ 40

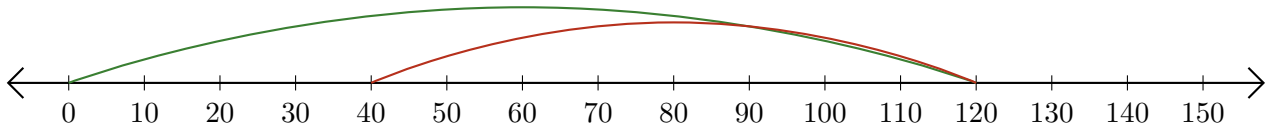

Soustraction de Nombres - Droite Graduée (B)

Utlisez la droite graduée pour calculer chaque différence.

1. $140 - 120 =$ ____

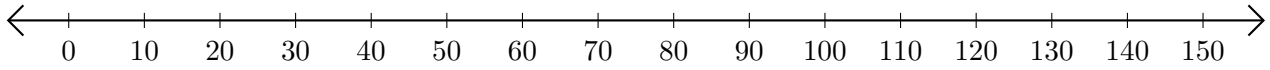

2. $120 - 90 =$ ____

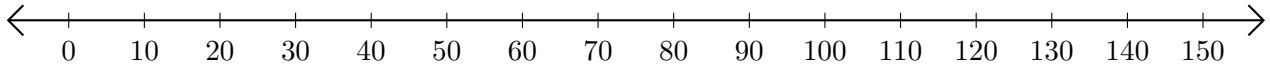

3. $150 - 140 =$ ____

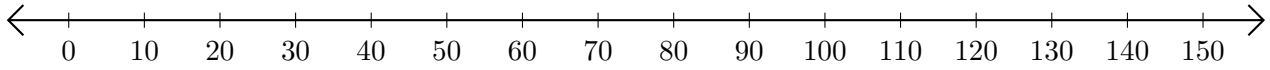

4. $30 - 20 =$ ____

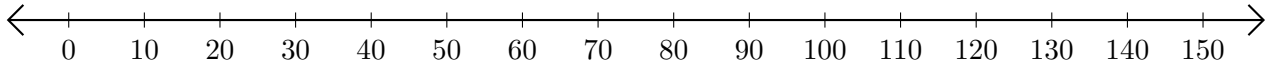

5. $100 - 60 =$ ____

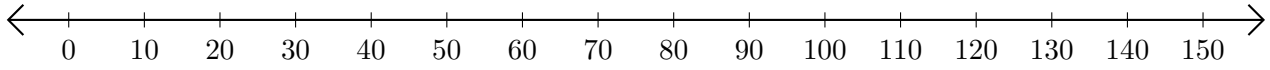

Soustraction de Nombres - Droite Graduée (B) Réponses

Utlisez la droite graduée pour calculer chaque différence.

1. $140 - 120 =$ 20

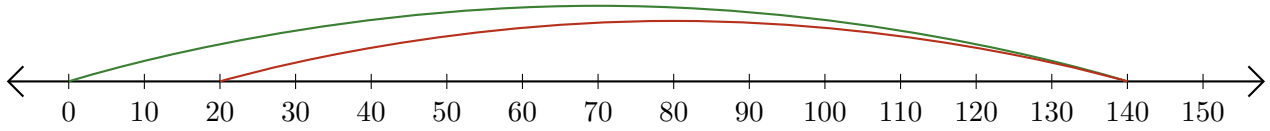

2. $120 - 90 =$ 30

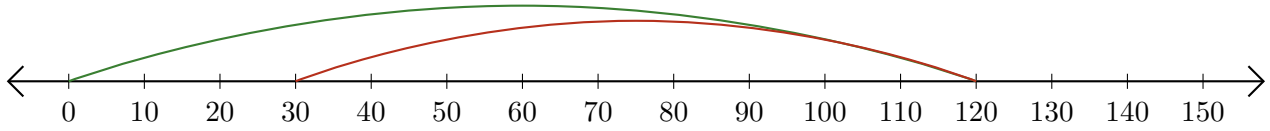

3. $150 - 140 =$ 10

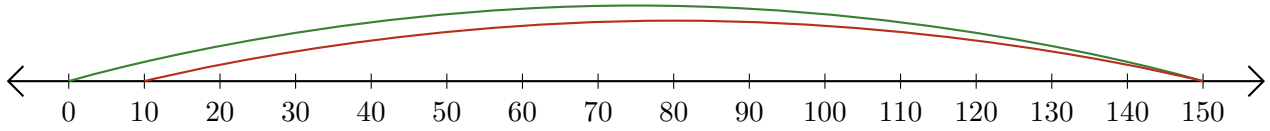

4. $30 - 20 =$ 10

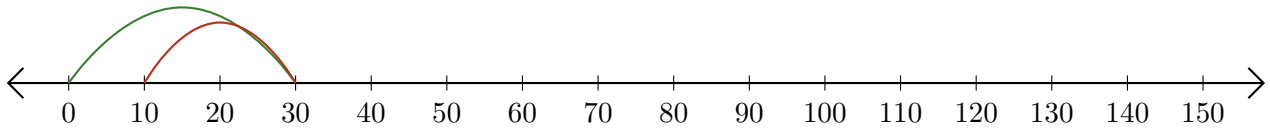

5. $100 - 60 =$ 40

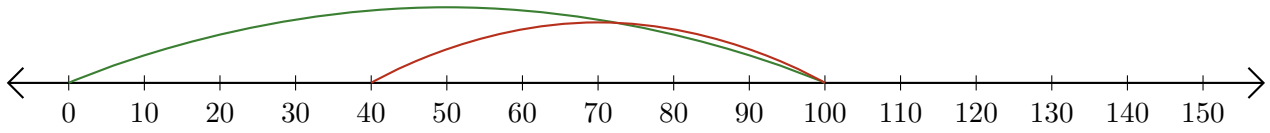

Soustraction de Nombres - Droite Graduée (C)

Utlisez la droite graduée pour calculer chaque différence.

1. $110 - 90 =$ ____

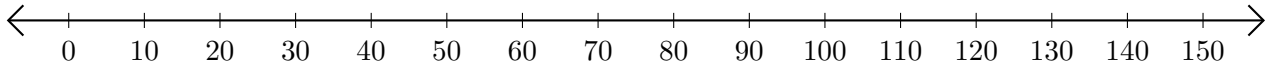

2. $80 - 40 =$ ____

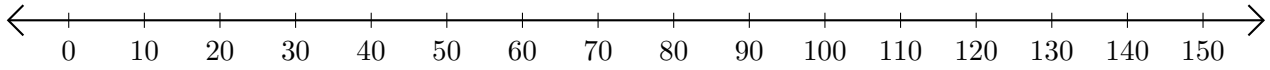

3. $140 - 60 =$ ____

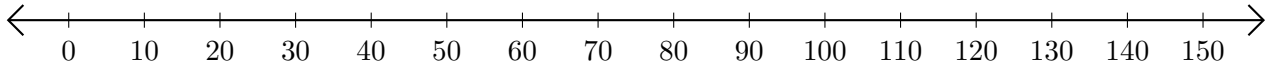

4. $80 - 50 =$ ____

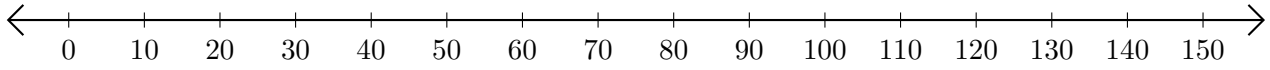

5. $150 - 140 =$ ____

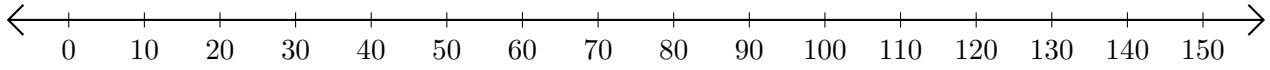

Soustraction de Nombres - Droite Graduée (C) Réponses

Utlisez la droite graduée pour calculer chaque différence.

1. $110 - 90 =$ 20

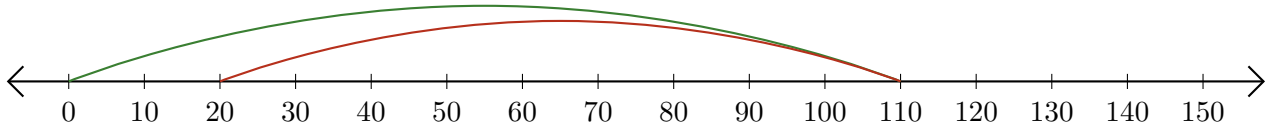

2. $80 - 40 =$ 40

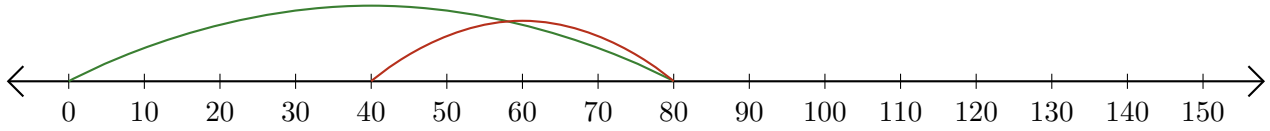

3. $140 - 60 =$ 80

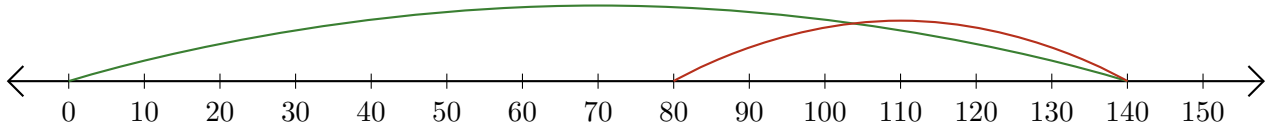

4. $80 - 50 =$ 30

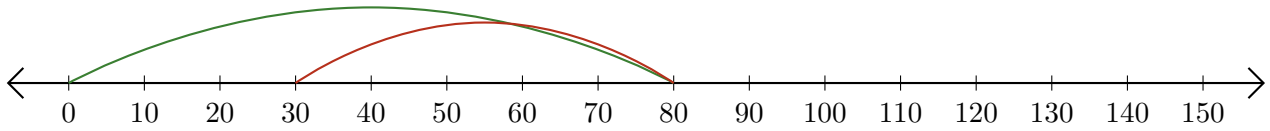

5. $150 - 140 =$ 10

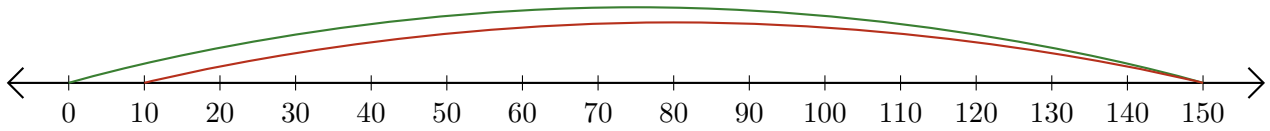

Soustraction de Nombres - Droite Graduée (D)

Utlisez la droite graduée pour calculer chaque différence.

1. $150 - 90 =$ ____

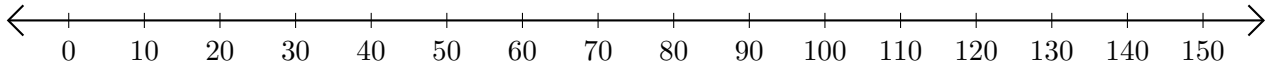

2. $100 - 60 =$ ____

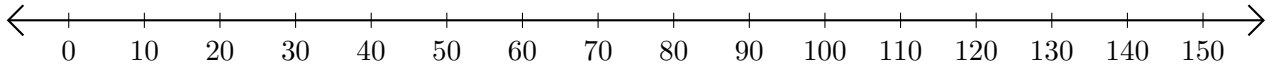

3. $80 - 50 =$ ____

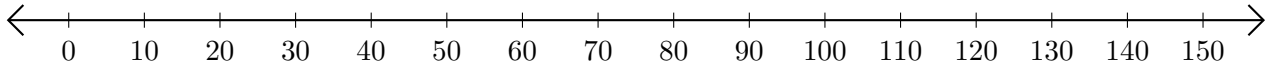

4. $140 - 70 =$ ____

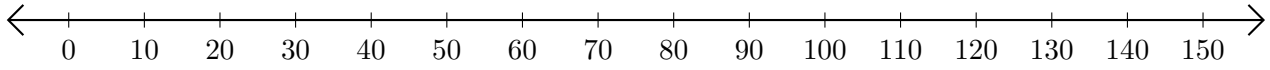

5. $150 - 140 =$ ____

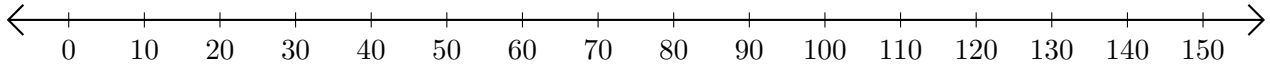

Soustraction de Nombres - Droite Graduée (D) Réponses

Utlisez la droite graduée pour calculer chaque différence.

1. $150 - 90 =$ 60

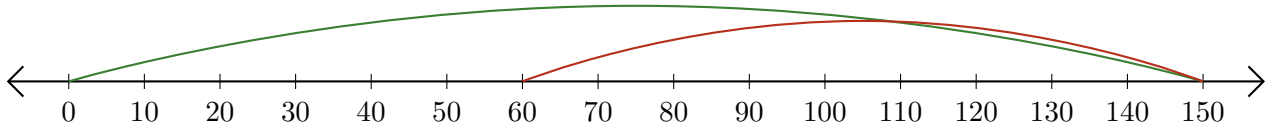

2. $100 - 60 =$ 40

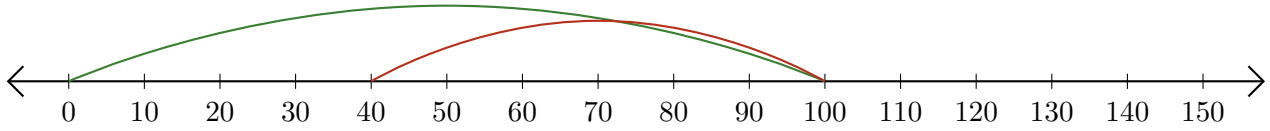

3. $80 - 50 =$ 30

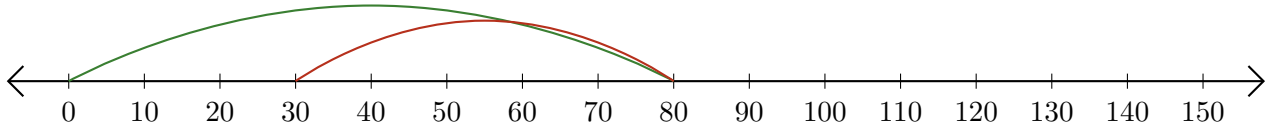

4. $140 - 70 =$ 70

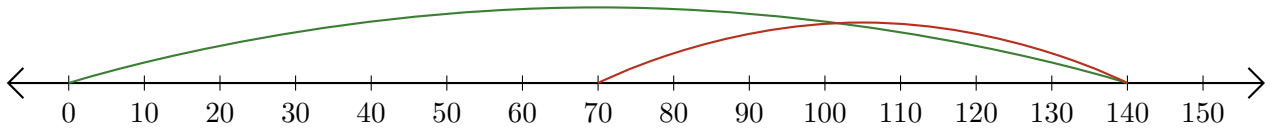

5. $150 - 140 =$ 10

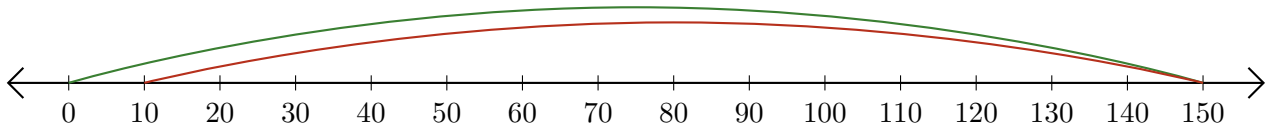

Soustraction de Nombres - Droite Graduée (E)

Utlisez la droite graduée pour calculer chaque différence.

1. $150 - 100 =$ ____

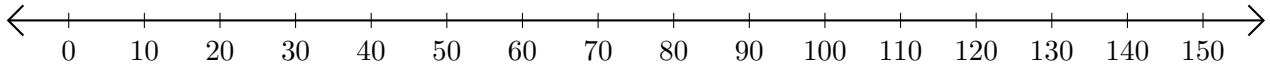

2. $130 - 50 =$ ____

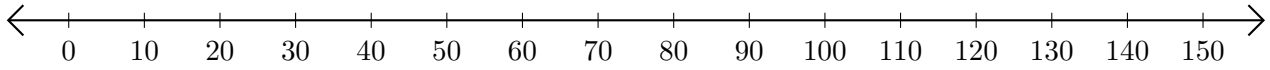

3. $150 - 70 =$ ____

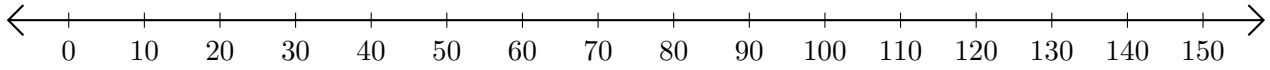

4. $100 - 80 =$ ____

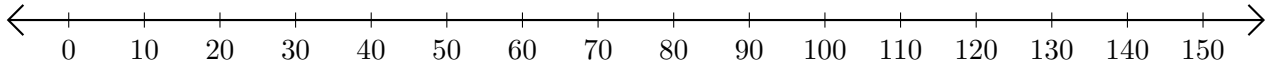

5. $90 - 10 =$ ____

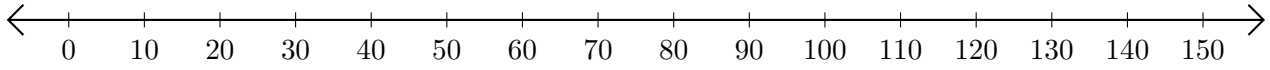

Soustraction de Nombres - Droite Graduée (E) Réponses

Utlisez la droite graduée pour calculer chaque différence.

1. $150 - 100 =$ 50

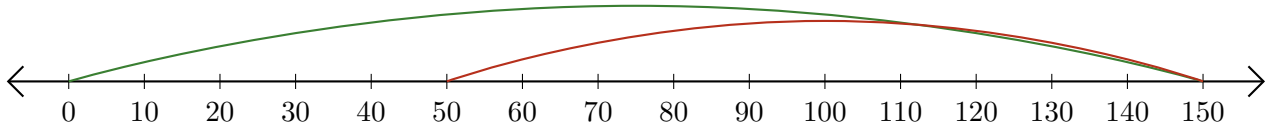

2. $130 - 50 =$ 80

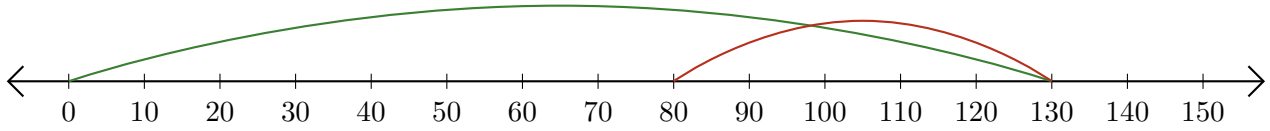

3. $150 - 70 =$ 80

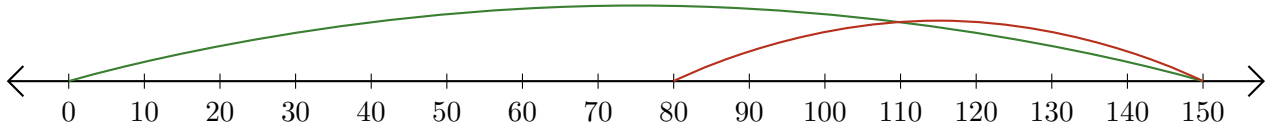

4. $100 - 80 =$ 20

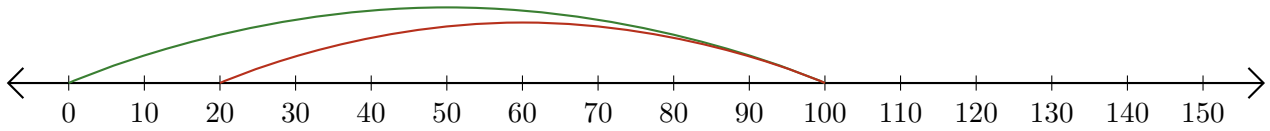

5. $90 - 10 =$ 80

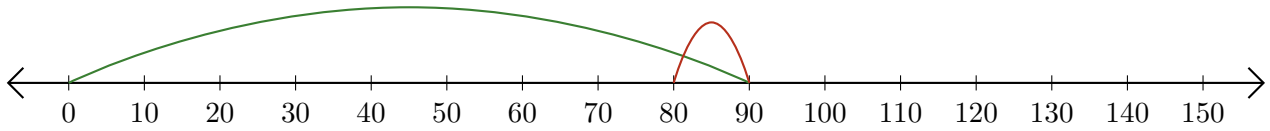

Soustraction de Nombres - Droite Graduée (F)

Utlisez la droite graduée pour calculer chaque différence.

1. $110 - 20 =$ ____

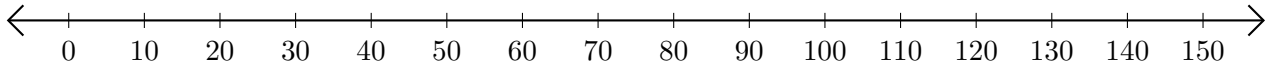

2. $130 - 120 =$ ____

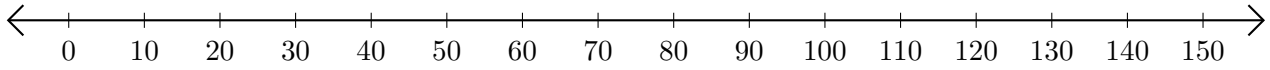

3. $90 - 30 =$ ____

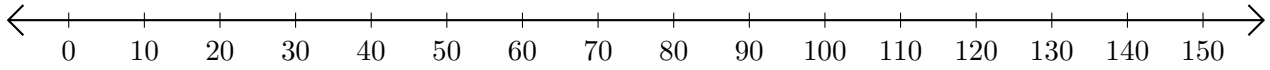

4. $150 - 140 =$ ____

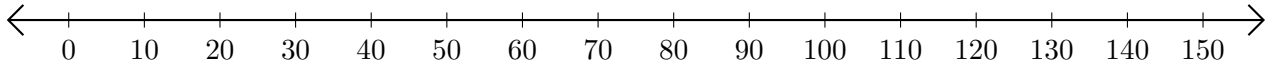

5. $110 - 80 =$ ____

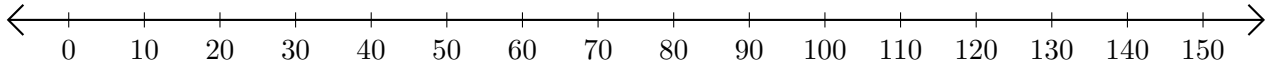

Soustraction de Nombres - Droite Graduée (F) Réponses

Utlisez la droite graduée pour calculer chaque différence.

1. $110 - 20 =$ 90

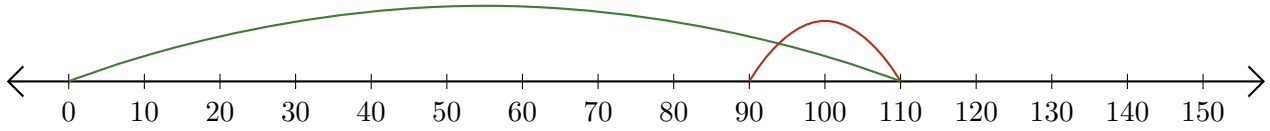

2. $130 - 120 =$ 10

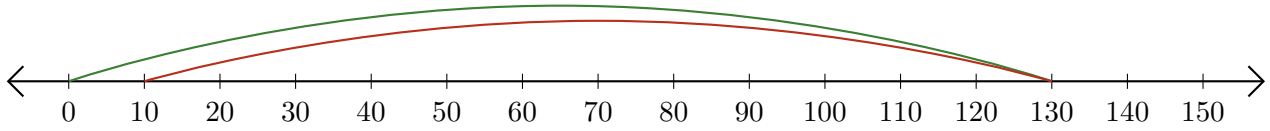

3. $90 - 30 =$ 60

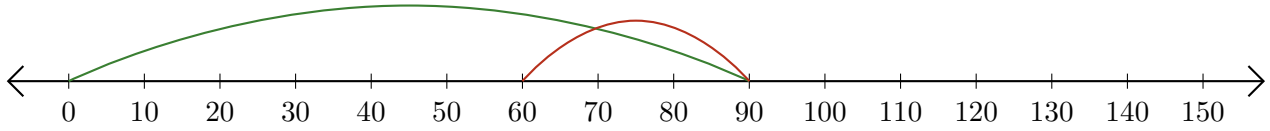

4. $150 - 140 =$ 10

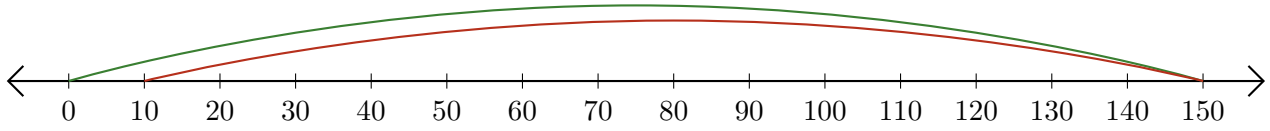

5. $110 - 80 =$ 30

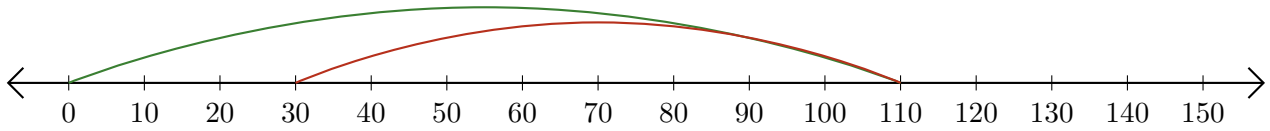

Soustraction de Nombres - Droite Graduée (G)

Utlisez la droite graduée pour calculer chaque différence.

1. $120 - 70 =$ ____

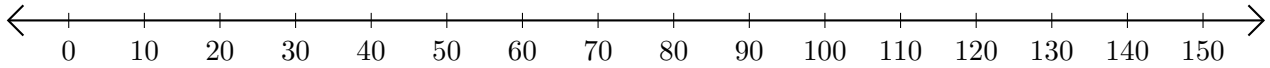

2. $40 - 30 =$ ____

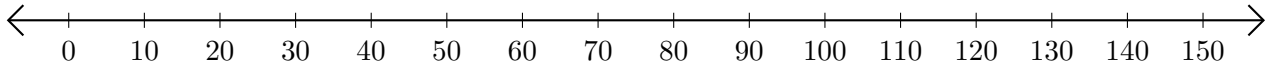

3. $40 - 20 =$ ____

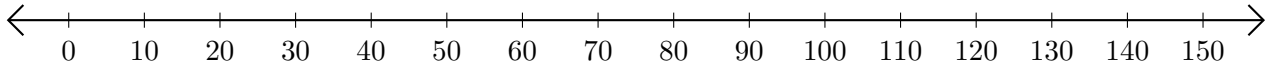

4. $140 - 110 =$ ____

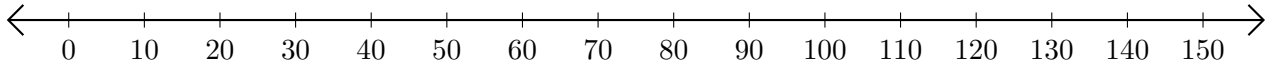

5. $110 - 50 =$ ____

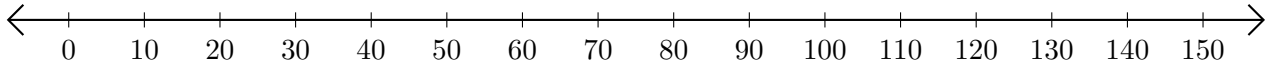

Soustraction de Nombres - Droite Graduée (G) Réponses

Utlisez la droite graduée pour calculer chaque différence.

1. $120 - 70 =$ 50

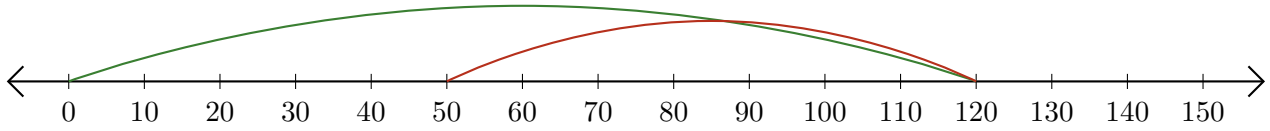

2. $40 - 30 =$ 10

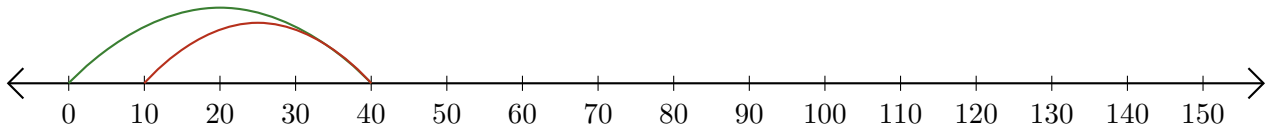

3. $40 - 20 =$ 20

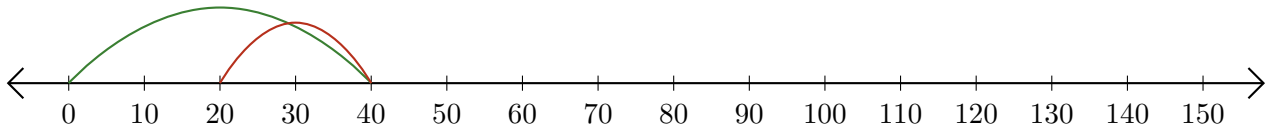

4. $140 - 110 =$ 30

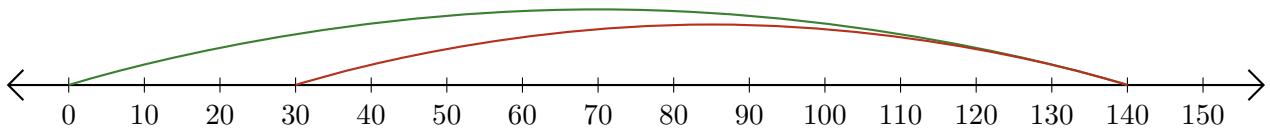

5. $110 - 50 =$ 60

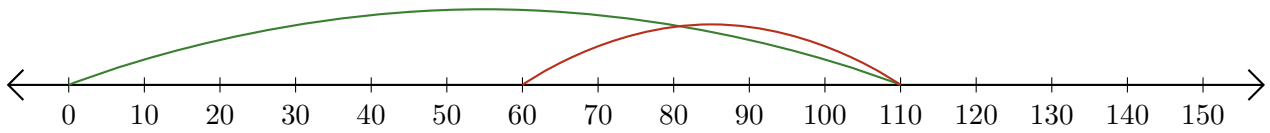

Soustraction de Nombres - Droite Graduée (H)

Utlisez la droite graduée pour calculer chaque différence.

1. $120 - 50 =$ ____

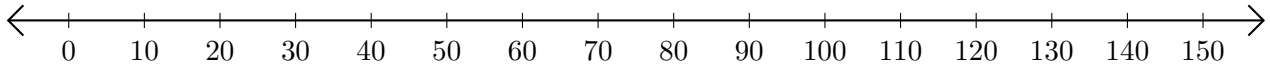

2. $150 - 60 =$ ____

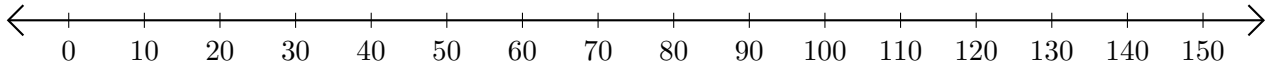

3. $90 - 70 =$ ____

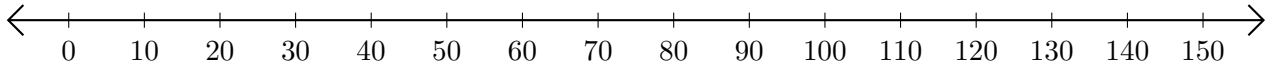

4. $150 - 140 =$ ____

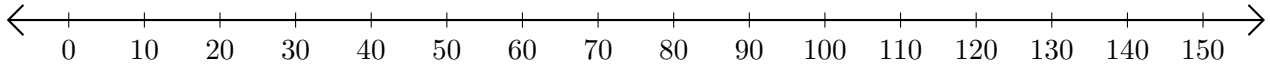

5. $80 - 30 =$ ____

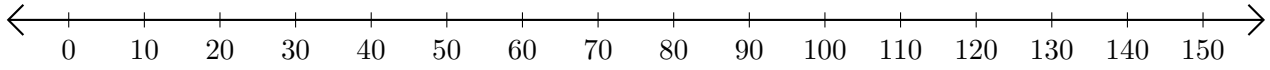

Soustraction de Nombres - Droite Graduée (H) Réponses

Utlisez la droite graduée pour calculer chaque différence.

1. $120 - 50 =$ 70

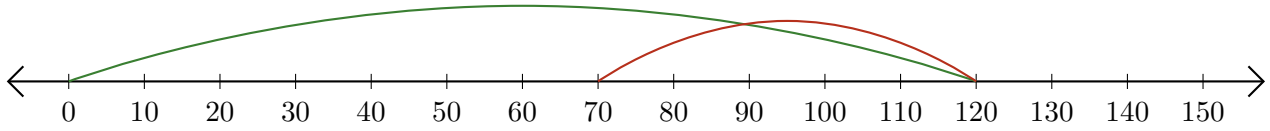

2. $150 - 60 =$ 90

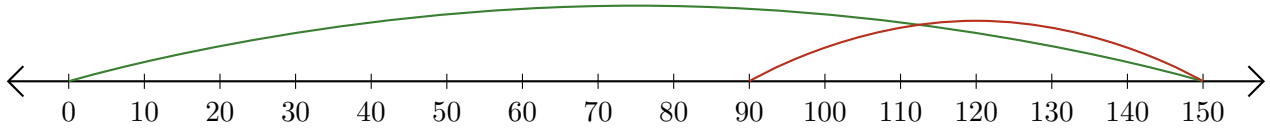

3. $90 - 70 =$ 20

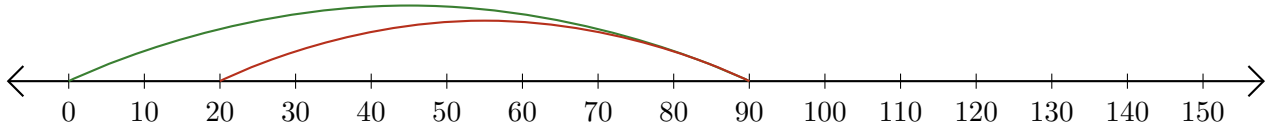

4. $150 - 140 =$ 10

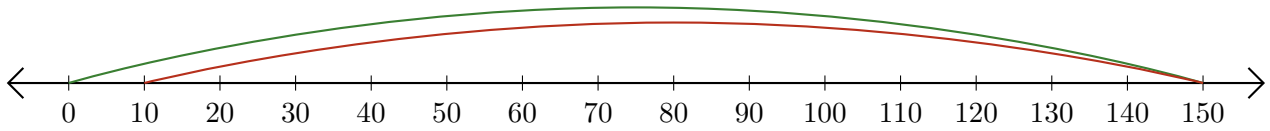

5. $80 - 30 =$ 50

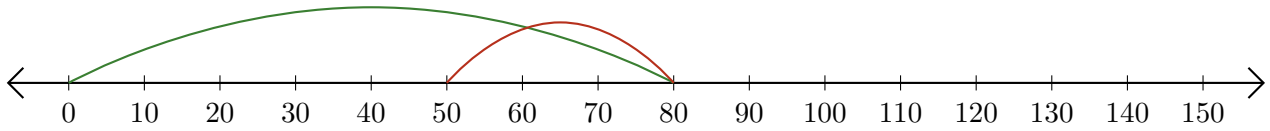

Soustraction de Nombres - Droite Graduée (I)

Utlisez la droite graduée pour calculer chaque différence.

1. $150 - 140 =$ ____

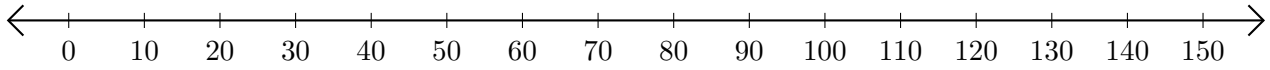

2. $110 - 100 =$ ____

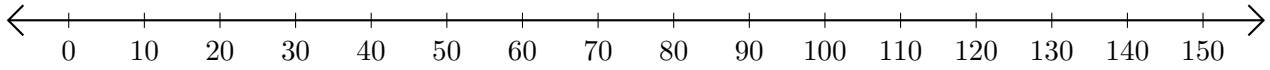

3. $140 - 130 =$ ____

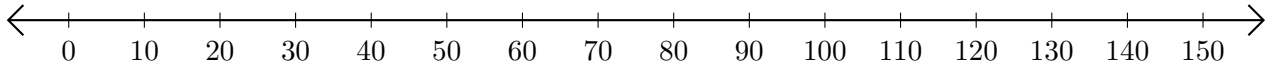

4. $80 - 10 =$ ____

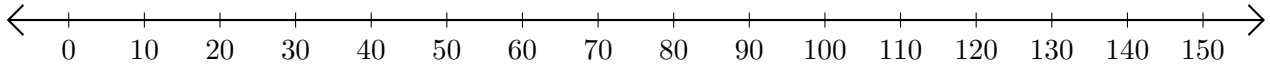

5. $140 - 80 =$ ____

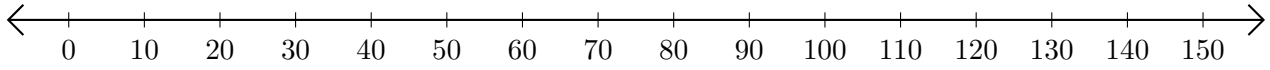

Soustraction de Nombres - Droite Graduée (I) Réponses

Utlisez la droite graduée pour calculer chaque différence.

1. $150 - 140 =$ 10

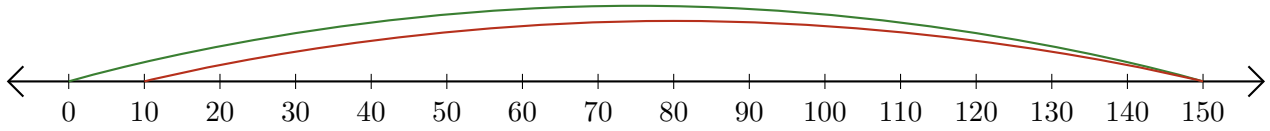

2. $110 - 100 =$ 10

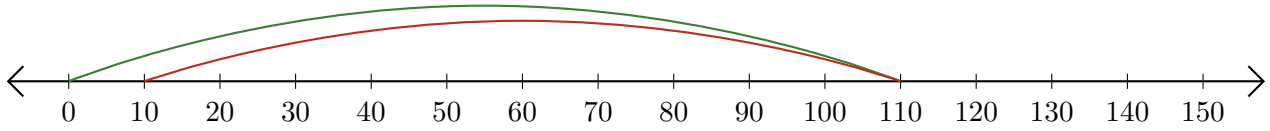

3. $140 - 130 =$ 10

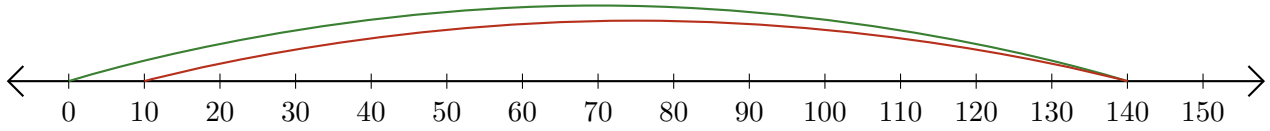

4. $80 - 10 =$ 70

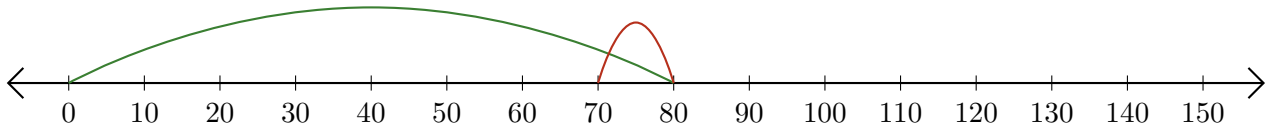

5. $140 - 80 =$ 60

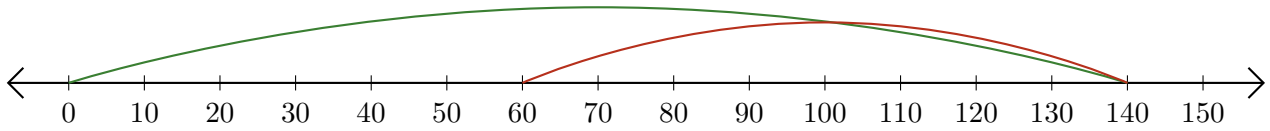

Soustraction de Nombres - Droite Graduée (J)

Utlisez la droite graduée pour calculer chaque différence.

1. $120 - 10 =$ _____

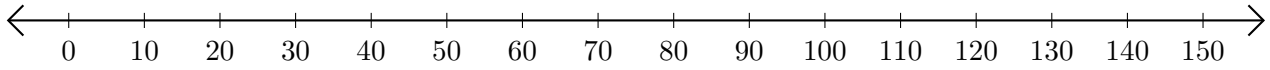

2. $110 - 100 =$ ____

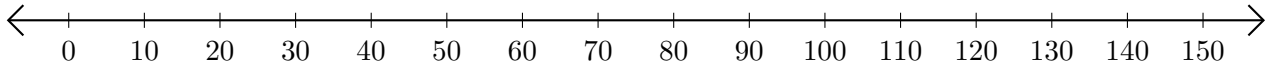

3. $60 - 50 =$ ____

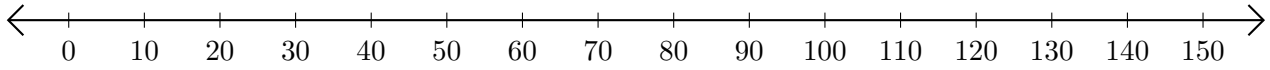

4. $70 - 40 =$ ____

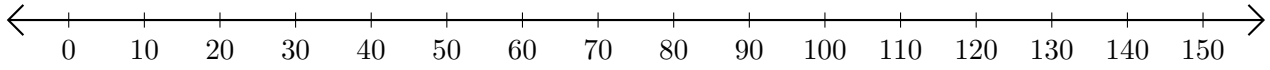

5. $110 - 90 =$ ____

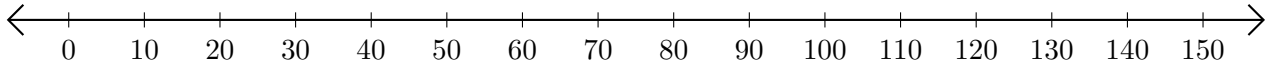

Soustraction de Nombres - Droite Graduée (J) Réponses

Utlisez la droite graduée pour calculer chaque différence.

1. $120 - 10 =$ 110

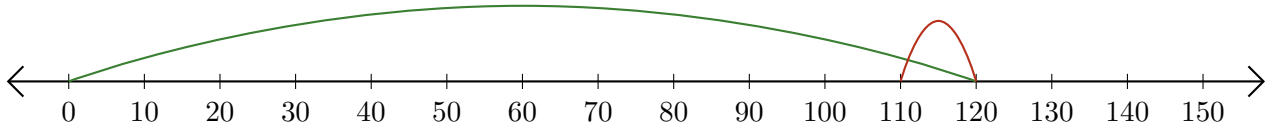

2. $110 - 100 =$ 10

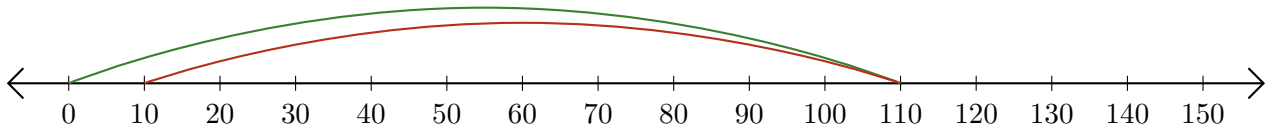

3. $60 - 50 =$ 10

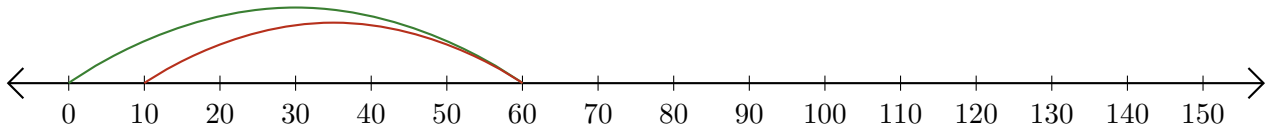

4. $70 - 40 =$ 30

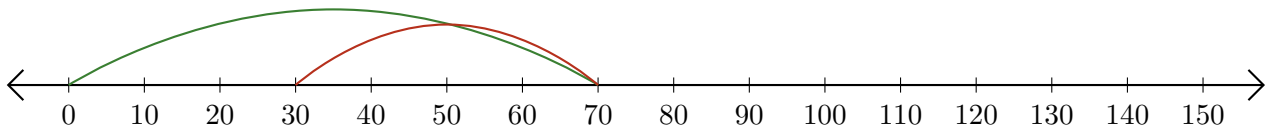
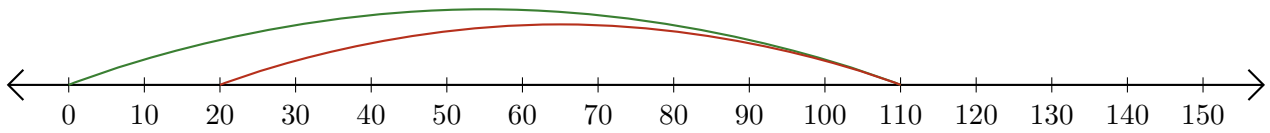
5. $110 - 90 =$ 20