Soustraction de Nombres - Droite Graduée (D)

Utlisez la droite graduée pour calculer chaque différence.

1. $150 - 90 =$ ____

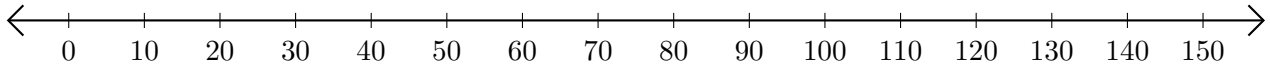

2. $100 - 60 =$ ____

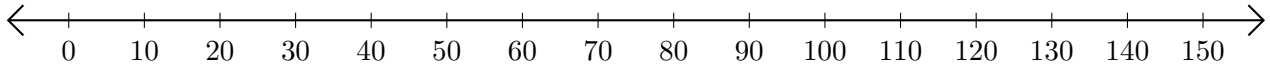

3. $80 - 50 =$ ____

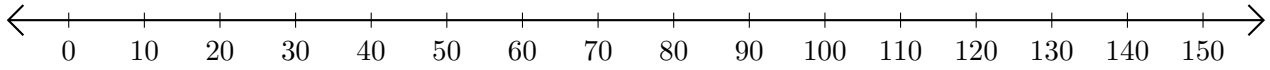

4. $140 - 70 =$ ____

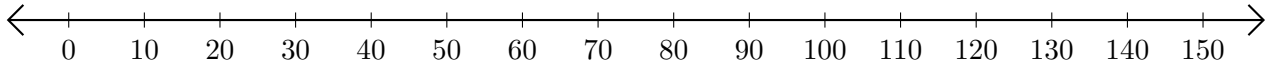
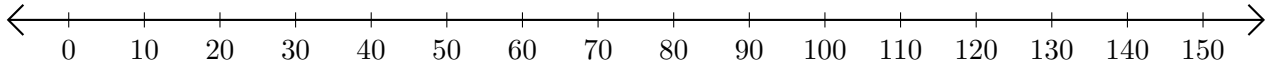
5. $150 - 140 =$ ____