Soustraction de Nombres - Droite Graduée (F)

Utlisez la droite graduée pour calculer chaque différence.

1. $10 - 9 =$ ___

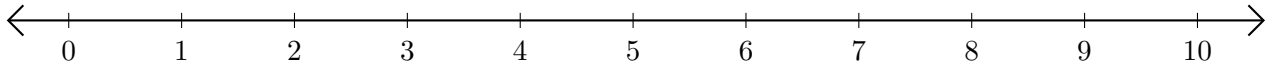

2. $7 - 2 =$ ___

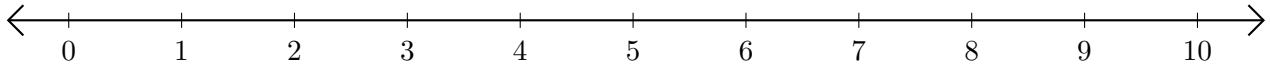

3. $5 - 3 =$ ___

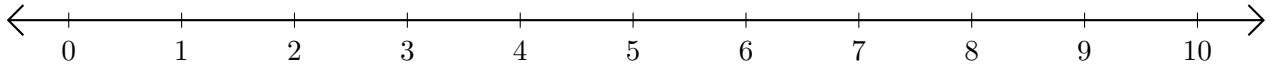

4. $9 - 6 =$ ___

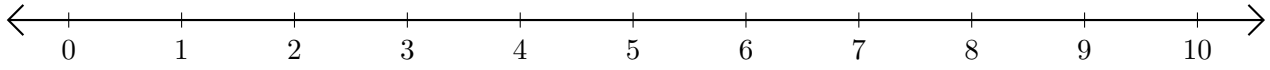
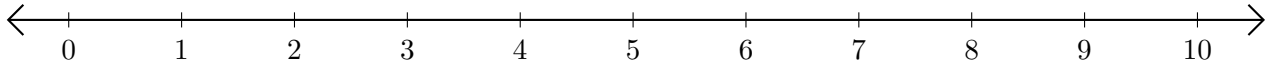
5. $9 - 5 =$ ___