Soustraction de Nombres - Droite Graduée (B)

Utlisez la droite graduée pour calculer chaque différence.

1. $10 - 8 =$ ___

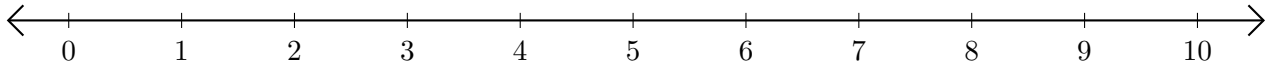

2. $7 - 6 =$ ___

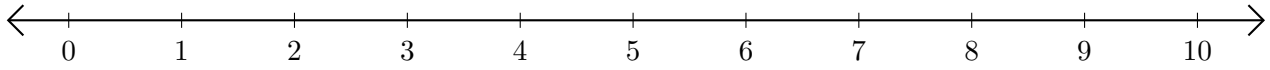

3. $6 - 3 =$ ___

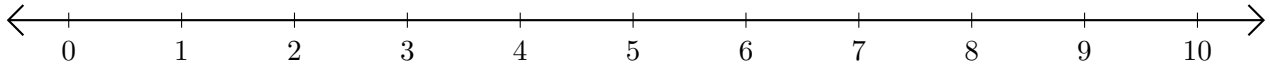

4. $10 - 9 =$ ___

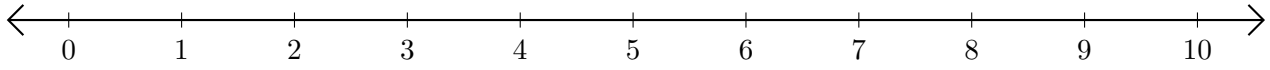
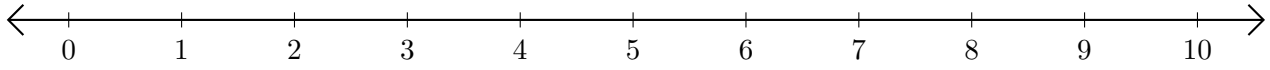
5. $8 - 7 =$ ___