Soustraction de Nombres - Droite Graduée (B)

Utlisez la droite graduée pour calculer chaque différence.

1. $60 - 40 =$ ____

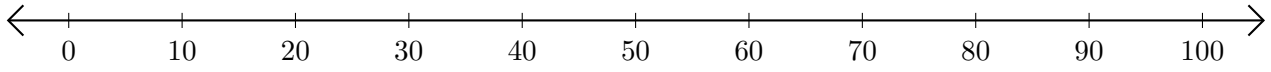

2. $80 - 70 =$ ____

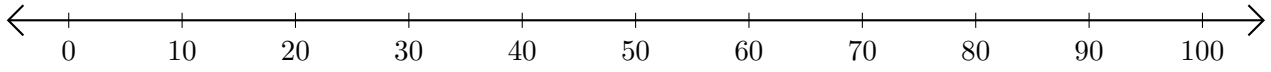

3. $90 - 30 =$ ____

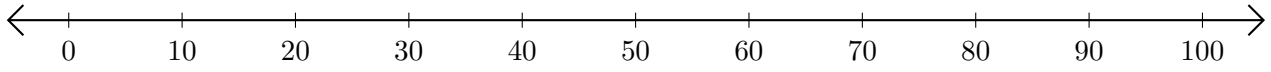

4. $100 - 50 =$ ____

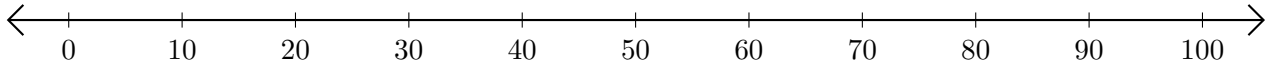

5. $40 - 10 =$ ____

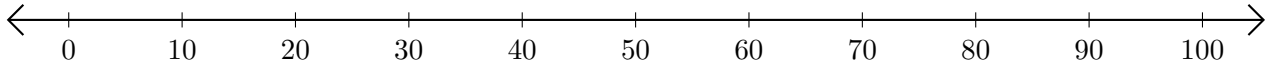

Soustraction de Nombres - Droite Graduée (B) Réponses

Utlisez la droite graduée pour calculer chaque différence.

1. $60 - 40 =$ 20

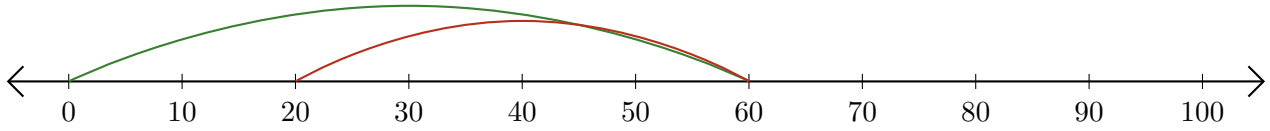

2. $80 - 70 =$ 10

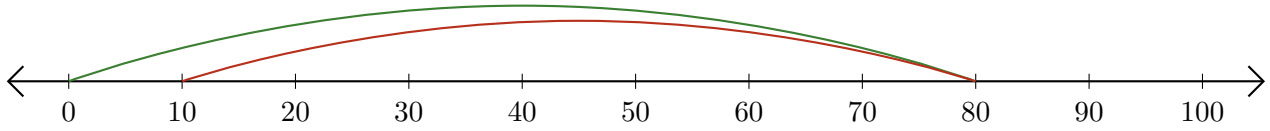

3. $90 - 30 =$ 60

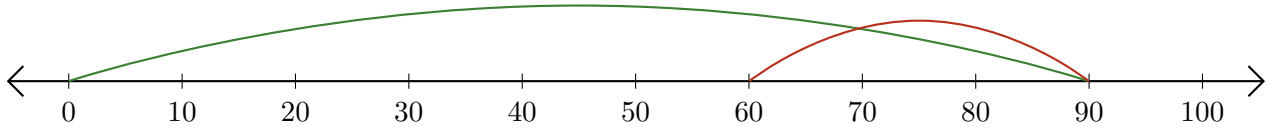

4. $100 - 50 =$ 50

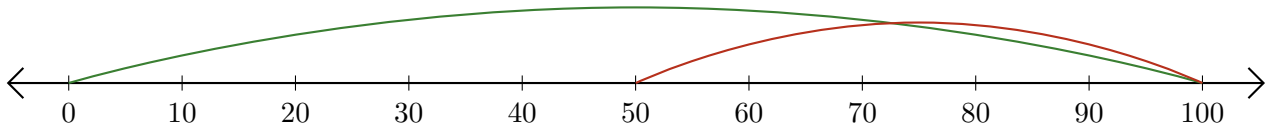
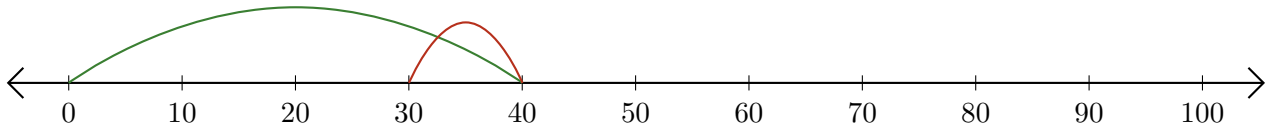
5. $40 - 10 =$ 30