Lecture de Nombres sur une Droite Graduée (I)

Déterminez les termes et la somme (résultat) représentés sur chaque droite graduée.

1. _____ + _____ = _____

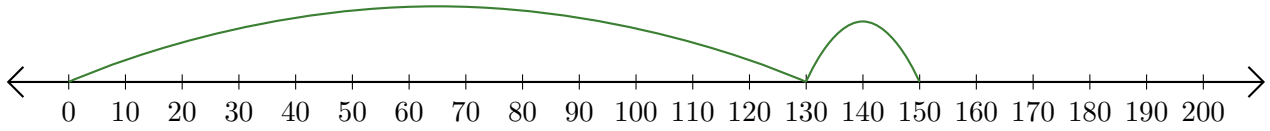

2. _____ + _____ = _____

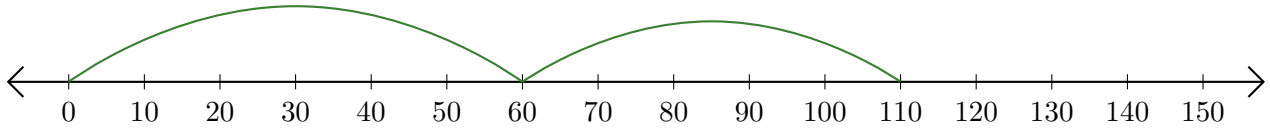

3. ____ + _____ = _____

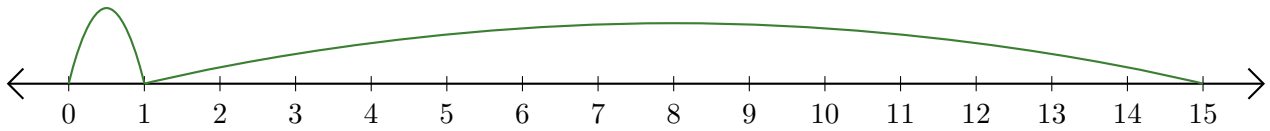

4. _____ + ____ = _____

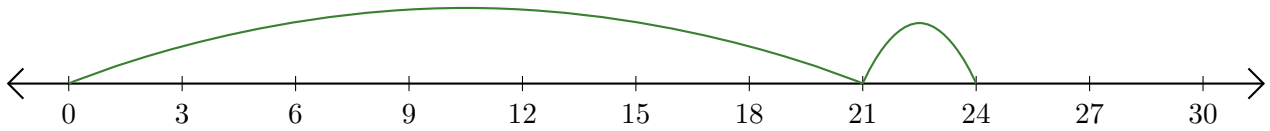

5. ____ + ____ = _____