Addition de Nombres sur une Droite Graduée (E)

Utlisez la droite graduée pour calculer chaque somme.

1. $22 + 8 =$ ____

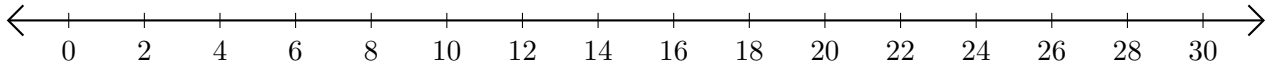

2. $28 + 2 =$ ____

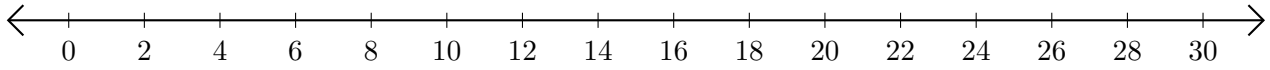

3. $14 + 2 =$ ____

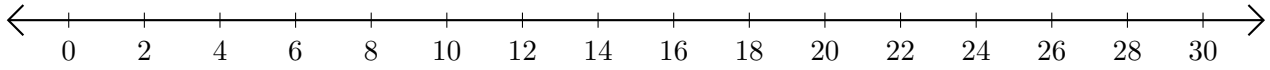

4. $10 + 4 =$ ____

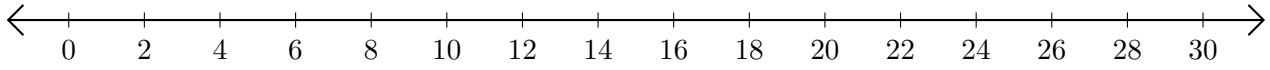
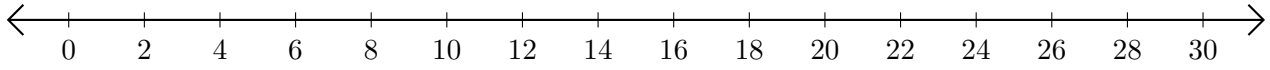
5. $26 + 2 =$ ____