Addition de Nombres sur une Droite Graduée (I)

Utlisez la droite graduée pour calculer chaque somme.

1. $16 + 2 =$ ____

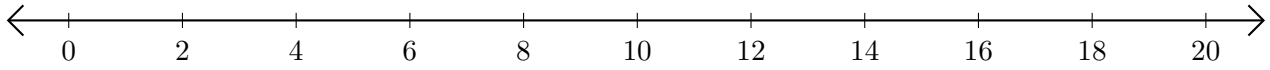

2. $12 + 2 =$ ____

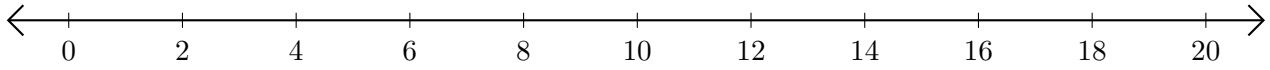

3. $8 + 12 =$ ____

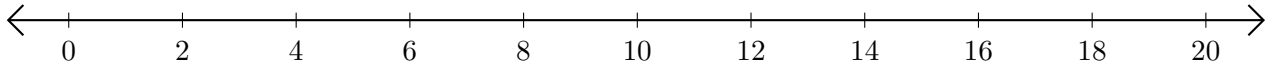

4. $14 + 4 =$ ____

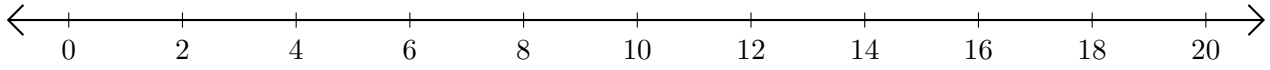
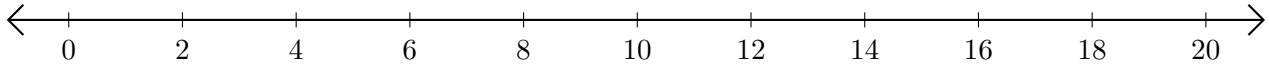
5. $4 + 16 =$ ____