Addition de Nombres sur une Droite Graduée (G)

Utlisez la droite graduée pour calculer chaque somme.

1. $8 + 8 =$ ____

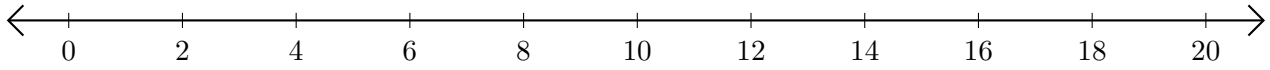

2. $14 + 6 =$ ____

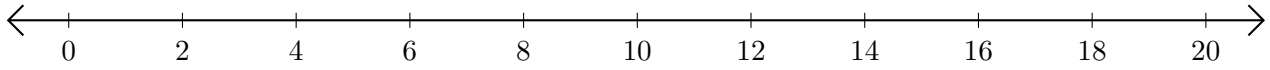

3. $4 + 6 =$ ____

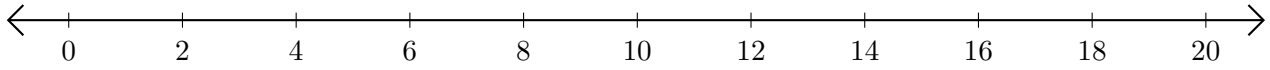

4. $2 + 18 =$ ____

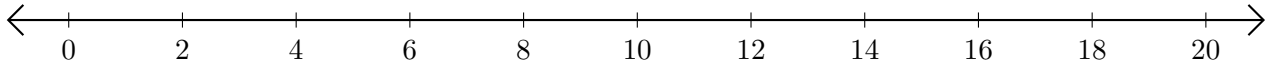
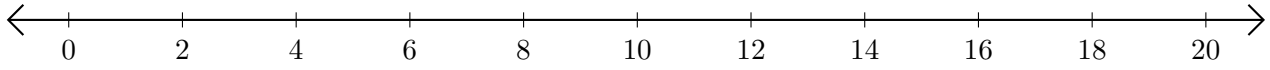
5. $18 + 2 =$ ____