Addition de Nombres sur une Droite Graduée (B)

Utlisez la droite graduée pour calculer chaque somme.

1. $10 + 2 =$ ____

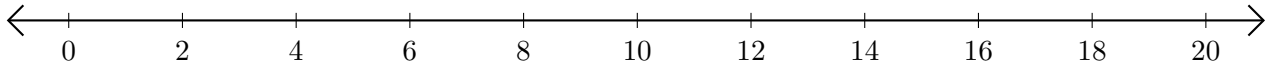

2. $6 + 6 =$ ____

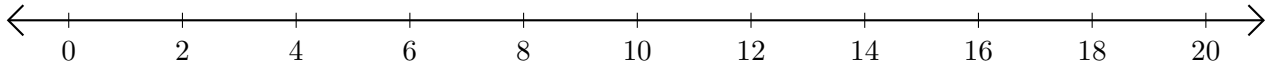

3. $2 + 10 =$ ____

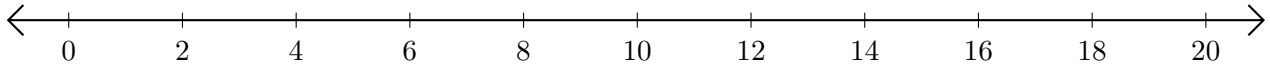

4. $8 + 8 =$ ____

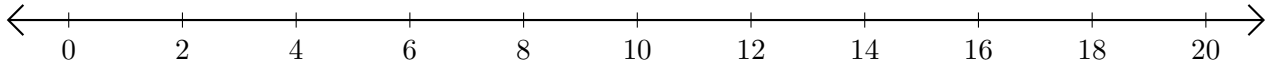

5. $14 + 2 =$ ____

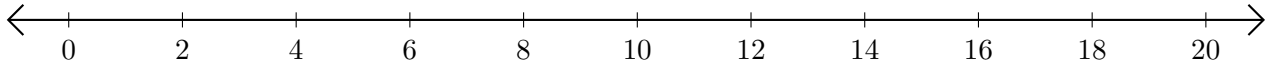

Addition de Nombres sur une Droite Graduée (B) Réponses

Utlisez la droite graduée pour calculer chaque somme.

1. $10 + 2 =$ 12

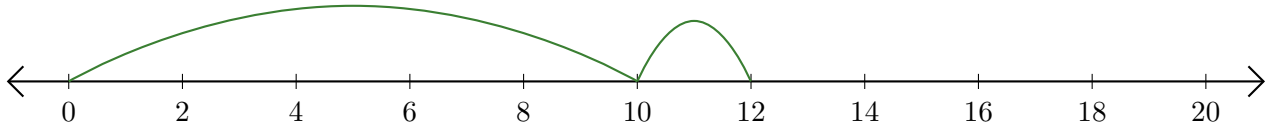

2. $6 + 6 =$ 12

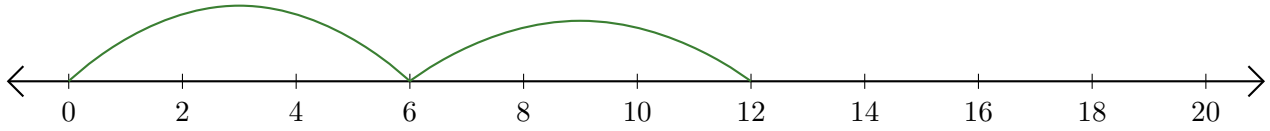

3. $2 + 10 =$ 12

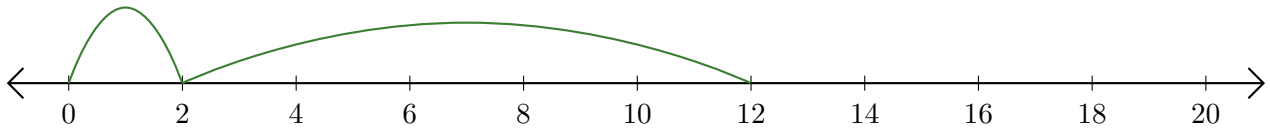

4. $8 + 8 =$ 16

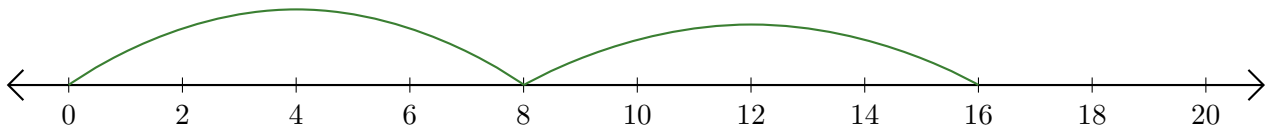
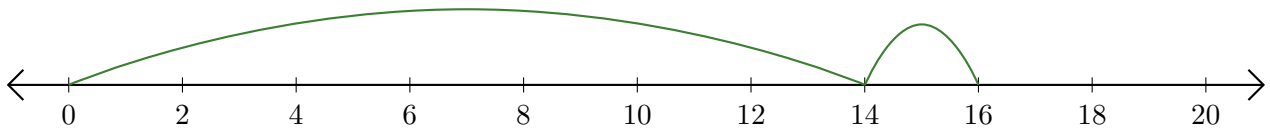
5. $14 + 2 =$ 16