Addition de Nombres sur une Droite Graduée (G)

Utlisez la droite graduée pour calculer chaque somme.

1. $9 + 8 =$ ____

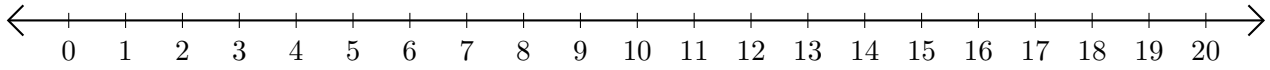

2. $12 + 6 =$ ____

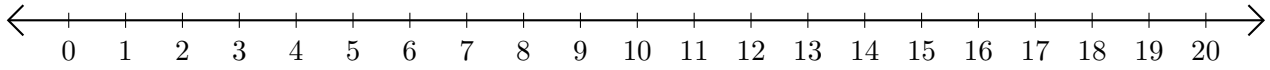

3. $3 + 14 =$ ____

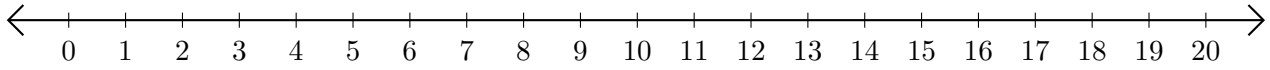

4. $11 + 3 =$ ____

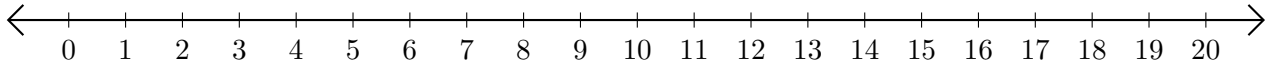

5. $16 + 4 =$ ____

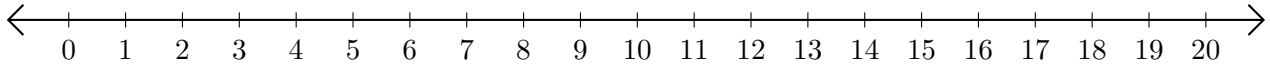

Addition de Nombres sur une Droite Graduée (G) Réponses

Utlisez la droite graduée pour calculer chaque somme.

1. $9 + 8 =$ 17

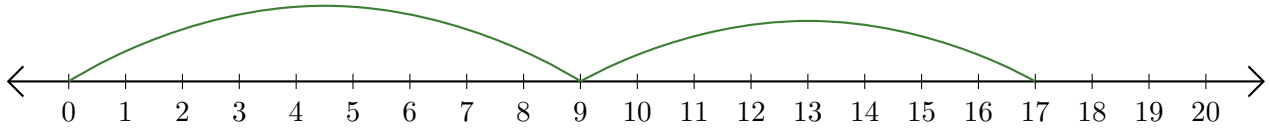

2. $12 + 6 =$ 18

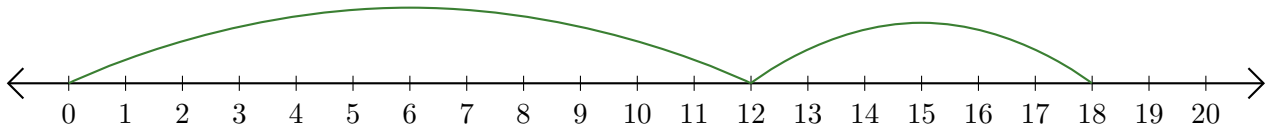

3. $3 + 14 =$ 17

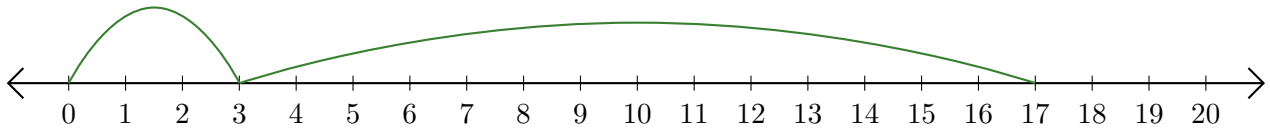

4. $11 + 3 =$ 14

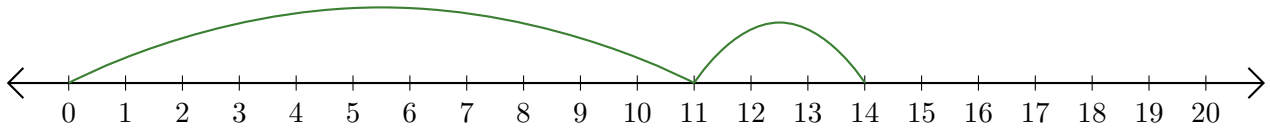
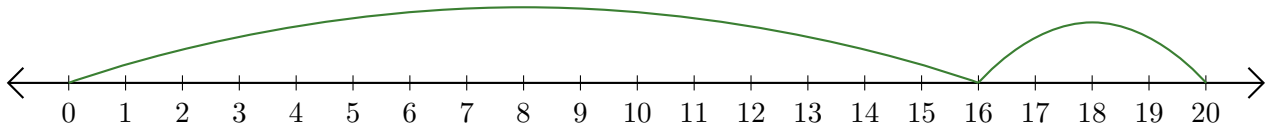
5. $16 + 4 =$ 20