Addition de Nombres sur une Droite Graduée (F)

Utlisez la droite graduée pour calculer chaque somme.

1. $8 + 2 =$ ____

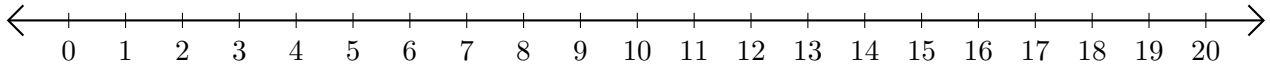

2. $9 + 9 =$ ____

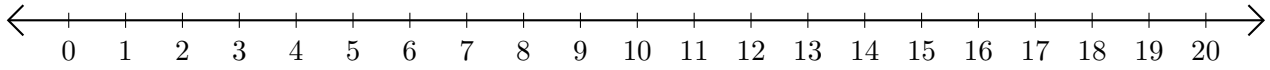

3. $1 + 11 =$ ____

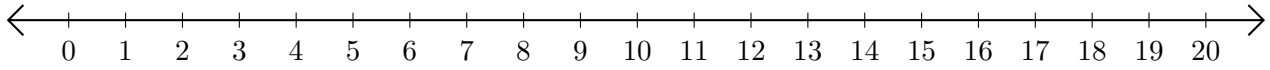

4. $11 + 1 =$ ____

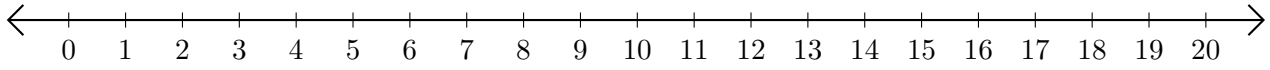
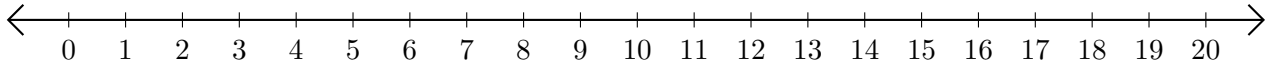
5. $4 + 2 =$ ___