Addition de Nombres sur une Droite Graduée (B)

Utlisez la droite graduée pour calculer chaque somme.

1. $8 + 5 =$ ____

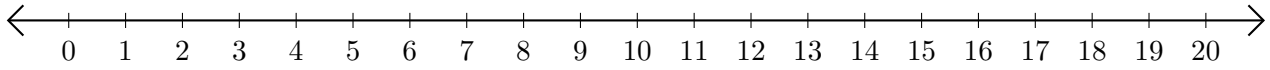

2. $19 + 1 =$ ____

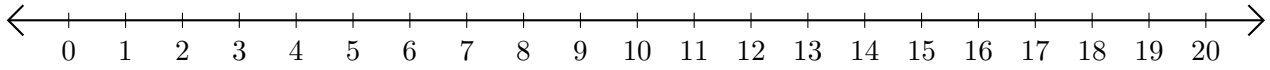

3. $9 + 5 =$ ____

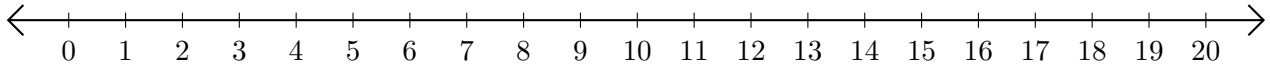

4. $7 + 5 =$ ____

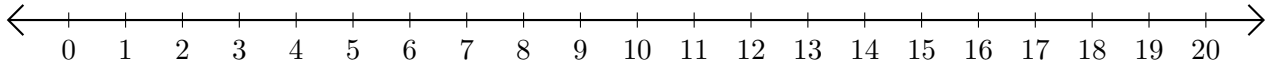
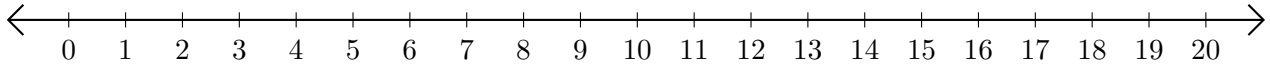
5. $11 + 3 =$ ____