Addition de Nombres sur une Droite Graduée (F)

Utlisez la droite graduée pour calculer chaque somme.

1. $5 + 1 =$ ___

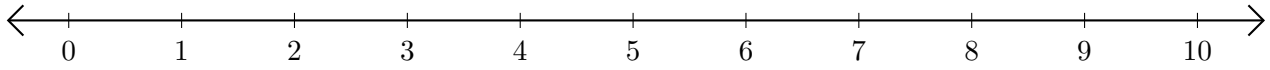

2. $7 + 1 =$ ___

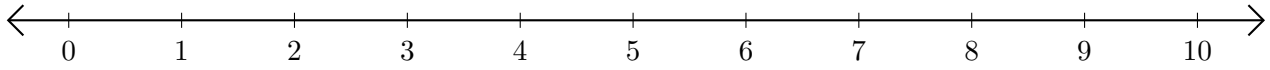

3. $2 + 3 =$ ___

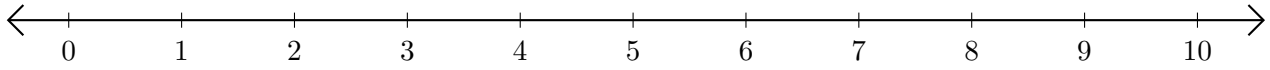

4. $3 + 6 =$ ___

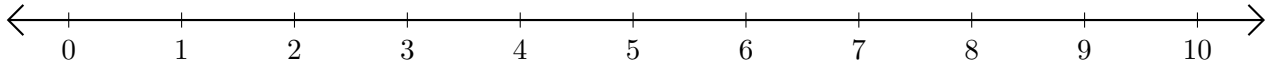

5. $1 + 6 =$ ___

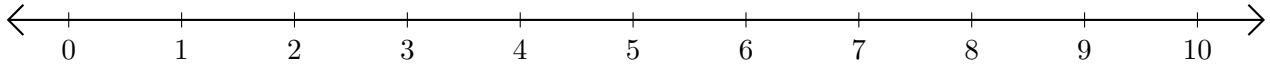

Addition de Nombres sur une Droite Graduée (F) Réponses

Utlisez la droite graduée pour calculer chaque somme.

1. $5 + 1 =$ 6

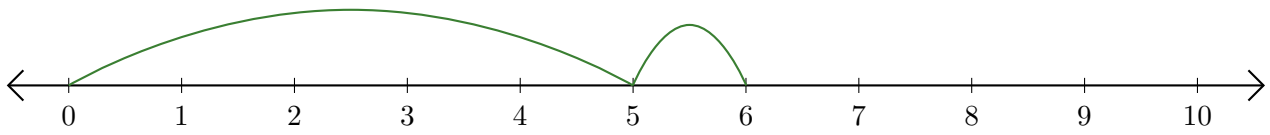

2. $7 + 1 =$ 8

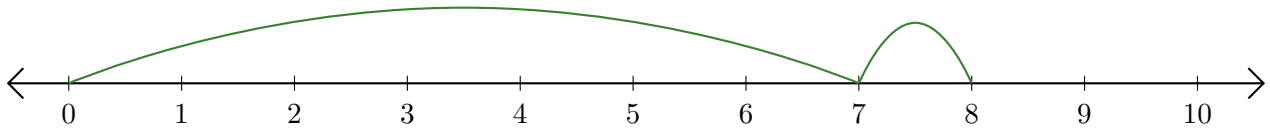

3. $2 + 3 =$ 5

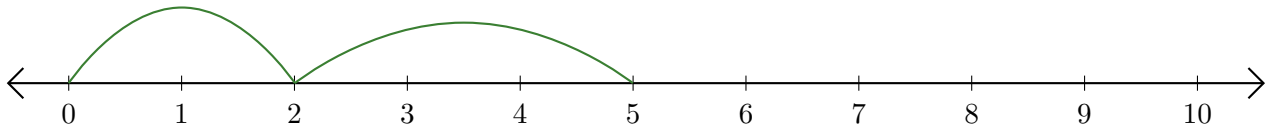

4. $3 + 6 =$ 9

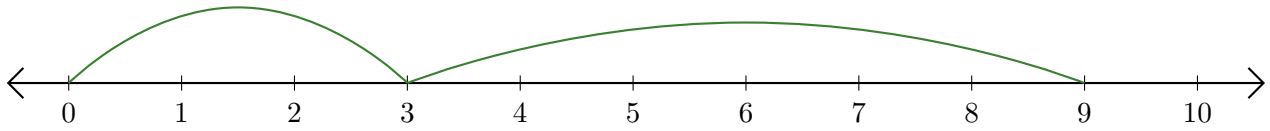
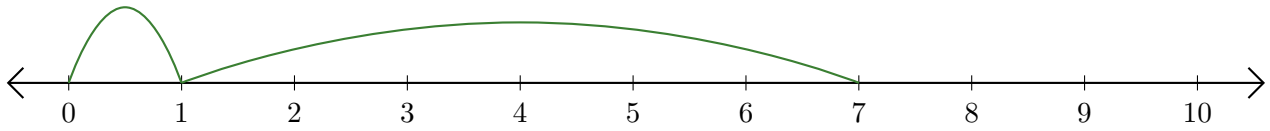
5. $1 + 6 =$ 7