Addition de Nombres sur une Droite Graduée (H)

Utlisez la droite graduée pour calculer chaque somme.

1. $70 + 30 =$ _____

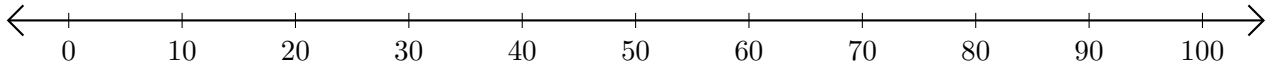

2. $20 + 30 =$ ____

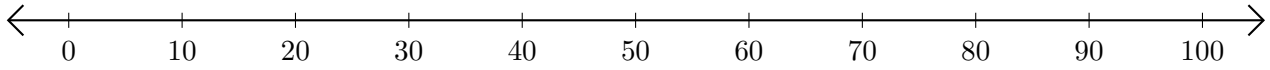

3. $80 + 20 =$ _____

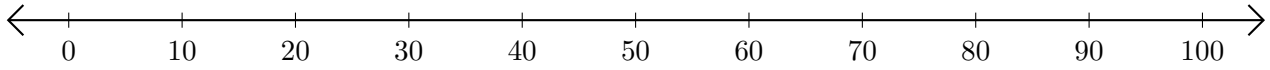

4. $90 + 10 =$ _____

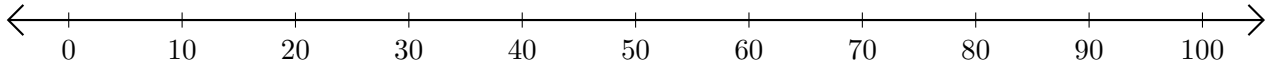
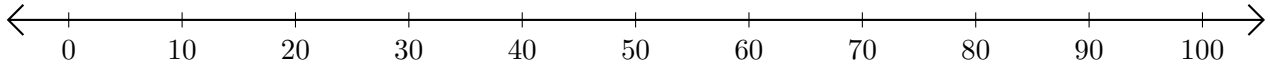
5. $30 + 70 =$ _____