Addition de Nombres sur une Droite Graduée (A)

Utlisez la droite graduée pour calculer chaque somme.

1. $70 + 10 =$ ____

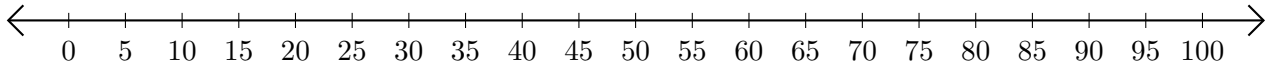

2. $30 + 45 =$ ____

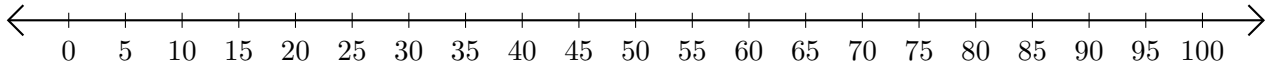

3. $50 + 45 =$ ____

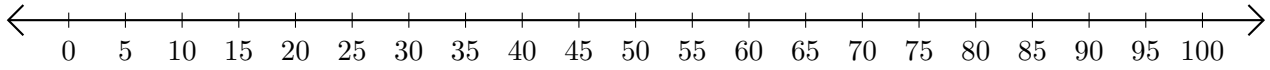

4. $90 + 10 =$ _____

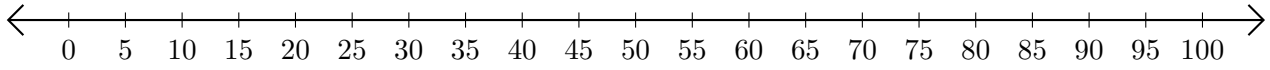
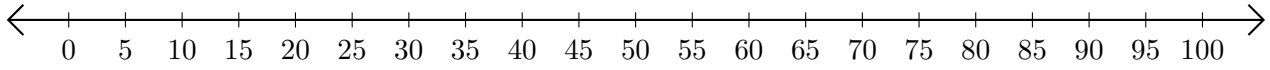
5. $55 + 45 =$ _____