Opérations sur Une Droite Graduée (A)

Utlisez la droite graduée pour calculer chaque somme ou différence.

1. $68 + 4 =$ ____

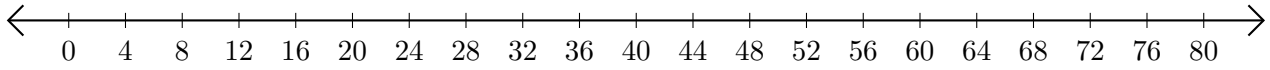

2. $80 - 48 =$ ____

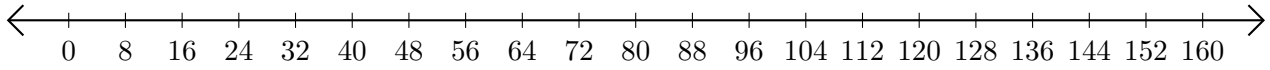

3. $22 + 2 =$ ____

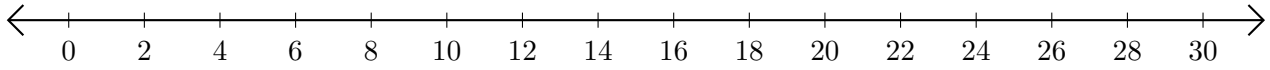

4. $153 - 99 =$ ____

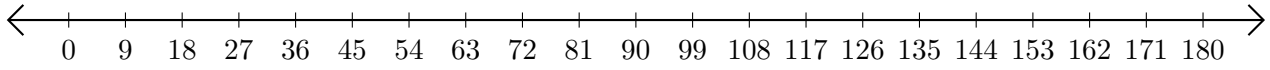

5. $135 - 117 =$ ____

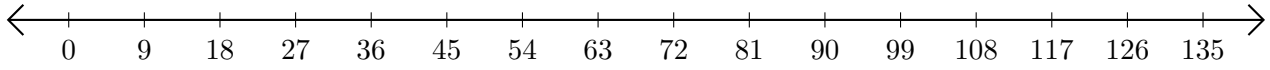

Opérations sur Une Droite Graduée (A) Réponses

Utlisez la droite graduée pour calculer chaque somme ou différence.

1. $68 + 4 =$ 72

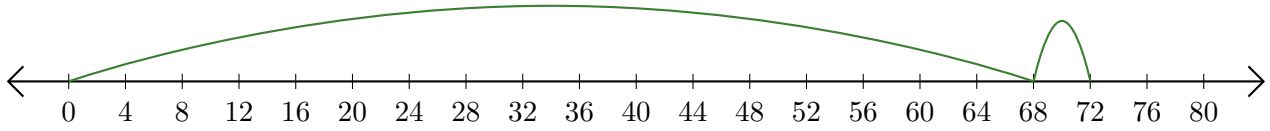

2. $80 - 48 =$ 32

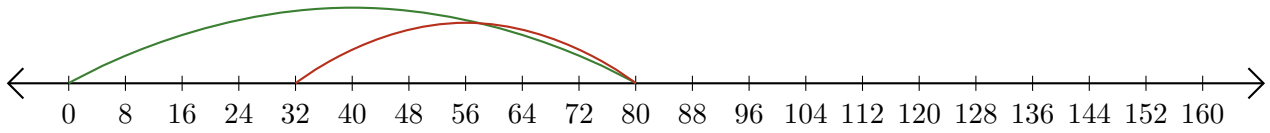

3. $22 + 2 =$ 24

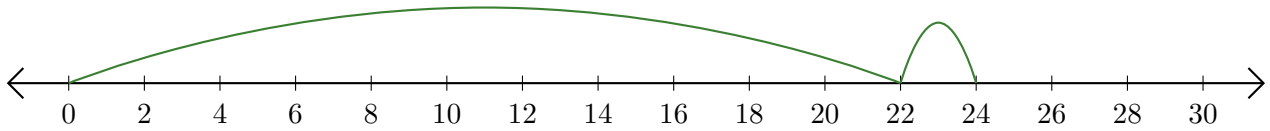

4. $153 - 99 =$ 54

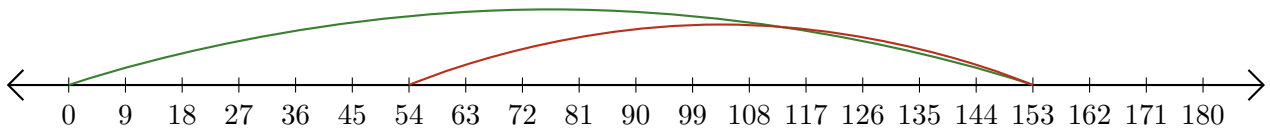

5. $135 - 117 =$ 18

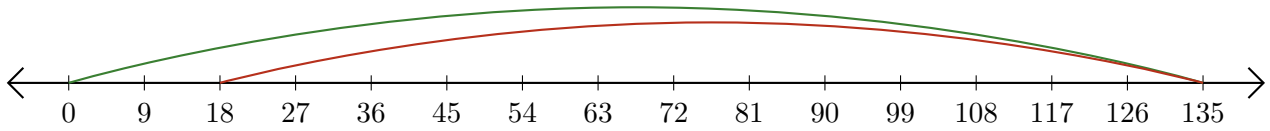

Opérations sur Une Droite Graduée (B)

Utlisez la droite graduée pour calculer chaque somme ou différence.

1. $32 + 20 =$ ____

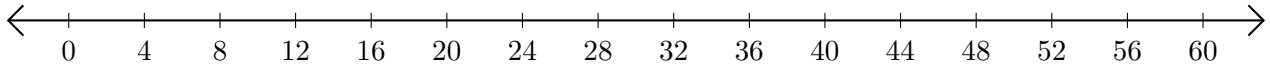

2. $20 - 18 =$ ___

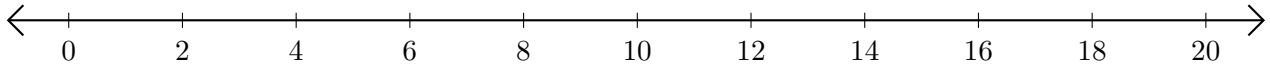

3. $14 + 7 =$ ____

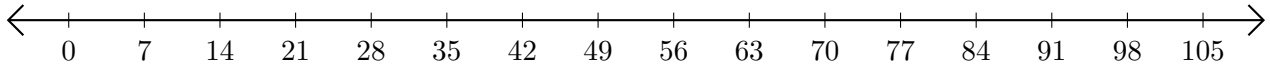

4. $95 - 10 =$ ____

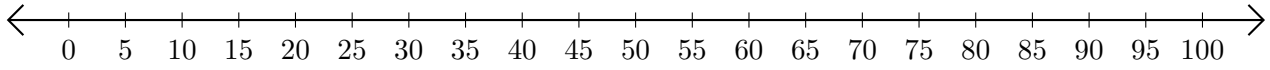

5. $90 - 10 =$ ____

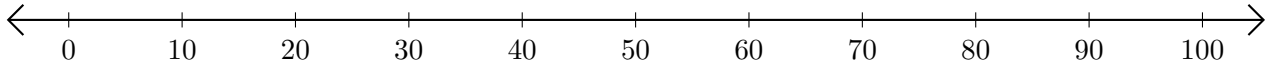

Opérations sur Une Droite Graduée (B) Réponses

Utlisez la droite graduée pour calculer chaque somme ou différence.

1. $32 + 20 =$ 52

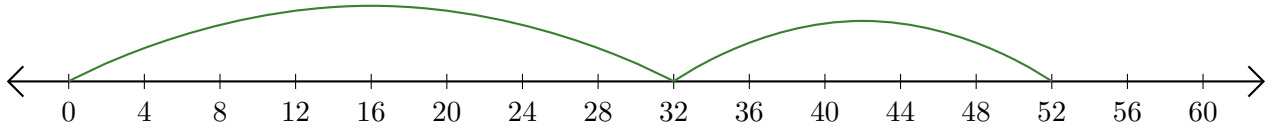

2. $20 - 18 =$ 2

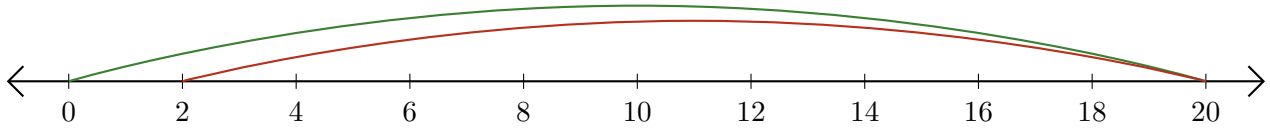

3. $14 + 7 =$ 21



4. $95 - 10 =$ 85

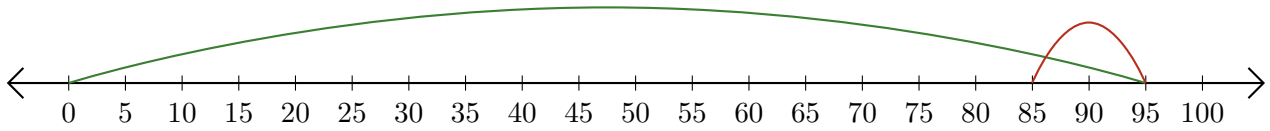

5. $90 - 10 =$ 80

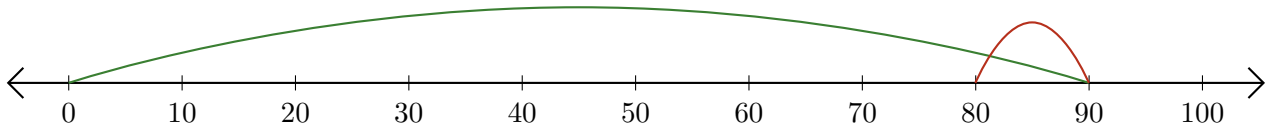

Opérations sur Une Droite Graduée (C)

Utlisez la droite graduée pour calculer chaque somme ou différence.

1. $10 + 8 =$ ____

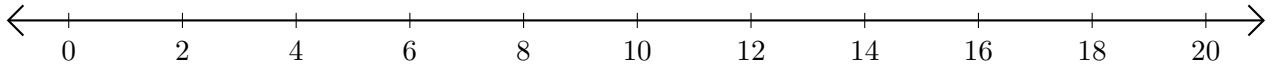

2. $55 - 15 =$ ____

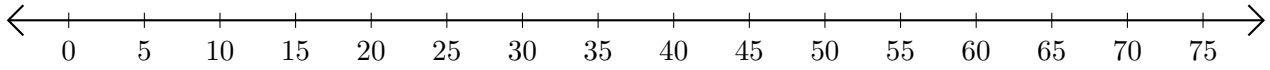

3. $48 + 8 =$ ____

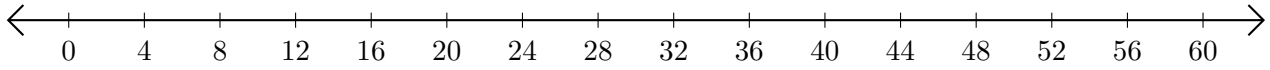

4. $12 - 2 =$ ____

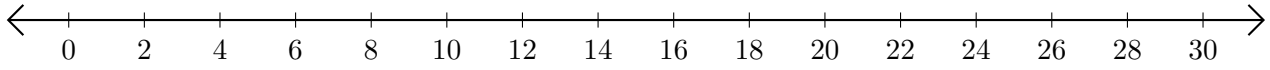

5. $3 - 2 =$ ___

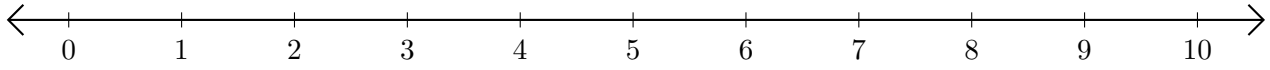

Opérations sur Une Droite Graduée (C) Réponses

Utlisez la droite graduée pour calculer chaque somme ou différence.

1. $10 + 8 =$ 18

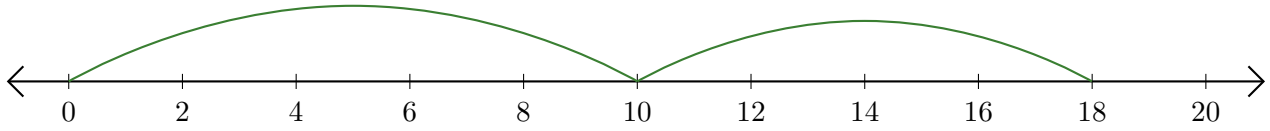

2. $55 - 15 =$ 40

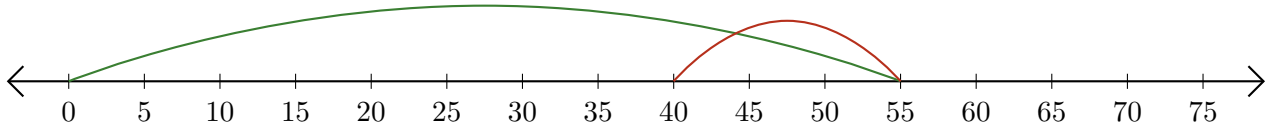

3. $48 + 8 =$ 56

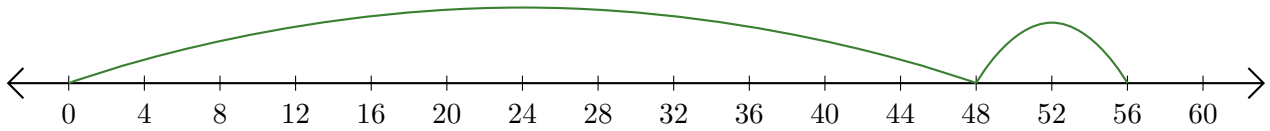

4. $12 - 2 =$ 10

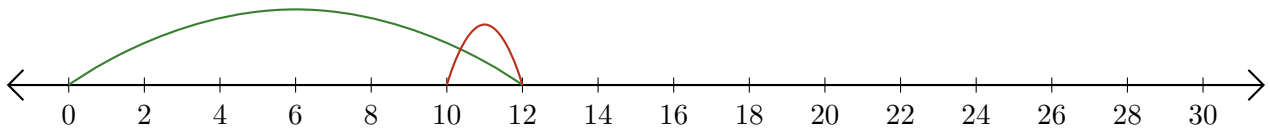

5. $3 - 2 =$ 1

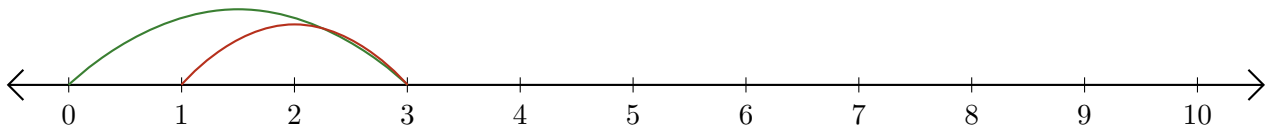

Opérations sur Une Droite Graduée (D)

Utlisez la droite graduée pour calculer chaque somme ou différence.

1. $49 + 21 =$ ____

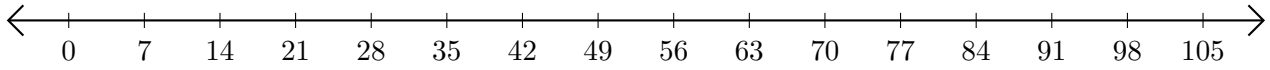

2. $20 - 15 =$ ___

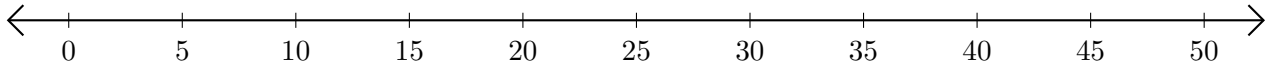

3. $20 + 20 =$ ____

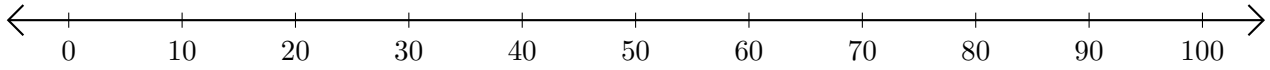

4. $16 - 4 =$ ____

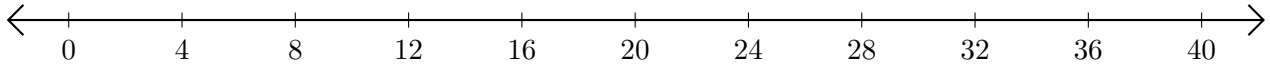

5. $60 - 57 =$ ___

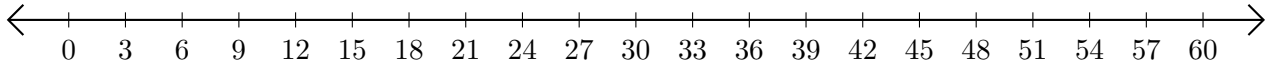

Opérations sur Une Droite Graduée (D) Réponses

Utlisez la droite graduée pour calculer chaque somme ou différence.

1. $49 + 21 =$ 70

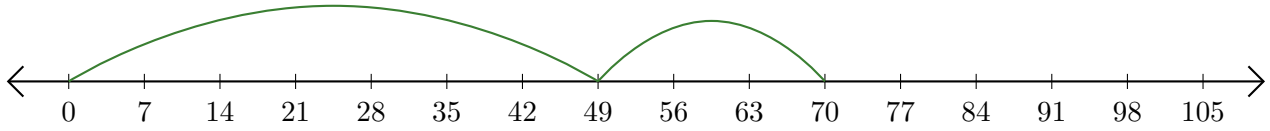

2. $20 - 15 =$ 5

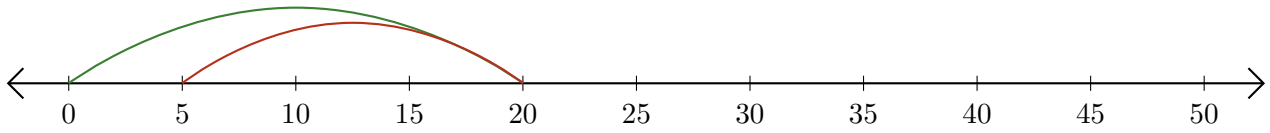

3. $20 + 20 =$ 40

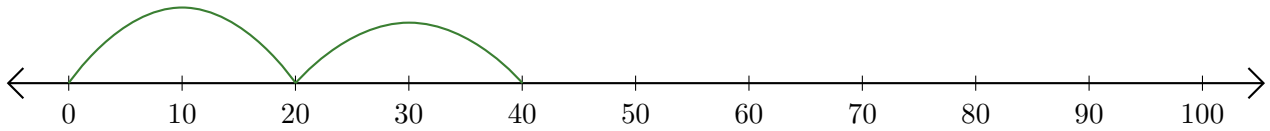

4. $16 - 4 =$ 12

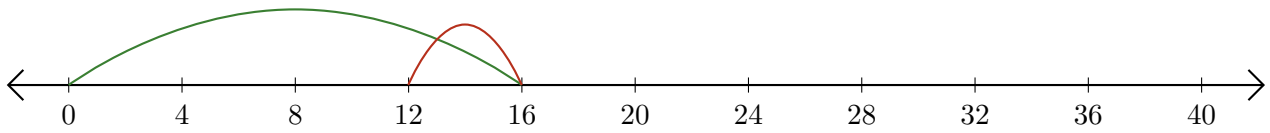

5. $60 - 57 =$ 3

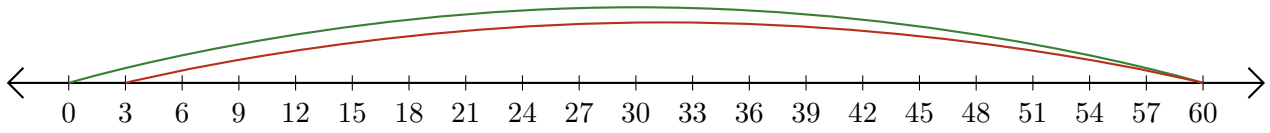

Opérations sur Une Droite Graduée (E)

Utlisez la droite graduée pour calculer chaque somme ou différence.

1. $60 + 5 =$ ____

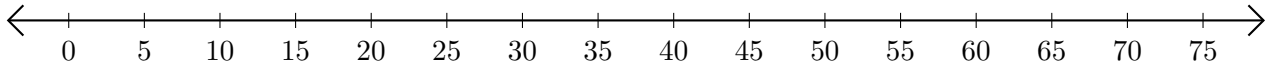

2. $35 - 20 =$ ____

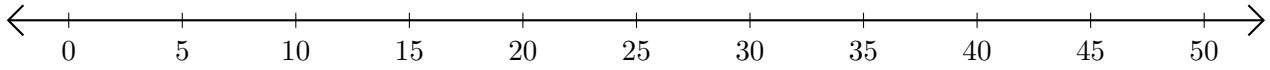

3. $18 + 36 =$ ____

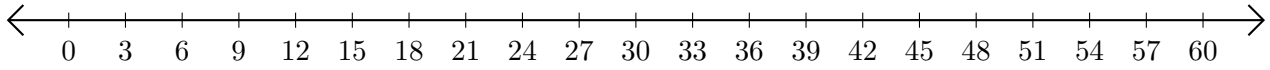

4. $17 - 16 =$ ___

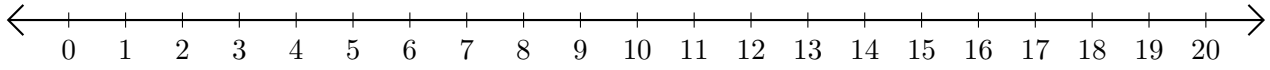

5. $8 - 2 =$ ___

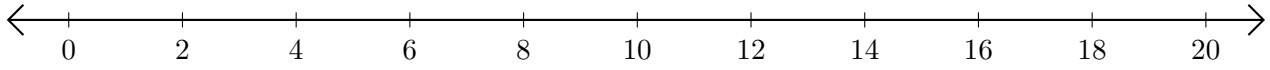

Opérations sur Une Droite Graduée (E) Réponses

Utlisez la droite graduée pour calculer chaque somme ou différence.

1. $60 + 5 =$ 65

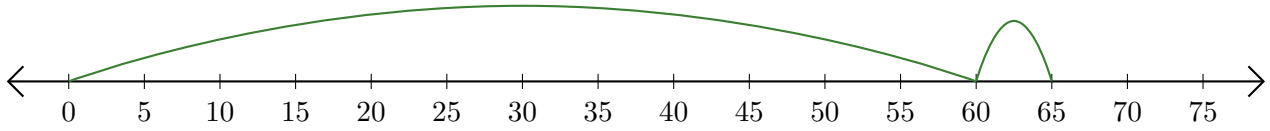

2. $35 - 20 =$ 15

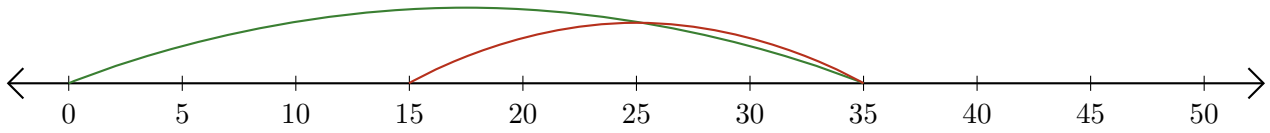

3. $18 + 36 =$ 54

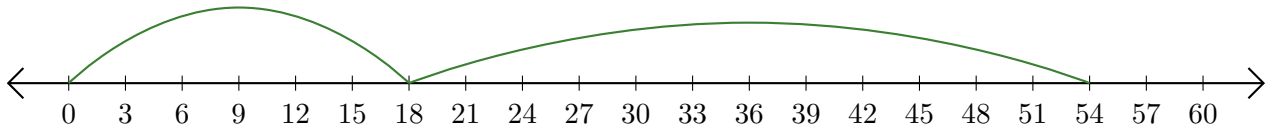

4. $17 - 16 =$ 1

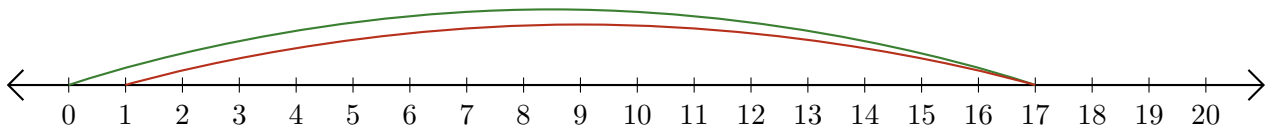

5. $8 - 2 =$ 6

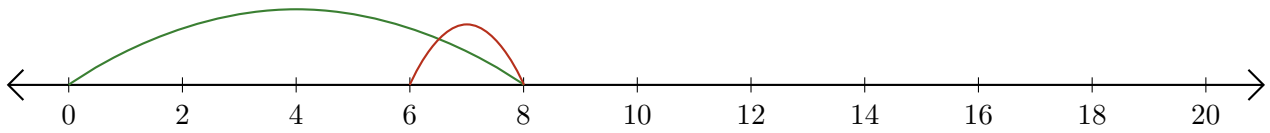

Opérations sur Une Droite Graduée (F)

Utlisez la droite graduée pour calculer chaque somme ou différence.

1. $112 + 8 =$ _____

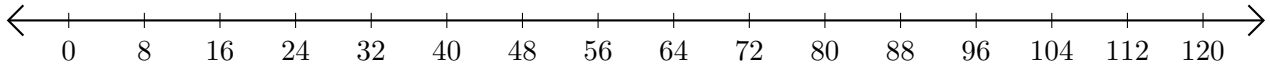

2. $99 - 90 =$ ___

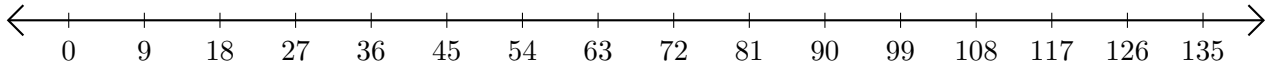

3. $8 + 4 =$ ____

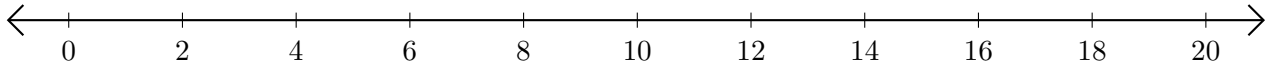

4. $8 - 7 =$ ___

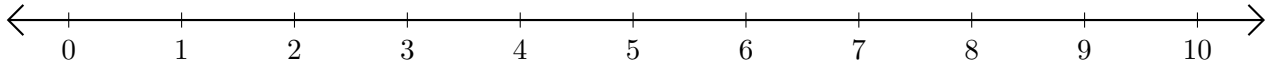

5. $45 + 5 =$ ____

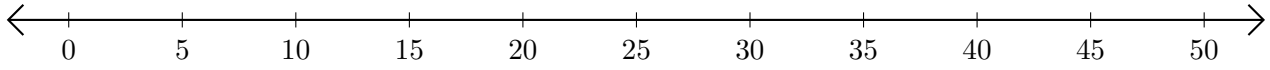

Opérations sur Une Droite Graduée (F) Réponses

Utlisez la droite graduée pour calculer chaque somme ou différence.

1. $112 + 8 =$ 120

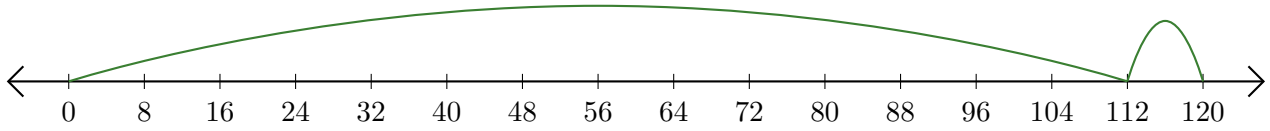

2. $99 - 90 =$ 9

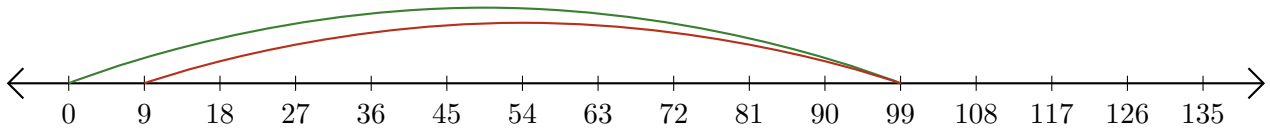

3. $8 + 4 =$ 12

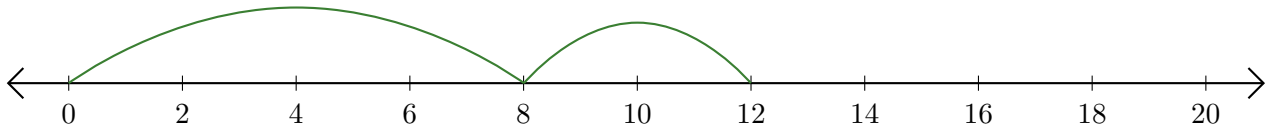

4. $8 - 7 =$ 1

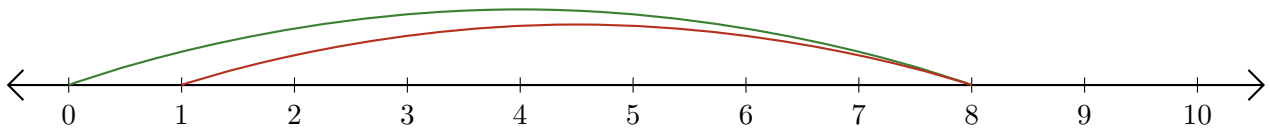

5. $45 + 5 =$ 50

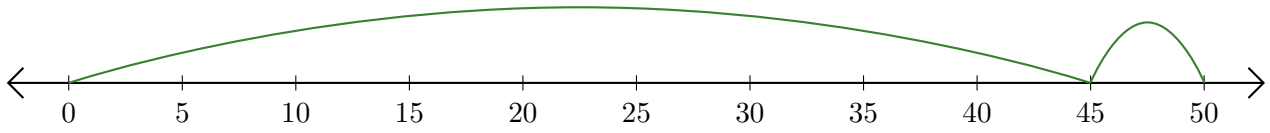

Opérations sur Une Droite Graduée (G)

Utlisez la droite graduée pour calculer chaque somme ou différence.

1. $98 + 7 =$ _____

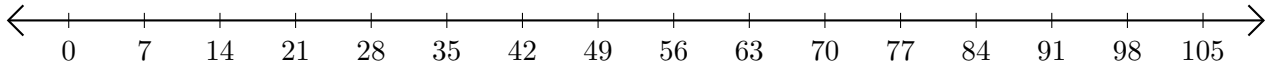

2. $91 - 35 =$ ____

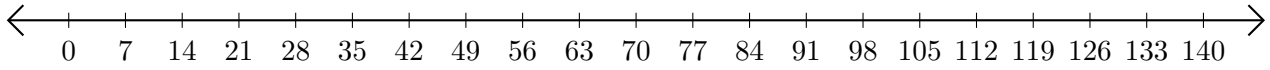

3. $70 + 7 =$ ____

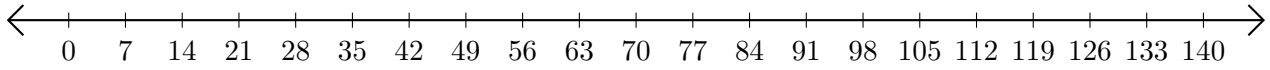

4. $120 - 60 =$ ____

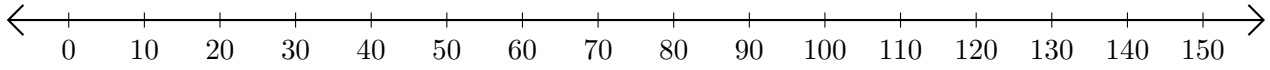

5. $3 + 54 =$ ____

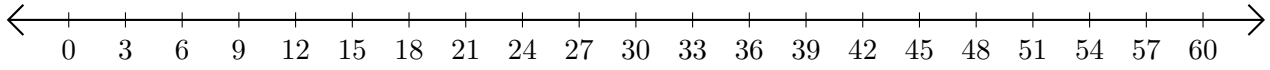

Opérations sur Une Droite Graduée (G) Réponses

Utlisez la droite graduée pour calculer chaque somme ou différence.

1. $98 + 7 =$ 105

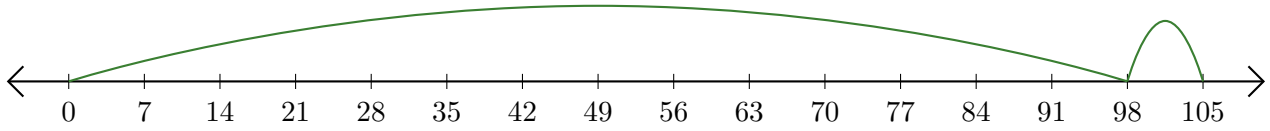

2. $91 - 35 =$ 56

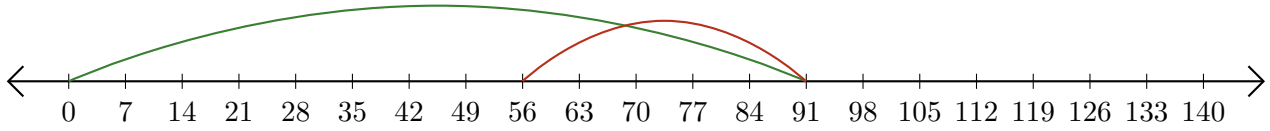

3. $70 + 7 =$ 77

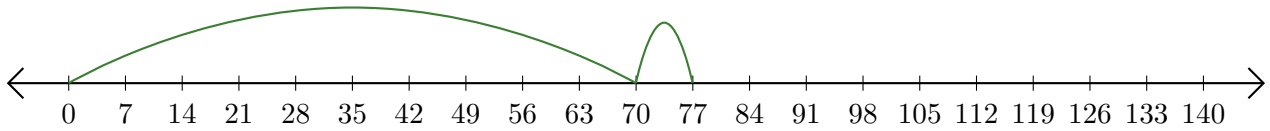

4. $120 - 60 =$ 60

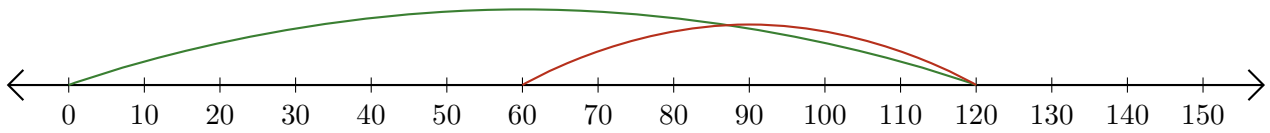

5. $3 + 54 =$ 57

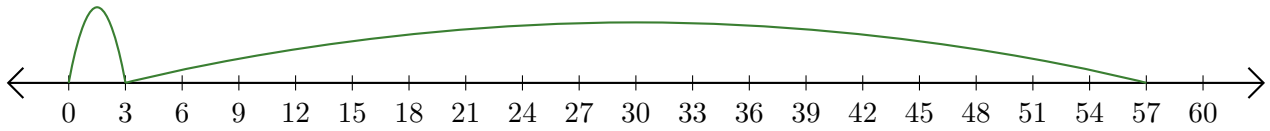

Opérations sur Une Droite Graduée (H)

Utlisez la droite graduée pour calculer chaque somme ou différence.

1. $30 + 30 =$ ____

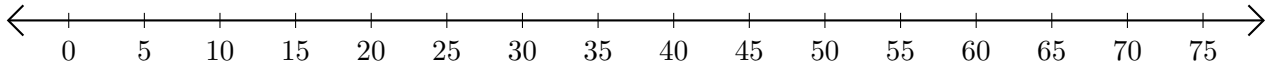

2. $120 - 110 =$ ____

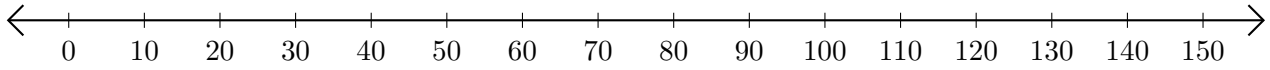

3. $45 + 20 =$ ____

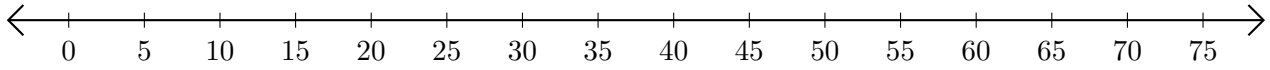

4. $10 - 2 =$ ___

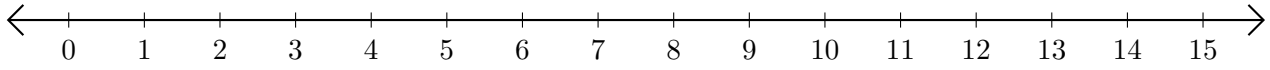

5. $100 + 30 =$ _____

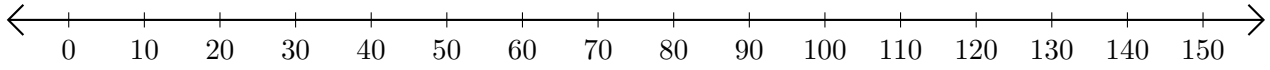

Opérations sur Une Droite Graduée (H) Réponses

Utlisez la droite graduée pour calculer chaque somme ou différence.

1. $30 + 30 =$ 60

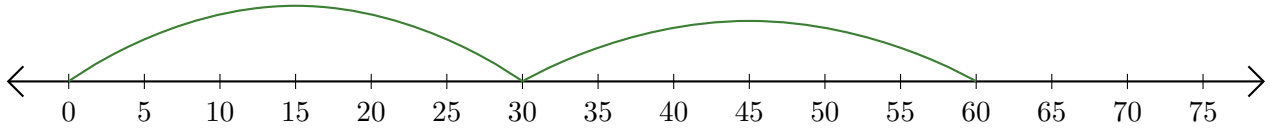

2. $120 - 110 =$ 10

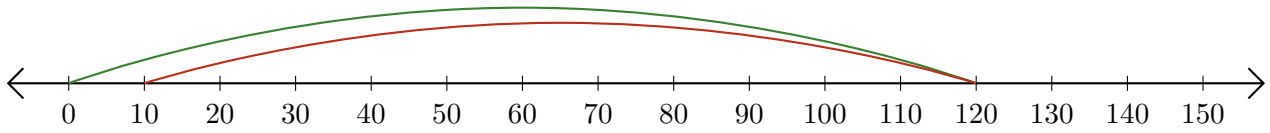

3. $45 + 20 =$ 65

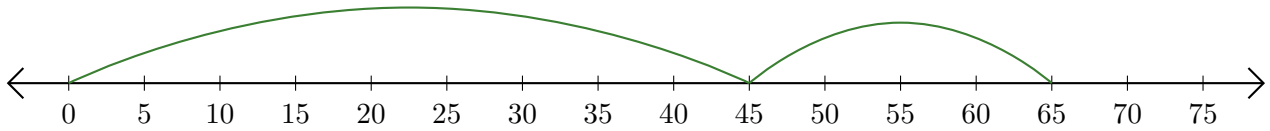

4. $10 - 2 =$ 8

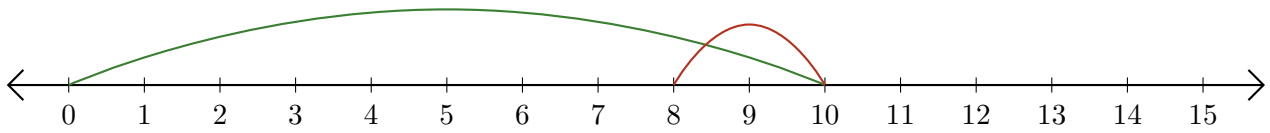

5. $100 + 30 =$ 130

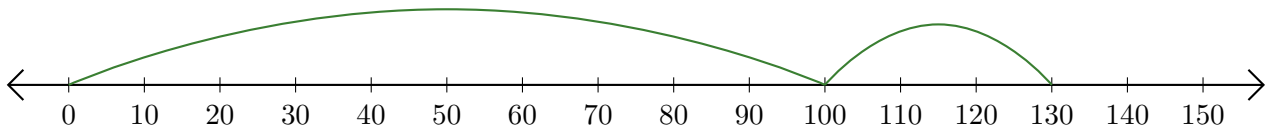

Opérations sur Une Droite Graduée (I)

Utlisez la droite graduée pour calculer chaque somme ou différence.

1. $1 + 4 =$ ___

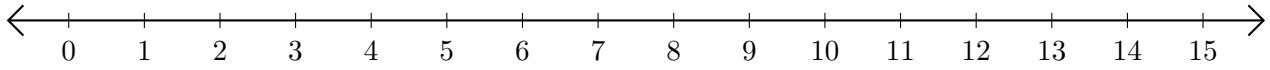

2. $200 - 130 =$ ____

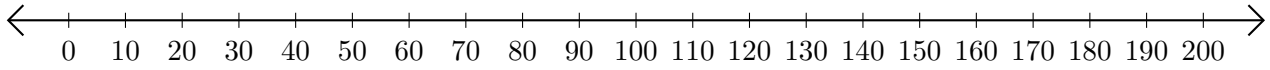

3. $18 + 2 =$ ____

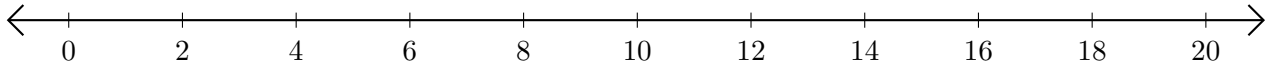

4. $56 - 40 =$ ____

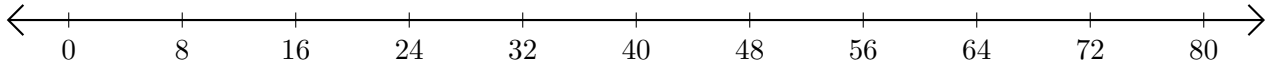

5. $15 - 5 =$ ____

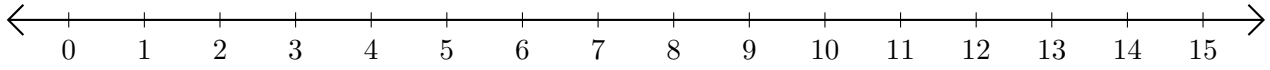

Opérations sur Une Droite Graduée (I) Réponses

Utlisez la droite graduée pour calculer chaque somme ou différence.

1. $1 + 4 =$ 5

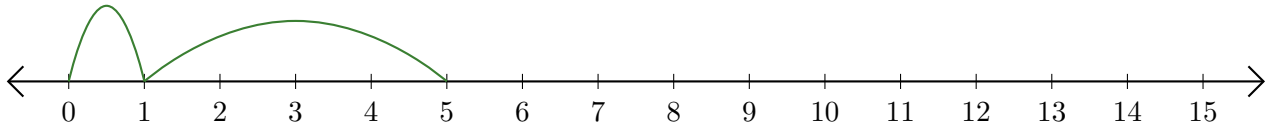

2. $200 - 130 =$ 70

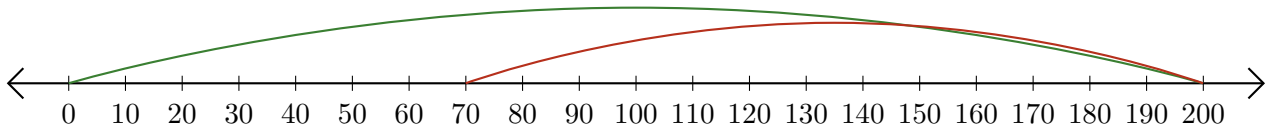

3. $18 + 2 =$ 20

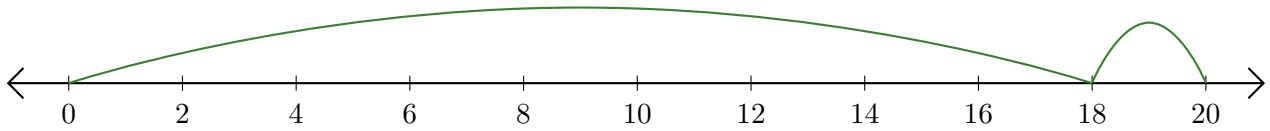

4. $56 - 40 =$ 16

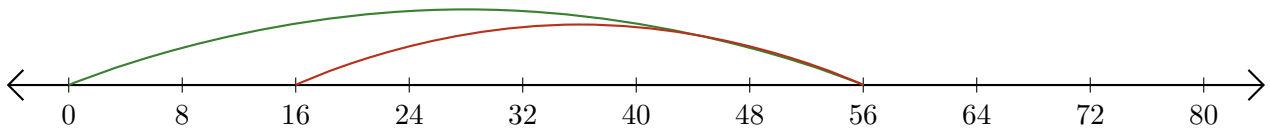

5. $15 - 5 =$ 10

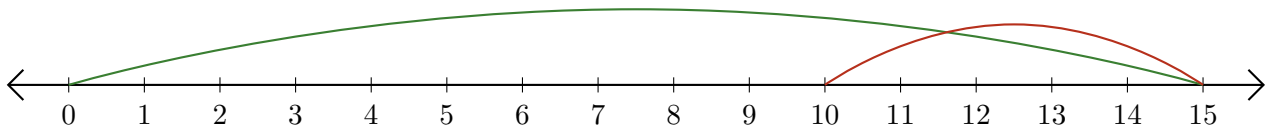

Opérations sur Une Droite Graduée (J)

Utlisez la droite graduée pour calculer chaque somme ou différence.

1. $14 + 21 =$ ____

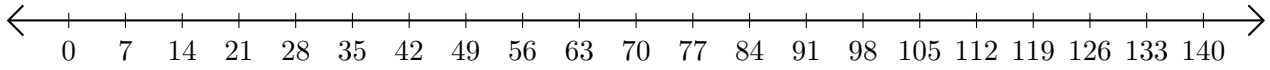

2. $76 - 52 =$ ____

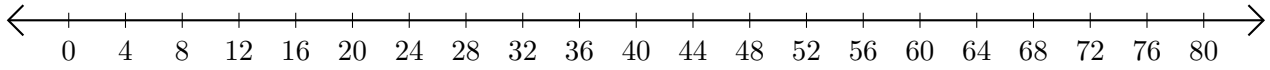

3. $32 + 4 =$ ____

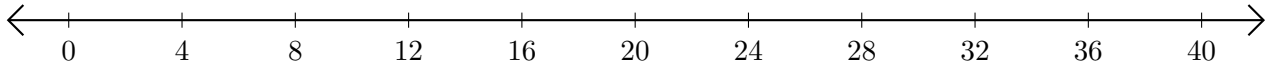

4. $100 - 90 =$ ____

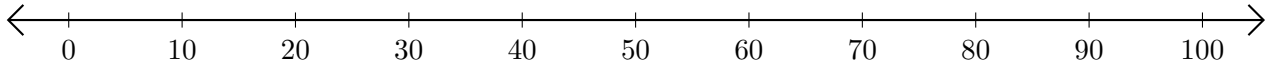

5. $49 + 21 =$ ____

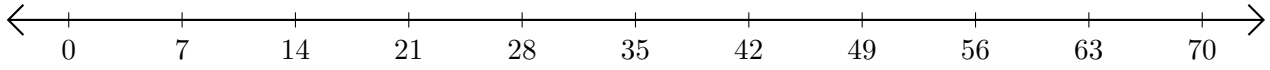

Opérations sur Une Droite Graduée (J) Réponses

Utlisez la droite graduée pour calculer chaque somme ou différence.

1. $14 + 21 =$ 35



2. $76 - 52 =$ 24

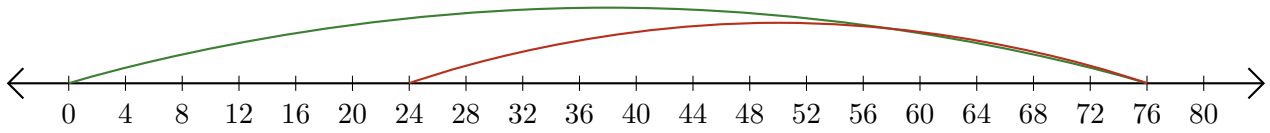

3. $32 + 4 =$ 36

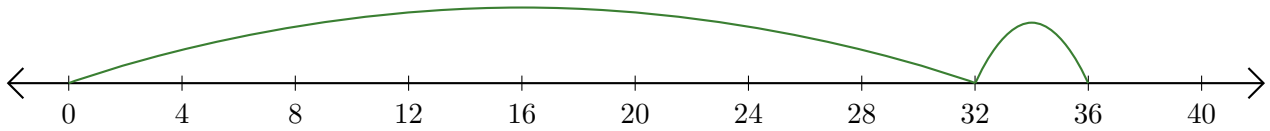

4. $100 - 90 =$ 10

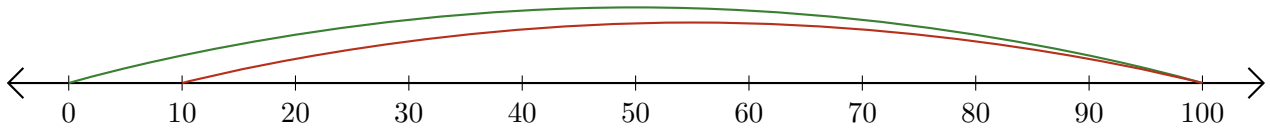
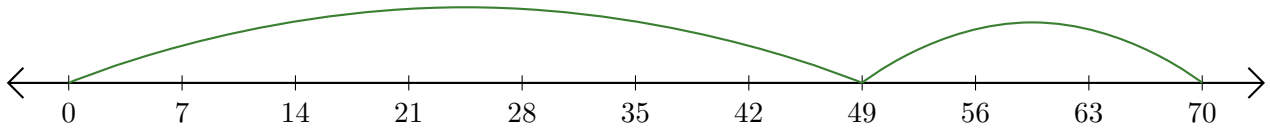
5. $49 + 21 =$ 70