Opérations sur Une Droite Graduée (I)

Utlisez la droite graduée pour calculer chaque somme ou différence.

1. $45 + 5 =$ ____

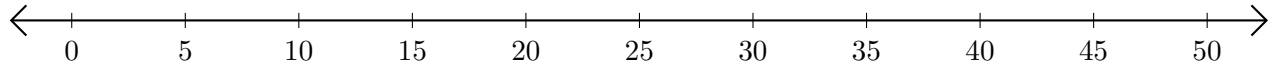

2. $50 - 30 =$ ____

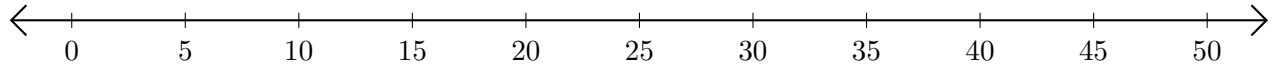

3. $5 + 5 =$ ____

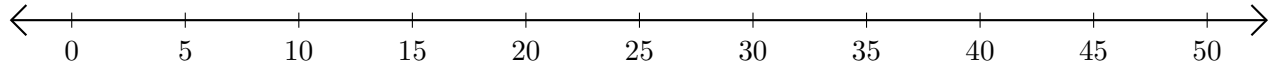

4. $30 - 20 =$ ____

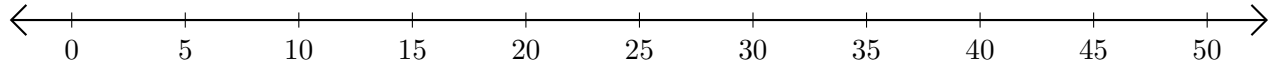

5. $50 - 35 =$ ____

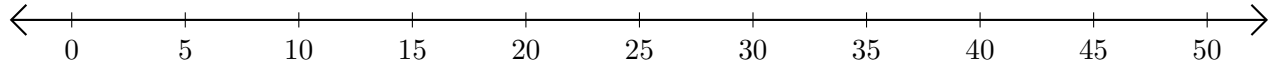

Opérations sur Une Droite Graduée (I) Réponses

Utlisez la droite graduée pour calculer chaque somme ou différence.

1. $45 + 5 =$ 50

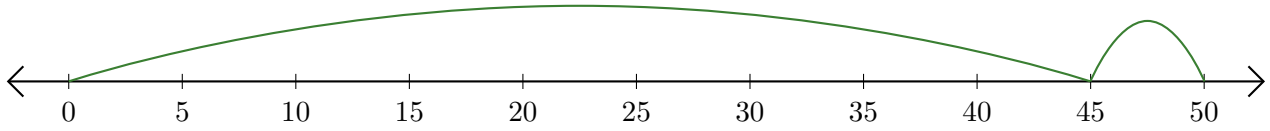

2. $50 - 30 =$ 20

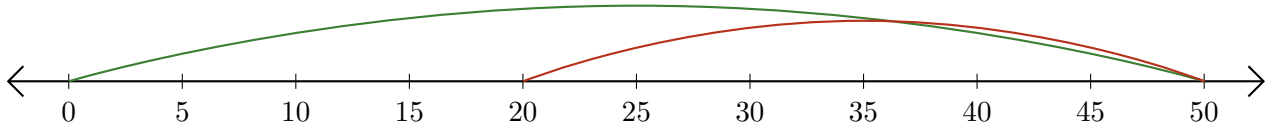

3. $5 + 5 =$ 10

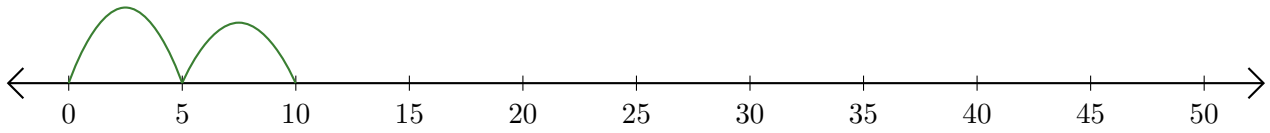

4. $30 - 20 =$ 10

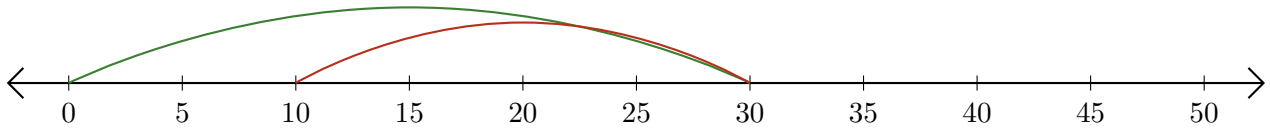
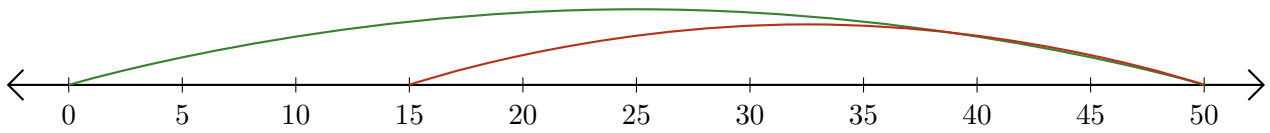
5. $50 - 35 =$ 15