Opérations sur Une Droite Graduée (G)

Utlisez la droite graduée pour calculer chaque somme ou différence.

1. $30 + 5 =$ ____

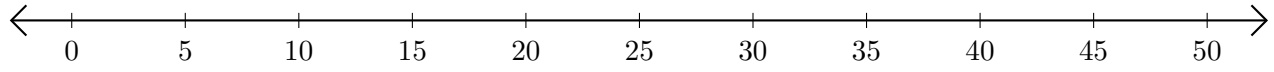

2. $40 - 20 =$ ____

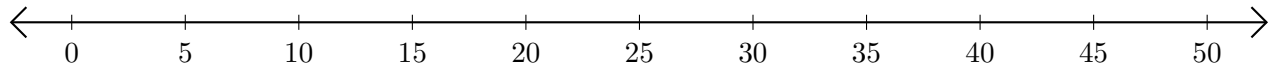

3. $35 + 15 =$ ____

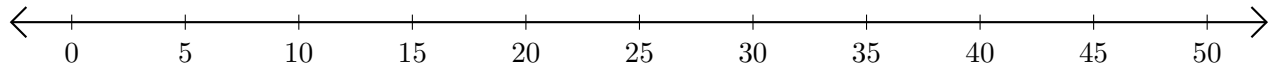

4. $45 - 5 =$ ____

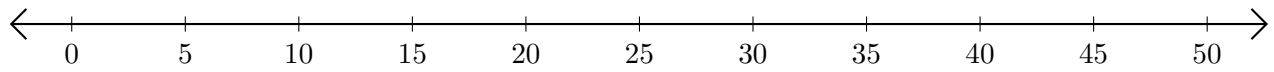

5. $45 - 40 =$ ___

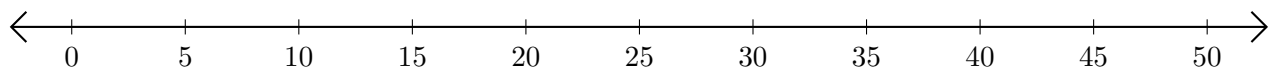

Opérations sur Une Droite Graduée (G) Réponses

Utlisez la droite graduée pour calculer chaque somme ou différence.

1. $30 + 5 =$ 35

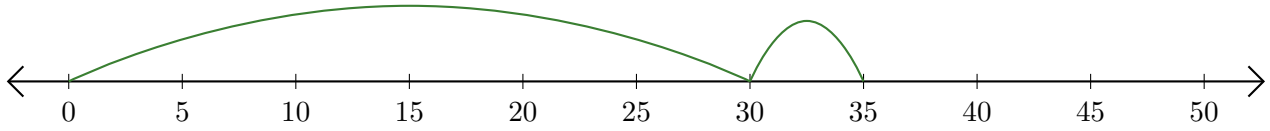

2. $40 - 20 =$ 20

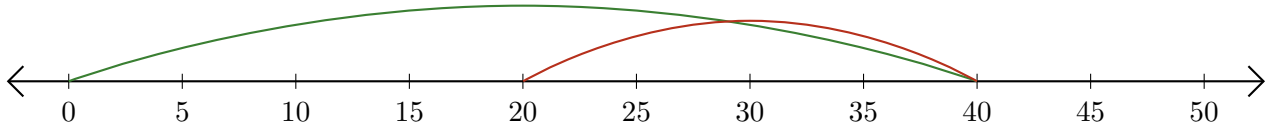

3. $35 + 15 =$ 50

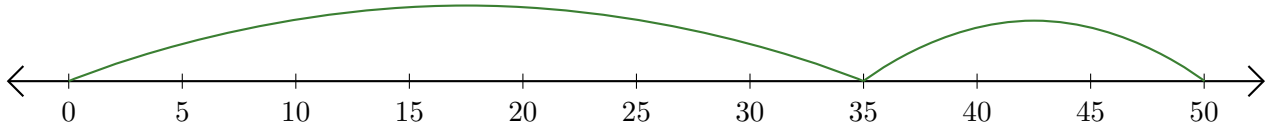

4. $45 - 5 =$ 40

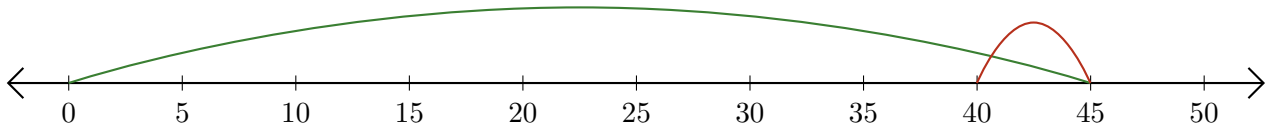
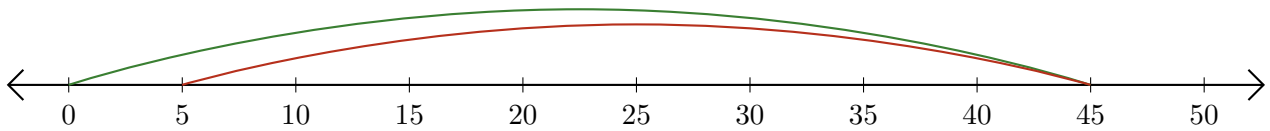
5. $45 - 40 =$ 5