Opérations sur Une Droite Graduée (B)

Utlisez la droite graduée pour calculer chaque somme ou différence.

1. $22 + 6 =$ ____

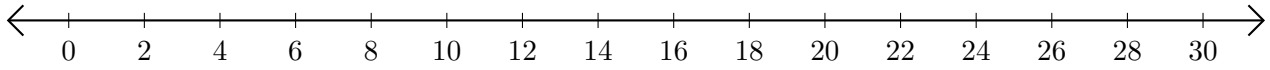

2. $30 - 28 =$ ___

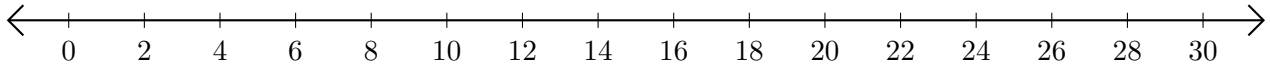

3. $8 + 20 =$ ____

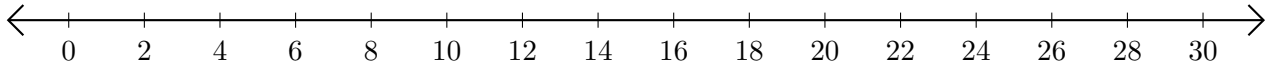

4. $20 - 10 =$ ____

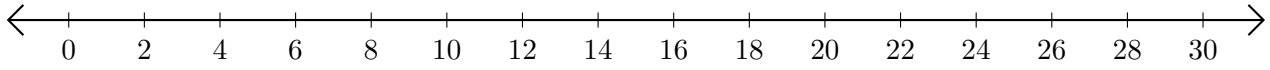
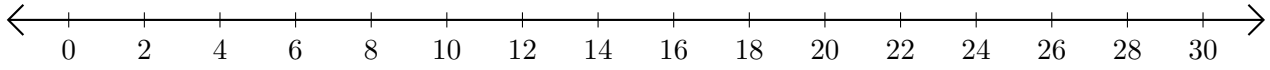
5. $16 + 12 =$ ____